Adding Mixed Numbers (Like Denominators) · 1

$18\frac{1}{10} + 18\frac{9}{10} = ___$

Adding Mixed Numbers (Like Denominators) · 2

$25\frac{4}{5} + 23\frac{1}{5} = ___$

Adding Mixed Numbers (Like Denominators) · 3

$14\frac{2}{5} + 24\frac{4}{5} = ___$

Adding Mixed Numbers (Like Denominators) · 4

The parts make one long bar. How long is the whole bar?

$17\frac{2}{3} + 12\frac{2}{3} = ___$

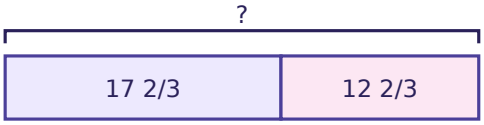

Adding Mixed Numbers (Like Denominators) · 5

Add the whole numbers: 20 + 20 = 40. Add the fractions: $\frac{5}{8} + \frac{5}{8} = \frac{10}{8} = 1\frac{2}{8}$. So $20\frac{5}{8} + 20\frac{5}{8} = ___$

Adding Mixed Numbers (Like Denominators) · 6

$21\frac{5}{12} + ___ = 39\frac{1}{3}$

Adding Mixed Numbers (Like Denominators) · 7

Sam used $22\frac{1}{5}$ meters of ribbon, then $13\frac{4}{5}$ meters of ribbon. How many meters of ribbon did Sam use in all?

Adding Mixed Numbers (Like Denominators) · 8

$14\frac{4}{5} + 20\frac{4}{5} = 35\frac{3}{5}$. Check it by subtracting: $35\frac{3}{5} - 20\frac{4}{5} = ___$

Adding Mixed Numbers (Like Denominators) · 2

ANSWER

49

Adding Mixed Numbers (Like Denominators) · 1

ANSWER

37

Adding Mixed Numbers (Like Denominators) · 4

ANSWER

$30\frac{1}{3}$

Adding Mixed Numbers (Like Denominators) · 3

ANSWER

$39\frac{1}{5}$

Adding Mixed Numbers (Like Denominators) · 6

ANSWER

$17\frac{11}{12}$

Adding Mixed Numbers (Like Denominators) · 5

ANSWER

$41\frac{1}{4}$

Adding Mixed Numbers (Like Denominators) · 8

ANSWER

$14\frac{4}{5}$

Adding Mixed Numbers (Like Denominators) · 7

ANSWER

36

Adding Mixed Numbers (Like Denominators) · 9

$7\frac{1}{3} + 9\frac{1}{3} + 3\frac{2}{3} = ___$

Adding Mixed Numbers (Like Denominators) · 10

$7\frac{2}{3} + 1\frac{1}{3} + 7\frac{2}{3} = ___$

Adding Mixed Numbers (Like Denominators) · 11

$3\frac{1}{5} + 7\frac{2}{5} + 1\frac{2}{5} = ___$

Adding Mixed Numbers (Like Denominators) · 12

The parts make one long bar. How long is the whole bar?

$4\frac{2}{5} + 6\frac{2}{5} + 7\frac{2}{5} = __$

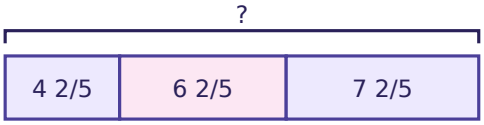

Adding Mixed Numbers (Like Denominators) · 13

Add the whole numbers: 9 + 2 + 6 = 17.

Add the fractions: $\frac{7}{12} + \frac{7}{12} + \frac{7}{12} = \frac{21}{12} = 1\frac{9}{12}$. So $9\frac{7}{12} + 2\frac{7}{12} + 6\frac{7}{12} = ___$

Adding Mixed Numbers (Like Denominators) · 14

$6\frac{1}{3} + 7\frac{1}{3} + ___ = 20$

Adding Mixed Numbers (Like Denominators) · 15

Lily used $1\frac{3}{5}$ meters of ribbon, then $3\frac{3}{5}$ meters of ribbon, then $3\frac{3}{5}$ meters of ribbon. How many meters of ribbon did Lily use in all?

Adding Mixed Numbers (Like Denominators) · 16

$___ + 8\frac{2}{3} + 7\frac{2}{3} = 20$

Adding Mixed Numbers (Like Denominators) · 10

ANSWER

$16\frac{2}{3}$

Adding Mixed Numbers (Like Denominators) · 9

ANSWER

$20\frac{1}{3}$

Adding Mixed Numbers (Like Denominators) · 12

ANSWER

$18\frac{1}{5}$

Adding Mixed Numbers (Like Denominators) · 11

ANSWER

12

Adding Mixed Numbers (Like Denominators) · 14

ANSWER

$6\frac{1}{3}$

Adding Mixed Numbers (Like Denominators) · 13

ANSWER

$18\frac{3}{4}$

Adding Mixed Numbers (Like Denominators) · 16

ANSWER

$3\frac{2}{3}$

Adding Mixed Numbers (Like Denominators) · 15

ANSWER

$8\frac{4}{5}$

Adding Mixed Numbers (Like Denominators) · 17

$23\frac{2}{3} + 12\frac{1}{3} = ___$

Adding Mixed Numbers (Like Denominators) · 18

$24\frac{3}{5} + 25\frac{4}{5} = ___$

Adding Mixed Numbers (Like Denominators) · 19

$21\frac{9}{10} + 19\frac{3}{10} = ___$

Adding Mixed Numbers (Like Denominators) · 20

The parts make one long bar. How long is the whole bar?

$19\frac{3}{5} + 19\frac{4}{5} = ___$

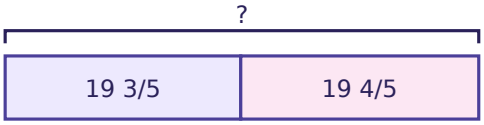

Adding Mixed Numbers (Like Denominators) · 21

Add the whole numbers: 12 + 17 = 29. Add the fractions: $\frac{3}{4} + \frac{1}{4} = \frac{4}{4} = 1$. So $12\frac{3}{4} + 17\frac{1}{4} = ___$

Adding Mixed Numbers (Like Denominators) · 22

$17\frac{5}{6} + ___ = 31$

Adding Mixed Numbers (Like Denominators) · 23

Ben walked $23\frac{1}{3}$ miles, then $19\frac{2}{3}$ miles. How many miles did Ben walk in all?

Adding Mixed Numbers (Like Denominators) · 24

$24\frac{1}{3} + 23\frac{2}{3} = 48$. Check it by subtracting: $48 - 23\frac{2}{3} = ___$

Adding Mixed Numbers (Like Denominators) · 18

ANSWER

$50\frac{2}{5}$

Adding Mixed Numbers (Like Denominators) · 17

ANSWER

36

Adding Mixed Numbers (Like Denominators) · 20

ANSWER

$39\frac{2}{5}$

Adding Mixed Numbers (Like Denominators) · 19

ANSWER

$41\frac{1}{5}$

Adding Mixed Numbers (Like Denominators) · 22

ANSWER

$13\frac{1}{6}$

Adding Mixed Numbers (Like Denominators) · 21

ANSWER

30

Adding Mixed Numbers (Like Denominators) · 24

ANSWER

$24\frac{1}{3}$

Adding Mixed Numbers (Like Denominators) · 23

ANSWER

43