Adding Mixed Numbers (Like Denominators) · 1

$8\frac{4}{5} + 7\frac{1}{5} = ___$

Adding Mixed Numbers (Like Denominators) · 2

$3\frac{5}{6} + 3\frac{1}{6} = ___$

Adding Mixed Numbers (Like Denominators) · 3

$3\frac{4}{5} + 1\frac{4}{5} = ___$

Adding Mixed Numbers (Like Denominators) · 4

The parts make one long bar. How long is the whole bar? $4\frac{2}{3} + 4\frac{2}{3} = ___$

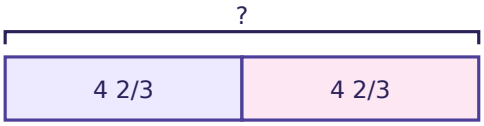

Adding Mixed Numbers (Like Denominators) · 5

Add the whole numbers: 4 + 5 = 9. Add the fractions: $\frac{3}{5} + \frac{4}{5} = \frac{7}{5} = 1\frac{2}{5}$. So $4\frac{3}{5} + 5\frac{4}{5} = ___$

Adding Mixed Numbers (Like Denominators) · 6

$4\frac{1}{4} + ___ = 13$

Adding Mixed Numbers (Like Denominators) · 7

Max walked $2\frac{1}{3}$ miles, then $3\frac{2}{3}$ miles. How many miles did Max walk in all?

Adding Mixed Numbers (Like Denominators) · 8

$1\frac{2}{3} + 6\frac{1}{3} = 8$. Check it by subtracting: $8 - 6\frac{1}{3} = ___$

Adding Mixed Numbers (Like Denominators) · 2

ANSWER

7

Adding Mixed Numbers (Like Denominators) · 1

ANSWER

16

Adding Mixed Numbers (Like Denominators) · 4

ANSWER

$$9\frac{1}{3}$$

Adding Mixed Numbers (Like Denominators) · 3

ANSWER

$$5\frac{3}{5}$$

Adding Mixed Numbers (Like Denominators) · 6

ANSWER

$$8\frac{3}{4}$$

Adding Mixed Numbers (Like Denominators) · 5

ANSWER

$$10\frac{2}{5}$$

Adding Mixed Numbers (Like Denominators) · 8

ANSWER

$$1\frac{2}{3}$$

Adding Mixed Numbers (Like Denominators) · 7

ANSWER

6

Adding Mixed Numbers (Like Denominators) · 9

$1\frac{4}{7} + 12\frac{5}{7} = ___$

Adding Mixed Numbers (Like Denominators) · 10

$9\frac{1}{8} + 9\frac{7}{8} = ___$

Adding Mixed Numbers (Like Denominators) · 11

$12\frac{1}{6} + 4\frac{5}{6} = ___$

Adding Mixed Numbers (Like Denominators) · 12

The parts make one long bar. How long is the whole bar? $7\frac{6}{7} + 5\frac{3}{7} = ___$

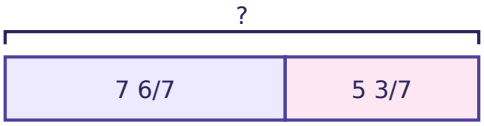

Adding Mixed Numbers (Like Denominators) · 13

Add the whole numbers: 4 + 7 = 11. Add the fractions: $\frac{2}{5} + \frac{4}{5} = \frac{6}{5} = 1\frac{1}{5}$. So $4\frac{2}{5} + 7\frac{4}{5} = ___$

Adding Mixed Numbers (Like Denominators) · 14

$3\frac{5}{7} + ___ = 13\frac{2}{7}$

Adding Mixed Numbers (Like Denominators) · 15

Leo walked $12\frac{2}{7}$ miles, then $8\frac{6}{7}$ miles. How many miles did Leo walk in all?

Adding Mixed Numbers (Like Denominators) · 16

$2\frac{11}{12} + 6\frac{1}{12} = 9$. Check it by subtracting: $9 - 6\frac{1}{12} = ___$

Adding Mixed Numbers (Like Denominators) · 10

ANSWER

19

Adding Mixed Numbers (Like Denominators) · 9

ANSWER

$14\frac{2}{7}$

Adding Mixed Numbers (Like Denominators) · 12

ANSWER

$13\frac{2}{7}$

Adding Mixed Numbers (Like Denominators) · 11

ANSWER

17

Adding Mixed Numbers (Like Denominators) · 14

ANSWER

$9\frac{4}{7}$

Adding Mixed Numbers (Like Denominators) · 13

ANSWER

$12\frac{1}{5}$

Adding Mixed Numbers (Like Denominators) · 16

ANSWER

$2\frac{11}{12}$

Adding Mixed Numbers (Like Denominators) · 15

ANSWER

$21\frac{1}{7}$

$9\frac{3}{8} + 4\frac{7}{8} = ___$

$7\frac{5}{8} + 8\frac{7}{8} = ___$

$11\frac{7}{8} + 12\frac{3}{8} = ___$

The parts make one long bar. How long is the whole bar?

$2\frac{7}{10} + 4\frac{7}{10} = __$

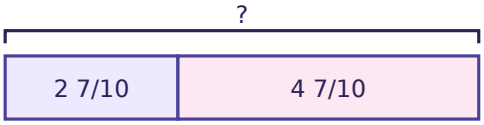

Add the whole numbers: 4 + 7 = 11. Add the fractions: $\frac{5}{6} + \frac{5}{6} = \frac{10}{6} = 1\frac{4}{6}$. So $4\frac{5}{6} + 7\frac{5}{6} = ___$

$10\frac{5}{6} + ___ = 17\frac{2}{3}$

Lily walked $12\frac{3}{4}$ miles, then $9\frac{3}{4}$ miles. How many miles did Lily walk in all?

$8\frac{7}{8} + 11\frac{7}{8} = 20\frac{3}{4}$. Check it by subtracting: $20\frac{3}{4} - 11\frac{7}{8} = ___$

Adding Mixed Numbers (Like Denominators) · 18

ANSWER

$16\frac{1}{2}$

Adding Mixed Numbers (Like Denominators) · 17

ANSWER

$14\frac{1}{4}$

Adding Mixed Numbers (Like Denominators) · 20

ANSWER

$7\frac{2}{5}$

Adding Mixed Numbers (Like Denominators) · 19

ANSWER

$24\frac{1}{4}$

Adding Mixed Numbers (Like Denominators) · 22

ANSWER

$6\frac{5}{6}$

Adding Mixed Numbers (Like Denominators) · 21

ANSWER

$12\frac{2}{3}$

Adding Mixed Numbers (Like Denominators) · 24

ANSWER

$8\frac{7}{8}$

Adding Mixed Numbers (Like Denominators) · 23

ANSWER

$22\frac{1}{2}$