Adding Mixed Numbers (Like Denominators) · 1

$1\frac{2}{5} + 4\frac{2}{5} = ___$

Adding Mixed Numbers (Like Denominators) · 2

$5\frac{1}{5} + 4\frac{2}{5} = ___$

Adding Mixed Numbers (Like Denominators) · 3

$5\frac{1}{3} + 5\frac{1}{3} = ___$

Adding Mixed Numbers (Like Denominators) · 4

The parts make one long bar. How long is the whole bar? $5\frac{3}{5} + 2\frac{1}{5} = ___$

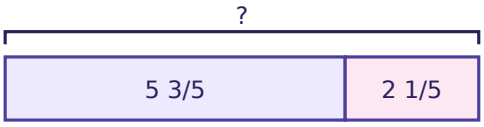

Adding Mixed Numbers (Like Denominators) · 5

Add the whole numbers: 4 + 2 = 6. Add the fractions: $\frac{1}{5} + \frac{1}{5} = \frac{2}{5}$. So $4\frac{1}{5} + 2\frac{1}{5} = ___$

Adding Mixed Numbers (Like Denominators) · 6

$2\frac{1}{3} + ___ = 7\frac{2}{3}$

Adding Mixed Numbers (Like Denominators) · 7

Max walked $5\frac{3}{5}$ miles, then $3\frac{1}{5}$ miles. How many miles did Max walk in all?

Adding Mixed Numbers (Like Denominators) · 8

$2\frac{3}{5} + 5\frac{1}{5} = 7\frac{4}{5}$. Check it by subtracting: $7\frac{4}{5} - 5\frac{1}{5} = ___$

Adding Mixed Numbers (Like Denominators) · 2

ANSWER

$9\frac{3}{5}$

Adding Mixed Numbers (Like Denominators) · 1

ANSWER

$5\frac{4}{5}$

Adding Mixed Numbers (Like Denominators) · 4

ANSWER

$7\frac{4}{5}$

Adding Mixed Numbers (Like Denominators) · 3

ANSWER

$10\frac{2}{3}$

Adding Mixed Numbers (Like Denominators) · 6

ANSWER

$5\frac{1}{3}$

Adding Mixed Numbers (Like Denominators) · 5

ANSWER

$6\frac{2}{5}$

Adding Mixed Numbers (Like Denominators) · 8

ANSWER

$2\frac{3}{5}$

Adding Mixed Numbers (Like Denominators) · 7

ANSWER

$8\frac{4}{5}$

$7\frac{1}{5} + 8\frac{3}{5} = ___$

$4\frac{3}{7} + 6\frac{1}{7} = ___$

$4\frac{2}{9} + 6\frac{2}{9} = ___$

The parts make one long bar. How long is the whole bar? $1\frac{4}{7} + 7\frac{1}{7} = ___$

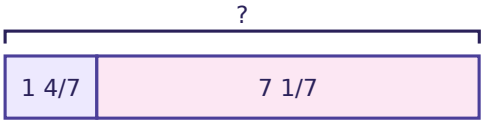

Add the whole numbers: 7 + 6 = 13. Add the fractions: $\frac{2}{7} + \frac{4}{7} = \frac{6}{7}$. So $7\frac{2}{7} + 6\frac{4}{7} =$ ___

$1\frac{3}{7} + ___ = 6\frac{5}{7}$

Zoe used $5\frac{2}{5}$ meters of ribbon, then $9\frac{1}{5}$ meters of ribbon. How many meters of ribbon did Zoe use in all?

$9\frac{1}{7} + 3\frac{4}{7} = 12\frac{5}{7}$. Check it by subtracting: $12\frac{5}{7} - 3\frac{4}{7} = ___$

Adding Mixed Numbers (Like Denominators) · 10

ANSWER

$10\frac{4}{7}$

Adding Mixed Numbers (Like Denominators) · 9

ANSWER

$15\frac{4}{5}$

Adding Mixed Numbers (Like Denominators) · 12

ANSWER

$8\frac{5}{7}$

Adding Mixed Numbers (Like Denominators) · 11

ANSWER

$10\frac{4}{9}$

Adding Mixed Numbers (Like Denominators) · 14

ANSWER

$5\frac{2}{7}$

Adding Mixed Numbers (Like Denominators) · 13

ANSWER

$13\frac{6}{7}$

Adding Mixed Numbers (Like Denominators) · 16

ANSWER

$9\frac{1}{7}$

Adding Mixed Numbers (Like Denominators) · 15

ANSWER

$14\frac{3}{5}$

Adding Mixed Numbers (Like Denominators) · 17

$4\frac{1}{10} + 7\frac{1}{10} = ___$

Adding Mixed Numbers (Like Denominators) · 18

$9\frac{1}{6} + 4\frac{1}{6} = ___$

Adding Mixed Numbers (Like Denominators) · 19

$3\frac{1}{4} + 5\frac{1}{4} = ___$

Adding Mixed Numbers (Like Denominators) · 20

The parts make one long bar. How long is the whole bar? $5\frac{3}{8} + 8\frac{3}{8} = ___$

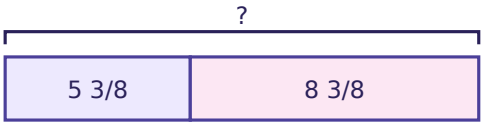

Adding Mixed Numbers (Like Denominators) · 21

Add the whole numbers: 4 + 1 = 5. Add the fractions: $\frac{1}{6} + \frac{1}{6} = \frac{2}{6}$. So $4\frac{1}{6} + 1\frac{1}{6} = ___$

Adding Mixed Numbers (Like Denominators) · 22

$5\frac{5}{12} + ___ = 6\frac{1}{2}$

Adding Mixed Numbers (Like Denominators) · 23

Leo used $8\frac{1}{10}$ meters of ribbon, then $7\frac{7}{10}$ meters of ribbon. How many meters of ribbon did Leo use in all?

Adding Mixed Numbers (Like Denominators) · 24

$6\frac{7}{12} + 6\frac{1}{12} = 12\frac{2}{3}$. Check it by subtracting: $12\frac{2}{3} - 6\frac{1}{12} = ___$

Adding Mixed Numbers (Like Denominators) · 18

ANSWER

$13\frac{1}{3}$

Adding Mixed Numbers (Like Denominators) · 17

ANSWER

$11\frac{1}{5}$

Adding Mixed Numbers (Like Denominators) · 20

ANSWER

$13\frac{3}{4}$

Adding Mixed Numbers (Like Denominators) · 19

ANSWER

$8\frac{1}{2}$

Adding Mixed Numbers (Like Denominators) · 22

ANSWER

$1\frac{1}{12}$

Adding Mixed Numbers (Like Denominators) · 21

ANSWER

$5\frac{1}{3}$

Adding Mixed Numbers (Like Denominators) · 24

ANSWER

$6\frac{7}{12}$

Adding Mixed Numbers (Like Denominators) · 23

ANSWER

$15\frac{4}{5}$