Task card 1 Adding Fractions with Like Denomin...

$$\frac{7}{8} + \frac{2}{8} = ___$$

Task card 2 Adding Fractions with Like Denomin...

$$\frac{2}{3} + \frac{2}{3} = ___$$

Task card 3 Adding Fractions with Like Denomin...

$$\frac{4}{6} + \frac{3}{6} = ___$$

Task card 4 Adding Fractions with Like Denomin...

The bars show the fractions. $\frac{3}{6} + \frac{4}{6} = ___$

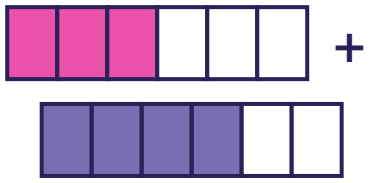

Task card 5 Adding Fractions with Like Denomin...

$\frac{5}{6} + \frac{2}{6} = \frac{7}{6}$. Write $\frac{7}{6}$ as a mixed number: ___

Task card 6 Adding Fractions with Like Denomin...

$$\frac{3}{5} + \frac{___}{5} = \frac{7}{5}$$

Task card 7 Adding Fractions with Like Denomin...

Max walked $\frac{6}{8}$ of a mile, then $\frac{3}{8}$ of a mile. How many miles did Max walk in all?

Task card 8 Adding Fractions with Like Denomin...

Make both sides equal: $\frac{2}{4} + \frac{3}{4} = \frac{3}{4} + \frac{\quad}{4}$

Task card 9 Adding Fractions with Like Denomin...

$$\frac{8}{10} + \frac{6}{10} = ___$$

Task card 10 Adding Fractions with Like Denomin...

$$\frac{10}{12} + \frac{11}{12} = ___$$

Task card 11 Adding Fractions with Like Denomin...

$$\frac{7}{12} + \frac{9}{12} = ___$$

Task card 12 Adding Fractions with Like Denomin...

The bars show the fractions. $\frac{8}{10} + \frac{4}{10} = ___$

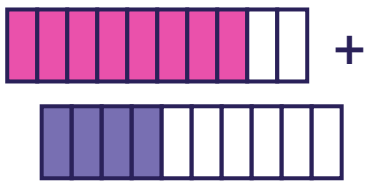

Task card 13 Adding Fractions with Like Denomin...

$\frac{6}{8} + \frac{6}{8} = \frac{12}{8}$. Write $\frac{12}{8}$ as a mixed number in lowest terms:

___

Task card 14 Adding Fractions with Like Denomin...

$$\frac{5}{8} + \frac{__}{8} = \frac{10}{8}$$

Task card 15 Adding Fractions with Like Denomin...

Ben painted $\frac{3}{4}$ of a meter, then $\frac{3}{4}$ of a meter. How many meters did Ben paint in all?

Task card 16 Adding Fractions with Like Denomin...

Make both sides equal: $\frac{4}{6} + \frac{4}{6} = \frac{5}{6} + \frac{__}{6}$

Task card 17 Adding Fractions with Like Denomin...

$$\frac{4}{10} + \frac{7}{10} = ___$$

Task card 18 Adding Fractions with Like Denomin...

$$\frac{3}{8} + \frac{3}{8} = ___$$

Task card 19 Adding Fractions with Like Denomin...

$$\frac{2}{5} + \frac{1}{5} = ___$$

Task card 20 Adding Fractions with Like Denomin...

The bars show the fractions. $\frac{4}{10} + \frac{8}{10} = ___$

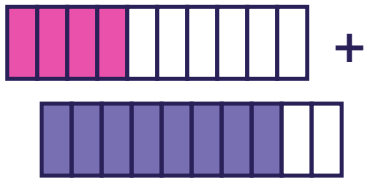

Task card 21 Adding Fractions with Like Denomin...

$\frac{11}{12} + \frac{7}{12} = \frac{18}{12}$. Write $\frac{18}{12}$ as a mixed number in lowest terms:

___

Task card 22 Adding Fractions with Like Denomin...

$$\frac{8}{9} + \frac{__}{9} = \frac{15}{9}$$

Task card 23 Adding Fractions with Like Denomin...

Sam poured $\frac{1}{8}$ of a liter, then $\frac{5}{8}$ of a liter. How many liters did Sam pour in all?

Task card 24 Adding Fractions with Like Denomin...

Make both sides equal: $\frac{4}{10} + \frac{5}{10} = \frac{5}{10} + \frac{__}{10}$

Adding Fractions with Like Denominators Task Cards

Recording sheet · Grade 4 · Answer each question. Write fraction answers in lowest terms; write an answer greater than 1 as a mixed number.

Scan to check your answers

Name: _____ Date: _____

1	2	3	4
5	6	7	8
9	10	11	12
13	14	15	16
17	18	19	20
21	22	23	24

Adding Fractions with Like Denominators Task Cards: Answer Key

Grade 4 · Medium

The answers online

1. $1\frac{1}{8}$	**2.** $1\frac{1}{3}$	**3.** $1\frac{1}{6}$
4. $1\frac{1}{6}$	**5.** $1\frac{1}{6}$	**6.** 4
7. $1\frac{1}{8}$	**8.** 2	**9.** $1\frac{2}{5}$
10. $1\frac{3}{4}$	**11.** $1\frac{1}{3}$	**12.** $1\frac{1}{5}$
13. $1\frac{1}{2}$	**14.** 5	**15.** $1\frac{1}{2}$
16. 3	**17.** $1\frac{1}{10}$	**18.** $\frac{3}{4}$
19. $\frac{3}{5}$	**20.** $1\frac{1}{5}$	**21.** $1\frac{1}{2}$
22. 7	**23.** $\frac{3}{4}$	**24.** 4