Task card 1 Adding Fractions with Like Denomin...

$$\frac{4}{6} + \frac{1}{6} = ___$$

Task card 2 Adding Fractions with Like Denomin...

$$\frac{2}{5} + \frac{2}{5} = ___$$

Task card 3 Adding Fractions with Like Denomin...

$$\frac{2}{6} + \frac{3}{6} = ___$$

Task card 4 Adding Fractions with Like Denomin...

The bars show the fractions. $\frac{2}{4} + \frac{1}{4} = ___$

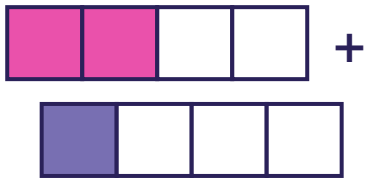

Task card 5 Adding Fractions with Like Denomin...

Add the numerators: 1 + 2 = 3.

The denominator stays 5. $\frac{1}{5} + \frac{2}{5} = ___$

Task card 6 Adding Fractions with Like Denomin...

$$\frac{1}{3} + \frac{___}{3} = \frac{2}{3}$$

Task card 7 Adding Fractions with Like Denomin...

Ben walked $\frac{1}{4}$ of a mile, then $\frac{2}{4}$ of a mile. How many miles did Ben walk in all?

Task card 8 Adding Fractions with Like Denomin...

Make both sides equal: $\frac{1}{5} + \frac{3}{5} = \frac{2}{5} + \frac{\quad}{5}$

Task card 9 Adding Fractions with Like Denomin...

$$\frac{1}{6} + \frac{4}{6} = ___$$

Task card 10 Adding Fractions with Like Denomin...

The bars show the fractions. $\frac{1}{7} + \frac{5}{7} = ___$

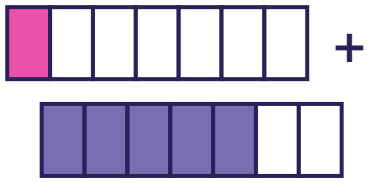

Task card 11 Adding Fractions with Like Denomin...

Add the numerators: 1 + 3 = 4.

The denominator stays 5. $\frac{1}{5} + \frac{3}{5} = ___$

Task card 12 Adding Fractions with Like Denomin...

$$\frac{2}{7} + \frac{\quad}{7} = \frac{6}{7}$$

Task card 13 Adding Fractions with Like Denomin...

Ben painted $\frac{2}{12}$ of a meter, then $\frac{9}{12}$ of a meter. How many meters did Ben paint in all?

Task card 14 Adding Fractions with Like Denomin...

Make both sides equal: $\frac{3}{7} + \frac{3}{7} = \frac{4}{7} + \frac{\quad}{7}$

Task card 15 Adding Fractions with Like Denomin...

$$\frac{5}{10} + \frac{3}{10} = ___$$

Task card 16 Adding Fractions with Like Denomin...

$$\frac{2}{6} + \frac{1}{6} = ___$$

Task card 17 Adding Fractions with Like Denomin...

$$\frac{4}{10} + \frac{2}{10} = ___$$

Task card 18 Adding Fractions with Like Denomin...

The bars show the fractions. $\frac{2}{6} + \frac{2}{6} = ___$

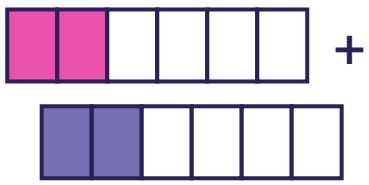

Task card 19 Adding Fractions with Like Denomin...

$\frac{1}{6} + \frac{2}{6} = \frac{3}{6}$. Write $\frac{3}{6}$ in lowest terms: ___

Task card 20 Adding Fractions with Like Denomin...

$$\frac{1}{6} + \frac{\quad}{6} = \frac{2}{6}$$

Task card 21 Adding Fractions with Like Denomin...

Max poured $\frac{3}{10}$ of a liter, then $\frac{2}{10}$ of a liter. How many liters did Max pour in all?

Task card 22 Adding Fractions with Like Denomin...

Make both sides equal: $\frac{1}{10} + \frac{4}{10}$

$$= \frac{2}{10} + \frac{\quad}{10}$$

Task card 23 Adding Fractions with Like Denomin...

$$\frac{1}{3} + \frac{1}{3} = ___$$

Task card 24 Adding Fractions with Like Denomin...

$$\frac{1}{5} + \frac{1}{5} = ___$$

Adding Fractions with Like Denominators Task Cards

Recording sheet · Grade 4 · Answer each question. Write fraction answers in lowest terms; write an answer greater than 1 as a mixed number.

Scan to check your answers

Name: _____ Date: _____

1	2	3	4
5	6	7	8
9	10	11	12
13	14	15	16
17	18	19	20
21	22	23	24

Adding Fractions with Like Denominators Task Cards: Answer Key

Grade 4 · Easy

The answers online

1. $\frac{5}{6}$	**2.** $\frac{4}{5}$	**3.** $\frac{5}{6}$
4. $\frac{3}{4}$	**5.** $\frac{3}{5}$	**6.** 1
7. $\frac{3}{4}$	**8.** 2	**9.** $\frac{5}{6}$
10. $\frac{6}{7}$	**11.** $\frac{4}{5}$	**12.** 4
13. $\frac{11}{12}$	**14.** 2	**15.** $\frac{4}{5}$
16. $\frac{1}{2}$	**17.** $\frac{3}{5}$	**18.** $\frac{2}{3}$
19. $\frac{1}{2}$	**20.** 1	**21.** $\frac{1}{2}$
22. 3	**23.** $\frac{2}{3}$	**24.** $\frac{2}{5}$