Adding Fractions with Like Denominators · 1

$\frac{7}{8} + \frac{2}{8} = ___$

Adding Fractions with Like Denominators · 2

$\frac{2}{3} + \frac{2}{3} = ___$

Adding Fractions with Like Denominators · 3

$\frac{4}{6} + \frac{3}{6} = ___$

Adding Fractions with Like Denominators · 4

The bars show the fractions. $\frac{3}{6} + \frac{4}{6} = ___$

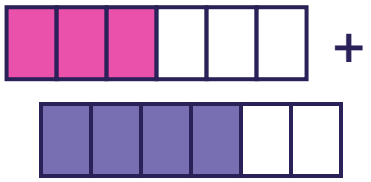

Adding Fractions with Like Denominators · 5

$\frac{5}{6} + \frac{2}{6} = \frac{7}{6}$. Write $\frac{7}{6}$ as a mixed number: ___

Adding Fractions with Like Denominators · 6

$\frac{3}{5} + \frac{__}{5} = \frac{7}{5}$

Adding Fractions with Like Denominators · 7

Max walked $\frac{6}{8}$ of a mile, then $\frac{3}{8}$ of a mile. How many miles did Max walk in all?

Adding Fractions with Like Denominators · 8

Make both sides equal: $\frac{2}{4} + \frac{3}{4} = \frac{3}{4} + \frac{__}{4}$

Adding Fractions with Like Denominators · 2

ANSWER

$$1\frac{1}{3}$$

Adding Fractions with Like Denominators · 1

ANSWER

$$1\frac{1}{8}$$

Adding Fractions with Like Denominators · 4

ANSWER

$$1\frac{1}{6}$$

Adding Fractions with Like Denominators · 3

ANSWER

$$1\frac{1}{6}$$

Adding Fractions with Like Denominators · 6

ANSWER

$$4$$

Adding Fractions with Like Denominators · 5

ANSWER

$$1\frac{1}{6}$$

Adding Fractions with Like Denominators · 8

ANSWER

$$2$$

Adding Fractions with Like Denominators · 7

ANSWER

$$1\frac{1}{8}$$

Adding Fractions with Like Denominators · 9

$\frac{8}{10} + \frac{6}{10} = ___$

Adding Fractions with Like Denominators · 10

$\frac{10}{12} + \frac{11}{12} = ___$

Adding Fractions with Like Denominators · 11

$\frac{7}{12} + \frac{9}{12} = ___$

Adding Fractions with Like Denominators · 12

The bars show the fractions. $\frac{8}{10} + \frac{4}{10} = __$

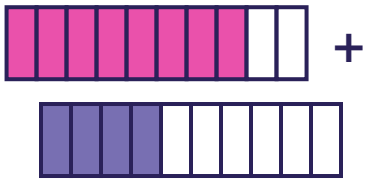

Adding Fractions with Like Denominators · 13

$\frac{6}{8} + \frac{6}{8} = \frac{12}{8}$. Write $\frac{12}{8}$ as a mixed number in lowest terms: ___

Adding Fractions with Like Denominators · 14

$\frac{5}{8} + \frac{__}{8} = \frac{10}{8}$

Adding Fractions with Like Denominators · 15

Ben painted $\frac{3}{4}$ of a meter, then $\frac{3}{4}$ of a meter. How many meters did Ben paint in all?

Adding Fractions with Like Denominators · 16

Make both sides equal: $\frac{4}{6} + \frac{4}{6} = \frac{5}{6} + \frac{__}{6}$

Adding Fractions with Like Denominators · 10

ANSWER

$$1\frac{3}{4}$$

Adding Fractions with Like Denominators · 9

ANSWER

$$1\frac{2}{5}$$

Adding Fractions with Like Denominators · 12

ANSWER

$$1\frac{1}{5}$$

Adding Fractions with Like Denominators · 11

ANSWER

$$1\frac{1}{3}$$

Adding Fractions with Like Denominators · 14

ANSWER

$$5$$

Adding Fractions with Like Denominators · 13

ANSWER

$$1\frac{1}{2}$$

Adding Fractions with Like Denominators · 16

ANSWER

$$3$$

Adding Fractions with Like Denominators · 15

ANSWER

$$1\frac{1}{2}$$

Adding Fractions with Like Denominators · 17

$\frac{4}{10} + \frac{7}{10} = ___$

Adding Fractions with Like Denominators · 18

$\frac{3}{8} + \frac{3}{8} = ___$

Adding Fractions with Like Denominators · 19

$\frac{2}{5} + \frac{1}{5} = ___$

Adding Fractions with Like Denominators · 20

The bars show the fractions. $\frac{4}{10} + \frac{8}{10} = __$

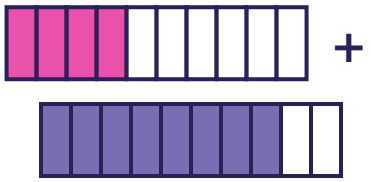

Adding Fractions with Like Denominators · 21

$\frac{11}{12} + \frac{7}{12} = \frac{18}{12}$. Write $\frac{18}{12}$ as a mixed number in lowest terms: __

Adding Fractions with Like Denominators · 22

$\frac{8}{9} + \frac{__}{9} = \frac{15}{9}$

Adding Fractions with Like Denominators · 23

Sam poured $\frac{1}{8}$ of a liter, then $\frac{5}{8}$ of a liter. How many liters did Sam pour in all?

Adding Fractions with Like Denominators · 24

Make both sides equal: $\frac{4}{10} + \frac{5}{10} = \frac{5}{10} + \frac{__}{10}$

Adding Fractions with Like Denominators · 18

ANSWER

$\frac{3}{4}$

Adding Fractions with Like Denominators · 17

ANSWER

$1\frac{1}{10}$

Adding Fractions with Like Denominators · 20

ANSWER

$1\frac{1}{5}$

Adding Fractions with Like Denominators · 19

ANSWER

$\frac{3}{5}$

Adding Fractions with Like Denominators · 22

ANSWER

7

Adding Fractions with Like Denominators · 21

ANSWER

$1\frac{1}{2}$

Adding Fractions with Like Denominators · 24

ANSWER

4

Adding Fractions with Like Denominators · 23

ANSWER

$\frac{3}{4}$