Task card 1 Adding Decimals on a Number Line

$$0.64 + 0.98 = ____$$



Task card 2 Adding Decimals on a Number Line

$$0.98 + 0.35 = ____$$

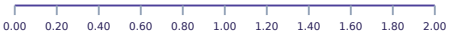

Task card 3 Adding Decimals on a Number Line

$$0.15 + 1.44 = ____$$

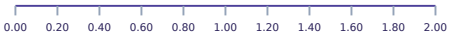

Task card 4 Adding Decimals on a Number Line

$$0.53 + 0.74 = ____$$



Task card 5 Adding Decimals on a Number Line

$$0.43 + 0.99 = ____$$



Task card 6 Adding Decimals on a Number Line

$$1.74 + 0.26 = ____$$



Task card 7 Adding Decimals on a Number Line

$$0.33 + 0.71 = ____$$



Task card 8 Adding Decimals on a Number Line

$$0.15 + 1.22 = ____$$

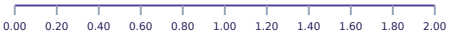

Task card 9 Adding Decimals on a Number Line

$$0.71 + 1.74 = ____$$



Task card 10 Adding Decimals on a Number Line

$$0.86 + 0.52 = ____$$



Task card 11 Adding Decimals on a Number Line

$$0.64 + 2.26 = ____$$



Task card 12 Adding Decimals on a Number Line

$$1.95 + 0.82 = ____$$



Task card 13 Adding Decimals on a Number Line

$1.07 + 1.07 =$ ____

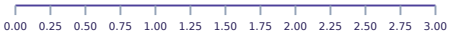

Task card 14 Adding Decimals on a Number Line

$1.75 + 0.66 =$ ____

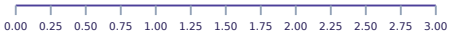

Task card 15 Adding Decimals on a Number Line

$1.28 + 0.99 =$ ____



Task card 16 Adding Decimals on a Number Line

$0.82 + 0.81 =$ ____



Task card 17 Adding Decimals on a Number Line

$0.21 + 1.34 =$ ____



Task card 18 Adding Decimals on a Number Line

$0.55 + 0.93 =$ ____



Task card 19 Adding Decimals on a Number Line

$$0.37 + 1.36 = ____$$



Task card 20 Adding Decimals on a Number Line

$$0.26 + 0.98 = ____$$

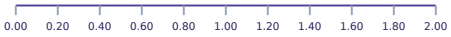

Task card 21 Adding Decimals on a Number Line

$$0.12 + 1.49 = ____$$

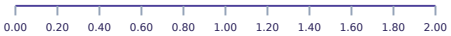

Task card 22 Adding Decimals on a Number Line

$$0.67 + 0.65 = ____$$



Task card 23 Adding Decimals on a Number Line

$$0.71 + 1.17 = ____$$



Task card 24 Adding Decimals on a Number Line

$$0.99 + 0.13 = ____$$



Adding Decimals on a Number Line Task Cards

Recording sheet · Grade 4 · Use the number line to find each sum.

Name: _____ Date: _____

Scan to check your answers

1	2	3	4
5	6	7	8
9	10	11	12
13	14	15	16
17	18	19	20
21	22	23	24

Adding Decimals on a Number Line Task Cards: Answer Key

Grade 4 · Hard

The answers online

1. 1.62	**2.** 1.33	**3.** 1.59
4. 1.27	**5.** 1.42	**6.** 2.00
7. 1.04	**8.** 1.37	**9.** 2.45
10. 1.38	**11.** 2.90	**12.** 2.77
13. 2.14	**14.** 2.41	**15.** 2.27
16. 1.63	**17.** 1.55	**18.** 1.48
19. 1.73	**20.** 1.24	**21.** 1.61
22. 1.32	**23.** 1.88	**24.** 1.12