Task card 1 Adding Decimals on a Number Line

$1.2 + 1.2 = ___$



Task card 2 Adding Decimals on a Number Line

$2.7 + 0.3 = ___$



Task card 3 Adding Decimals on a Number Line

$0.7 + 0.6 = ___$

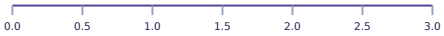

Task card 4 Adding Decimals on a Number Line

$0.7 + 1.4 = ___$



Task card 5 Adding Decimals on a Number Line

$0.6 + 0.5 = ___$



Task card 6 Adding Decimals on a Number Line

$2.4 + 0.6 = ___$



Task card 7 Adding Decimals on a Number Line

$1.8 + 0.5 = ___$



Task card 8 Adding Decimals on a Number Line

$0.6 + 0.4 = ___$



Task card 9 Adding Decimals on a Number Line

$0.19 + 0.07 =$

____



Task card 10 Adding Decimals on a Number Line

$0.31 + 0.25 =$

____



Task card 11 Adding Decimals on a Number Line

$0.71 + 0.05 =$

____



Task card 12 Adding Decimals on a Number Line

$0.38 + 0.45 =$

____

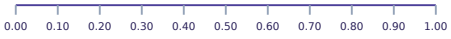

Task card 13 Adding Decimals on a Number Line

$$0.43 + 0.48 = ____$$



Task card 14 Adding Decimals on a Number Line

$$0.08 + 0.18 = ____$$



Task card 15 Adding Decimals on a Number Line

$$0.48 + 0.49 = ____$$



Task card 16 Adding Decimals on a Number Line

$$0.56 + 0.37 = ____$$



Task card 17 Adding Decimals on a Number Line

$$0.15 + 1.35 = ____$$



Task card 18 Adding Decimals on a Number Line

$$1.87 + 0.05 = ____$$



Task card 19 Adding Decimals on a Number Line

$$0.29 + 1.36 = ____$$



Task card 20 Adding Decimals on a Number Line

$$0.19 + 1.26 = ____$$



Task card 21 Adding Decimals on a Number Line

$$0.95 + 0.13 = ____$$



Task card 22 Adding Decimals on a Number Line

$$1.31 + 0.12 = ____$$



Task card 23 Adding Decimals on a Number Line

$$1.87 + 0.12 = ____$$



Task card 24 Adding Decimals on a Number Line

$$0.78 + 0.27 = ____$$



Adding Decimals on a Number Line Task Cards

Recording sheet · Grade 4 · Use the number line to find each sum.

Name: _____ Date: _____

Scan to check your answers

1	2	3	4
5	6	7	8
9	10	11	12
13	14	15	16
17	18	19	20
21	22	23	24

Adding Decimals on a Number Line Task Cards: Answer Key

Grade 4 · Medium

The answers online

1. 2.4	**2.** 3.0	**3.** 1.3
4. 2.1	**5.** 1.1	**6.** 3.0
7. 2.3	**8.** 1.0	**9.** 0.26
10. 0.56	**11.** 0.76	**12.** 0.83
13. 0.91	**14.** 0.26	**15.** 0.97
16. 0.93	**17.** 1.50	**18.** 1.92
19. 1.65	**20.** 1.45	**21.** 1.08
22. 1.43	**23.** 1.99	**24.** 1.05