Adding Decimals on a Number Line · 1

$1.2 + 1.2 = ___$



Adding Decimals on a Number Line · 2

$2.7 + 0.3 = ___$



Adding Decimals on a Number Line · 3

$0.7 + 0.6 = ___$

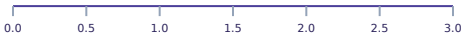

Adding Decimals on a Number Line · 4

$0.7 + 1.4 = ___$



Adding Decimals on a Number Line · 5

$0.6 + 0.5 = ___$



Adding Decimals on a Number Line · 6

$2.4 + 0.6 = ___$



Adding Decimals on a Number Line · 7

$1.8 + 0.5 = ___$



Adding Decimals on a Number Line · 8

$0.6 + 0.4 = ___$



Adding Decimals on a Number Line · 2

ANSWER

3.0

Adding Decimals on a Number Line · 1

ANSWER

2.4

Adding Decimals on a Number Line · 4

ANSWER

2.1

Adding Decimals on a Number Line · 3

ANSWER

1.3

Adding Decimals on a Number Line · 6

ANSWER

3.0

Adding Decimals on a Number Line · 5

ANSWER

1.1

Adding Decimals on a Number Line · 8

ANSWER

1.0

Adding Decimals on a Number Line · 7

ANSWER

2.3

Adding Decimals on a Number Line · 9

$0.19 + 0.07 = ___$



Adding Decimals on a Number Line · 10

$0.31 + 0.25 = ___$



Adding Decimals on a Number Line · 11

$0.71 + 0.05 = ___$



Adding Decimals on a Number Line · 12

$0.38 + 0.45 = ___$

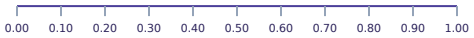

Adding Decimals on a Number Line · 13

$0.43 + 0.48 = ___$



Adding Decimals on a Number Line · 14

$0.08 + 0.18 = ___$



Adding Decimals on a Number Line · 15

$0.48 + 0.49 = ___$



Adding Decimals on a Number Line · 16

$0.56 + 0.37 = ___$



Adding Decimals on a Number Line · 10

ANSWER

0.56

Adding Decimals on a Number Line · 9

ANSWER

0.26

Adding Decimals on a Number Line · 12

ANSWER

0.83

Adding Decimals on a Number Line · 11

ANSWER

0.76

Adding Decimals on a Number Line · 14

ANSWER

0.26

Adding Decimals on a Number Line · 13

ANSWER

0.91

Adding Decimals on a Number Line · 16

ANSWER

0.93

Adding Decimals on a Number Line · 15

ANSWER

0.97

Adding Decimals on a Number Line · 17

$0.15 + 1.35 = ___$



Adding Decimals on a Number Line · 18

$1.87 + 0.05 = ___$



Adding Decimals on a Number Line · 19

$0.29 + 1.36 = ___$



Adding Decimals on a Number Line · 20

$0.19 + 1.26 = ___$



Adding Decimals on a Number Line · 21

$0.95 + 0.13 = ___$



Adding Decimals on a Number Line · 22

$1.31 + 0.12 = ___$



Adding Decimals on a Number Line · 23

$1.87 + 0.12 = ___$



Adding Decimals on a Number Line · 24

$0.78 + 0.27 = ___$



Adding Decimals on a Number Line · 18

ANSWER

1.92

Adding Decimals on a Number Line · 17

ANSWER

1.50

Adding Decimals on a Number Line · 20

ANSWER

1.45

Adding Decimals on a Number Line · 19

ANSWER

1.65

Adding Decimals on a Number Line · 22

ANSWER

1.43

Adding Decimals on a Number Line · 21

ANSWER

1.08

Adding Decimals on a Number Line · 24

ANSWER

1.05

Adding Decimals on a Number Line · 23

ANSWER

1.99