Adding Decimals on a Number Line · 1

0.64 + 0.98 = ___



Adding Decimals on a Number Line · 2

0.98 + 0.35 = ___



Adding Decimals on a Number Line · 3

0.15 + 1.44 = ___



Adding Decimals on a Number Line · 4

0.53 + 0.74 = ___



Adding Decimals on a Number Line · 5

0.43 + 0.99 = ___



Adding Decimals on a Number Line · 6

1.74 + 0.26 = ___



Adding Decimals on a Number Line · 7

0.33 + 0.71 = ___



Adding Decimals on a Number Line · 8

0.15 + 1.22 = ___



Adding Decimals on a Number Line · 2

ANSWER

1.33

Adding Decimals on a Number Line · 1

ANSWER

1.62

Adding Decimals on a Number Line · 4

ANSWER

1.27

Adding Decimals on a Number Line · 3

ANSWER

1.59

Adding Decimals on a Number Line · 6

ANSWER

2.00

Adding Decimals on a Number Line · 5

ANSWER

1.42

Adding Decimals on a Number Line · 8

ANSWER

1.37

Adding Decimals on a Number Line · 7

ANSWER

1.04

Adding Decimals on a Number Line · 9

$0.71 + 1.74 = ___$



Adding Decimals on a Number Line · 10

$0.86 + 0.52 = ___$



Adding Decimals on a Number Line · 11

$0.64 + 2.26 = ___$



Adding Decimals on a Number Line · 12

$1.95 + 0.82 = ___$



Adding Decimals on a Number Line · 13

$1.07 + 1.07 = ___$



Adding Decimals on a Number Line · 14

$1.75 + 0.66 = ___$



Adding Decimals on a Number Line · 15

$1.28 + 0.99 = ___$



Adding Decimals on a Number Line · 16

$0.82 + 0.81 = ___$



Adding Decimals on a Number Line · 10

ANSWER

1.38

Adding Decimals on a Number Line · 9

ANSWER

2.45

Adding Decimals on a Number Line · 12

ANSWER

2.77

Adding Decimals on a Number Line · 11

ANSWER

2.90

Adding Decimals on a Number Line · 14

ANSWER

2.41

Adding Decimals on a Number Line · 13

ANSWER

2.14

Adding Decimals on a Number Line · 16

ANSWER

1.63

Adding Decimals on a Number Line · 15

ANSWER

2.27

Adding Decimals on a Number Line · 17

$0.21 + 1.34 = ___$



Adding Decimals on a Number Line · 18

$0.55 + 0.93 = ___$



Adding Decimals on a Number Line · 19

$0.37 + 1.36 = ___$



Adding Decimals on a Number Line · 20

$0.26 + 0.98 = ___$



Adding Decimals on a Number Line · 21

$0.12 + 1.49 = ___$



Adding Decimals on a Number Line · 22

$0.67 + 0.65 = ___$



Adding Decimals on a Number Line · 23

$0.71 + 1.17 = ___$



Adding Decimals on a Number Line · 24

$0.99 + 0.13 = ___$



Adding Decimals on a Number Line · 18

ANSWER

1.48

Adding Decimals on a Number Line · 17

ANSWER

1.55

Adding Decimals on a Number Line · 20

ANSWER

1.24

Adding Decimals on a Number Line · 19

ANSWER

1.73

Adding Decimals on a Number Line · 22

ANSWER

1.32

Adding Decimals on a Number Line · 21

ANSWER

1.61

Adding Decimals on a Number Line · 24

ANSWER

1.12

Adding Decimals on a Number Line · 23

ANSWER

1.88