Adding Decimals on a Number Line · 1

$0.3 + 0.6 = ___$



Adding Decimals on a Number Line · 2

$0.4 + 0.5 = ___$



Adding Decimals on a Number Line · 3

$0.3 + 0.1 = ___$

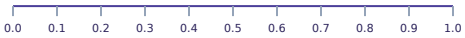

Adding Decimals on a Number Line · 4

$0.7 + 0.1 = ___$



Adding Decimals on a Number Line · 5

$0.6 + 0.2 = ___$



Adding Decimals on a Number Line · 6

$0.2 + 0.2 = ___$



Adding Decimals on a Number Line · 7

$0.7 + 0.2 = ___$



Adding Decimals on a Number Line · 8

$0.2 + 0.7 = ___$



Adding Decimals on a Number Line · 2

ANSWER

0.9

Adding Decimals on a Number Line · 1

ANSWER

0.9

Adding Decimals on a Number Line · 4

ANSWER

0.8

Adding Decimals on a Number Line · 3

ANSWER

0.4

Adding Decimals on a Number Line · 6

ANSWER

0.4

Adding Decimals on a Number Line · 5

ANSWER

0.8

Adding Decimals on a Number Line · 8

ANSWER

0.9

Adding Decimals on a Number Line · 7

ANSWER

0.9

Adding Decimals on a Number Line · 9

$1.6 + 0.3 = ___$



Adding Decimals on a Number Line · 10

$1.8 + 0.1 = ___$



Adding Decimals on a Number Line · 11

$1.3 + 0.5 = ___$

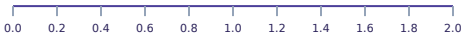

Adding Decimals on a Number Line · 12

$0.3 + 0.8 = ___$



Adding Decimals on a Number Line · 13

$0.8 + 0.9 = ___$



Adding Decimals on a Number Line · 14

$0.7 + 0.7 = ___$



Adding Decimals on a Number Line · 15

$1.5 + 0.3 = ___$



Adding Decimals on a Number Line · 16

$0.8 + 0.3 = ___$



Adding Decimals on a Number Line · 10

ANSWER

1.9

Adding Decimals on a Number Line · 9

ANSWER

1.9

Adding Decimals on a Number Line · 12

ANSWER

1.1

Adding Decimals on a Number Line · 11

ANSWER

1.8

Adding Decimals on a Number Line · 14

ANSWER

1.4

Adding Decimals on a Number Line · 13

ANSWER

1.7

Adding Decimals on a Number Line · 16

ANSWER

1.1

Adding Decimals on a Number Line · 15

ANSWER

1.8

Adding Decimals on a Number Line · 17

$0.4 + 1.4 = ___$



Adding Decimals on a Number Line · 18

$0.8 + 0.4 = ___$



Adding Decimals on a Number Line · 19

$0.4 + 0.9 = ___$

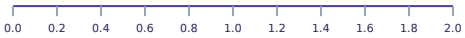

Adding Decimals on a Number Line · 20

$0.9 + 1.1 = ___$

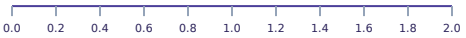

Adding Decimals on a Number Line · 21

$1.4 + 0.6 = ___$



Adding Decimals on a Number Line · 22

$0.6 + 0.5 = ___$



Adding Decimals on a Number Line · 23

$1.5 + 0.5 = ___$



Adding Decimals on a Number Line · 24

$0.5 + 0.5 = ___$



Adding Decimals on a Number Line · 18

ANSWER

1.2

Adding Decimals on a Number Line · 17

ANSWER

1.8

Adding Decimals on a Number Line · 20

ANSWER

2.0

Adding Decimals on a Number Line · 19

ANSWER

1.3

Adding Decimals on a Number Line · 22

ANSWER

1.1

Adding Decimals on a Number Line · 21

ANSWER

2.0

Adding Decimals on a Number Line · 24

ANSWER

1.0

Adding Decimals on a Number Line · 23

ANSWER

2.0