Task card 1 Adding Decimals with Bar Charts

What is the total of all the bars?

___ km

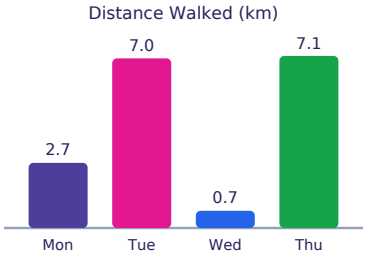

Task card 2 Adding Decimals with Bar Charts

What is the total of all the bars?

___ kg

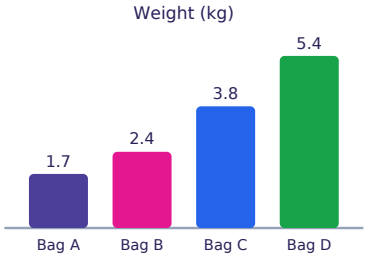

Task card 3 Adding Decimals with Bar Charts

What is the total of all the bars?

___ liters

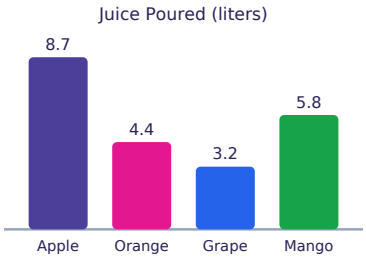

Task card 4 Adding Decimals with Bar Charts

What is Wed + Tue + Mon? ___ km

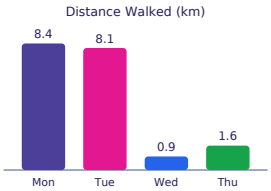

Task card 5 Adding Decimals with Bar Charts

What is the total of all the bars?

___ cm

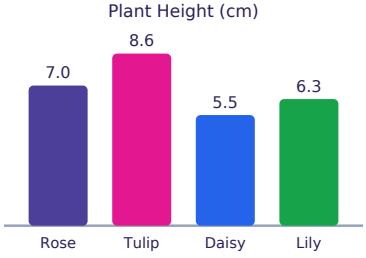

Task card 6 Adding Decimals with Bar Charts

What is Tulip + Daisy? ___ cm

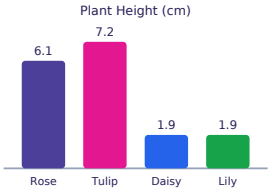

Task card 7 Adding Decimals with Bar Charts

What is the total of all the bars?

___ km

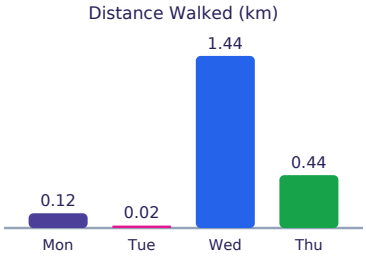

Task card 8 Adding Decimals with Bar Charts

What is Tulip + Lily?

___ cm

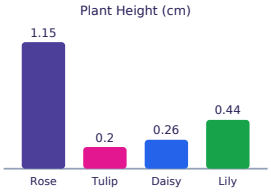

Task card 9 Adding Decimals with Bar Charts

What is Bag A + Bag B + Bag C? ___ kg

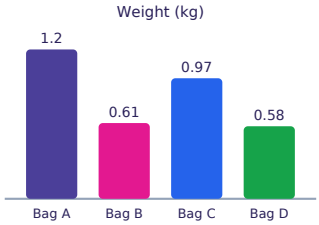

Task card 10 Adding Decimals with Bar Charts

What is the total of all the bars?

___ hours

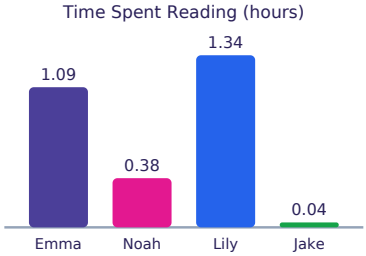

Task card 11 Adding Decimals with Bar Charts

What is Noah + Emma + Jake? ___ hours

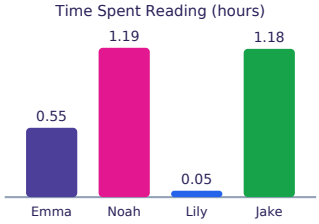

Task card 12 Adding Decimals with Bar Charts

What is Thu + Mon?

___ km

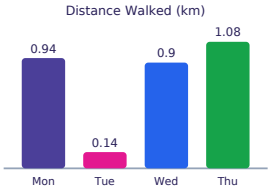

Task card 13 Adding Decimals with Bar Charts

What is May + April? ___ inches

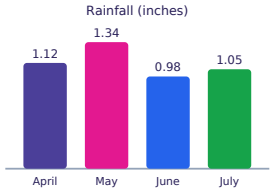

Task card 14 Adding Decimals with Bar Charts

What is Bag C + Bag D + Bag B? ___ kg

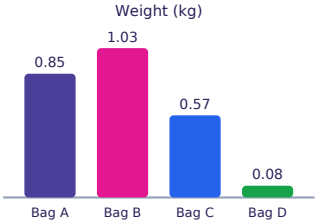

Task card 15 Adding Decimals with Bar Charts

What is Daisy + Lily + Rose? ___ cm

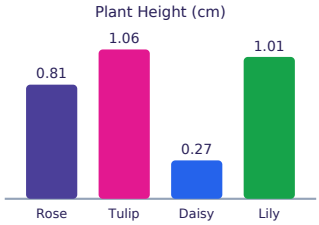

Task card 16 Adding Decimals with Bar Charts

What is Lily + Rose? ___ cm

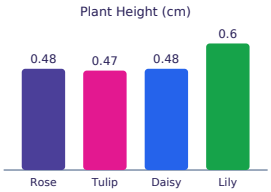

Task card 17 Adding Decimals with Bar Charts

What is Mango + Grape + Apple? ___ liters

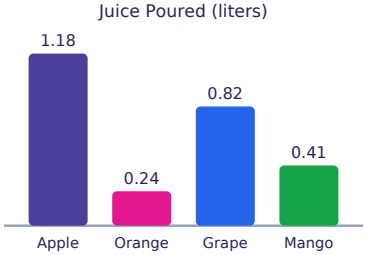

Task card 18 Adding Decimals with Bar Charts

What is Lily + Rose? ___ cm

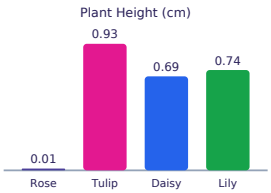

Task card 19 Adding Decimals with Bar Charts

What is the total of all the bars?

___ liters

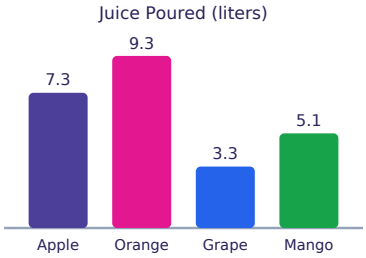

Task card 20 Adding Decimals with Bar Charts

What is Tue + Thu + Mon? ___ km

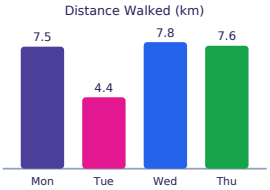

Task card 21 Adding Decimals with Bar Charts

What is the total of all the bars?

___ liters

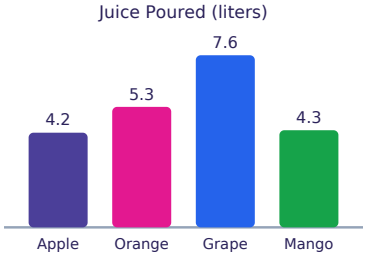

Task card 22 Adding Decimals with Bar Charts

What is Rose + Tulip + Daisy? ___ cm

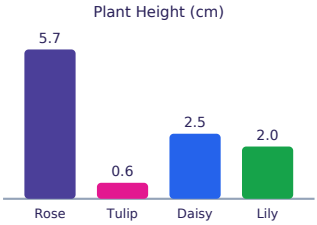

Task card 23 Adding Decimals with Bar Charts

What is the total of all the bars?

___ kg

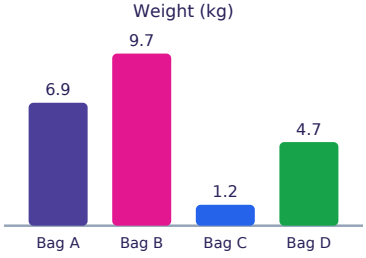

Task card 24 Adding Decimals with Bar Charts

What is the total of all the bars?

___ kg

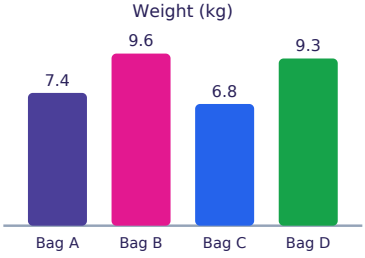

Adding Decimals with Bar Charts Task Cards

Recording sheet · Grade 4 · Look at each bar chart carefully. Read the decimal value shown on each bar, then add the values asked for in the question.

Scan to check your answers

Name: _____ Date: _____

1	2	3	4
5	6	7	8
9	10	11	12
13	14	15	16
17	18	19	20
21	22	23	24

Adding Decimals with Bar Charts Task Cards: Answer Key

Grade 4 · Medium

The answers online

1. 17.5	**2.** 13.3	**3.** 22.1
4. 17.4	**5.** 27.4	**6.** 9.1
7. 2.02	**8.** 0.64	**9.** 2.78
10. 2.85	**11.** 2.92	**12.** 2.02
13. 2.46	**14.** 1.68	**15.** 2.09
16. 1.08	**17.** 2.41	**18.** 0.75
19. 25.0	**20.** 19.5	**21.** 21.4
22. 8.8	**23.** 22.5	**24.** 33.1