Adding Decimals with Bar Charts · 1

What is Daisy + Tulip? ___ cm

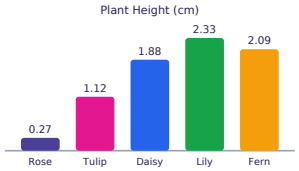

Adding Decimals with Bar Charts · 2

What is Mon + Fri? ___ km



Adding Decimals with Bar Charts · 3

What is Lily + Rose? ___ cm

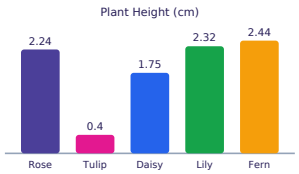

Adding Decimals with Bar Charts · 4

What is Bag B + Bag A? ___ kg

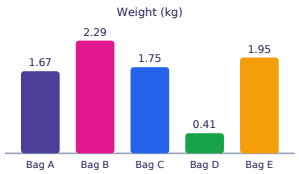

Adding Decimals with Bar Charts · 5

What is May + July? ___ inches

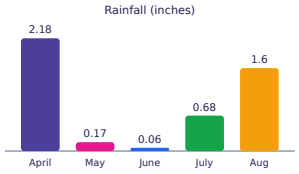

Adding Decimals with Bar Charts · 6

What is the total of all the bars? ___ cm

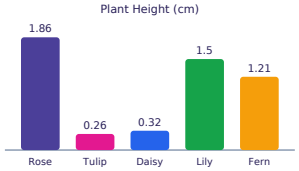

Adding Decimals with Bar Charts · 7

What is Fern + Rose? ___ cm

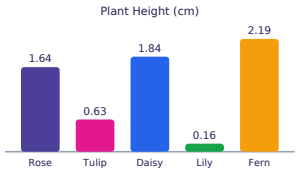

Adding Decimals with Bar Charts · 8

What is April + July? ___ inches

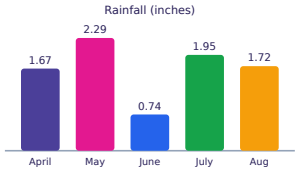

Adding Decimals with Bar Charts · 2

ANSWER

1.34

Adding Decimals with Bar Charts · 1

ANSWER

3.0

Adding Decimals with Bar Charts · 4

ANSWER

3.96

Adding Decimals with Bar Charts · 3

ANSWER

4.56

Adding Decimals with Bar Charts · 6

ANSWER

5.15

Adding Decimals with Bar Charts · 5

ANSWER

0.85

Adding Decimals with Bar Charts · 8

ANSWER

3.62

Adding Decimals with Bar Charts · 7

ANSWER

3.83

Adding Decimals with Bar Charts · 9

What is the total of all the bars? ___ km

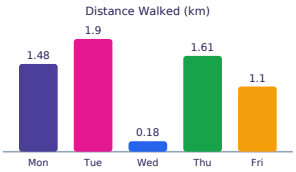

Adding Decimals with Bar Charts · 10

What is Orange + Grape + Mango? ___ liters

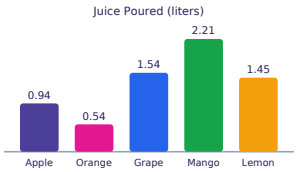

Adding Decimals with Bar Charts · 11

What is Rose + Fern + Lily? ___ cm

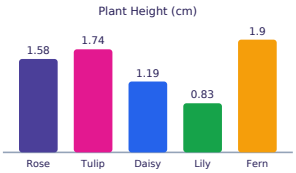

Adding Decimals with Bar Charts · 12

What is Bag B + Bag E + Bag D? ___ kg



Adding Decimals with Bar Charts · 13

What is the total of all the bars? ___ inches

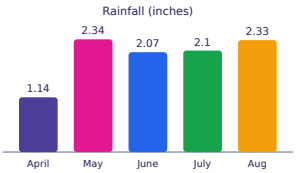

Adding Decimals with Bar Charts · 14

What is the total of all the bars? ___ inches

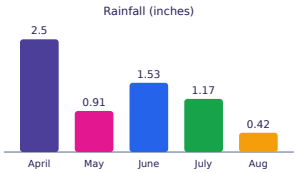

Adding Decimals with Bar Charts · 15

What is Bag D + Bag C? ___ kg

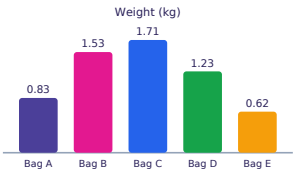

Adding Decimals with Bar Charts · 16

What is Bag B + Bag A? ___ kg



Adding Decimals with Bar Charts · 10

ANSWER

4.29

Adding Decimals with Bar Charts · 9

ANSWER

6.27

Adding Decimals with Bar Charts · 12

ANSWER

2.88

Adding Decimals with Bar Charts · 11

ANSWER

4.31

Adding Decimals with Bar Charts · 14

ANSWER

6.53

Adding Decimals with Bar Charts · 13

ANSWER

9.98

Adding Decimals with Bar Charts · 16

ANSWER

1.91

Adding Decimals with Bar Charts · 15

ANSWER

2.94

Adding Decimals with Bar Charts · 17

What is Mango + Orange + Lemon? ___ liters

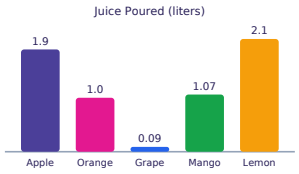

Adding Decimals with Bar Charts · 18

What is the total of all the bars? ___ hours

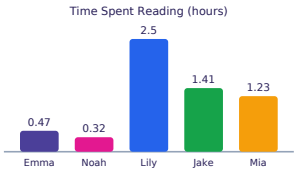

Adding Decimals with Bar Charts · 19

What is Bag D + Bag E? ___ kg

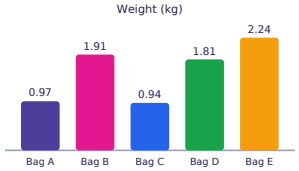

Adding Decimals with Bar Charts · 20

What is the total of all the bars? ___ km



Adding Decimals with Bar Charts · 21

What is June + April? ___ inches

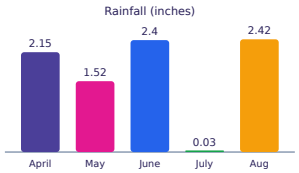

Adding Decimals with Bar Charts · 22

What is the total of all the bars? ___ liters

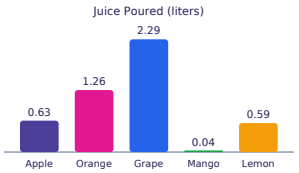

Adding Decimals with Bar Charts · 23

What is Mango + Lemon? ___ liters

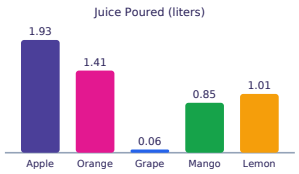

Adding Decimals with Bar Charts · 24

What is the total of all the bars? ___ km

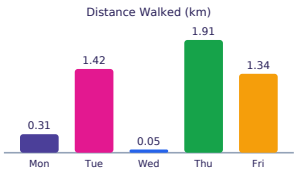

Adding Decimals with Bar Charts · 18

ANSWER

5.93

Adding Decimals with Bar Charts · 17

ANSWER

4.17

Adding Decimals with Bar Charts · 20

ANSWER

4.41

Adding Decimals with Bar Charts · 19

ANSWER

4.05

Adding Decimals with Bar Charts · 22

ANSWER

4.81

Adding Decimals with Bar Charts · 21

ANSWER

4.55

Adding Decimals with Bar Charts · 24

ANSWER

5.03

Adding Decimals with Bar Charts · 23

ANSWER

1.86