Adding Decimals with Bar Charts · 1

What is the total of all the bars? ___ km

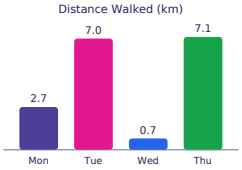

Adding Decimals with Bar Charts · 2

What is the total of all the bars? ___ kg

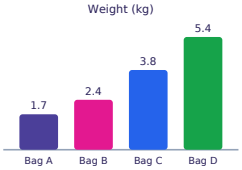

Adding Decimals with Bar Charts · 3

What is the total of all the bars? ___ liters

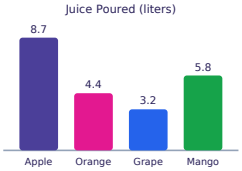

Adding Decimals with Bar Charts · 4

What is Wed + Tue + Mon? ___ km

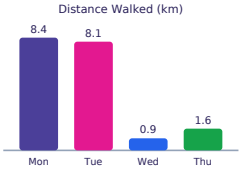

Adding Decimals with Bar Charts · 5

What is the total of all the bars? ___ cm

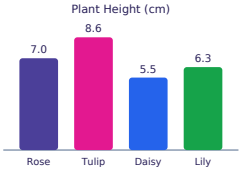

Adding Decimals with Bar Charts · 6

What is Tulip + Daisy? ___ cm

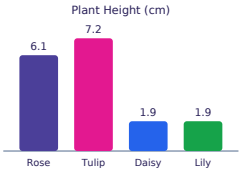

Adding Decimals with Bar Charts · 7

What is the total of all the bars? ___ km

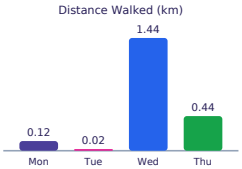

Adding Decimals with Bar Charts · 8

What is Tulip + Lily? ___ cm

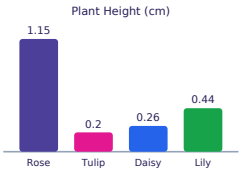

Adding Decimals with Bar Charts · 2

ANSWER

13.3

Adding Decimals with Bar Charts · 1

ANSWER

17.5

Adding Decimals with Bar Charts · 4

ANSWER

17.4

Adding Decimals with Bar Charts · 3

ANSWER

22.1

Adding Decimals with Bar Charts · 6

ANSWER

9.1

Adding Decimals with Bar Charts · 5

ANSWER

27.4

Adding Decimals with Bar Charts · 8

ANSWER

0.64

Adding Decimals with Bar Charts · 7

ANSWER

2.02

What is Bag A + Bag B + Bag C? ___ kg

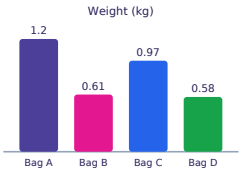

What is the total of all the bars? ___ hours

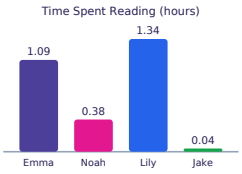

What is Noah + Emma + Jake? ___ hours

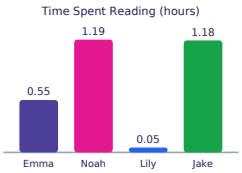

What is Thu + Mon? ___ km

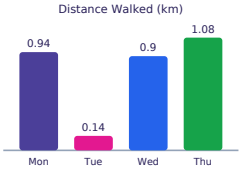

What is May + April? ___ inches

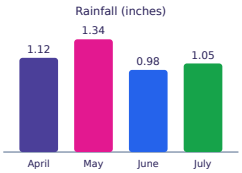

What is Bag C + Bag D + Bag B? ___ kg

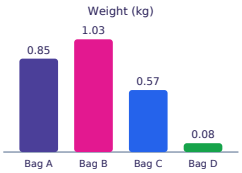

What is Daisy + Lily + Rose? ___ cm

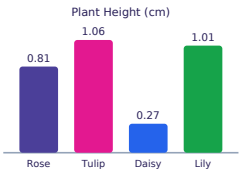

What is Lily + Rose? ___ cm

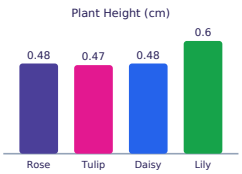

Adding Decimals with Bar Charts · 10

ANSWER

2.85

Adding Decimals with Bar Charts · 9

ANSWER

2.78

Adding Decimals with Bar Charts · 12

ANSWER

2.02

Adding Decimals with Bar Charts · 11

ANSWER

2.92

Adding Decimals with Bar Charts · 14

ANSWER

1.68

Adding Decimals with Bar Charts · 13

ANSWER

2.46

Adding Decimals with Bar Charts · 16

ANSWER

1.08

Adding Decimals with Bar Charts · 15

ANSWER

2.09

Adding Decimals with Bar Charts · 17

What is Mango + Grape + Apple? ___ liters

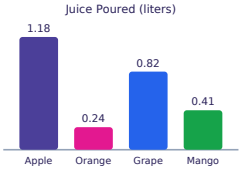

Adding Decimals with Bar Charts · 18

What is Lily + Rose? ___ cm

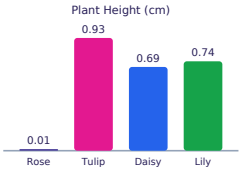

Adding Decimals with Bar Charts · 19

What is the total of all the bars? ___ liters

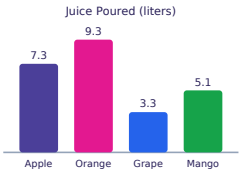

Adding Decimals with Bar Charts · 20

What is Tue + Thu + Mon? ___ km

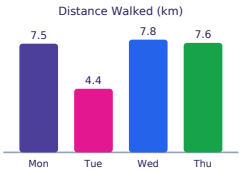

Adding Decimals with Bar Charts · 21

What is the total of all the bars? ___ liters

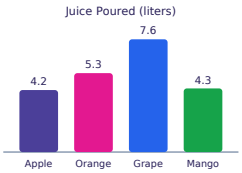

Adding Decimals with Bar Charts · 22

What is Rose + Tulip + Daisy? ___ cm

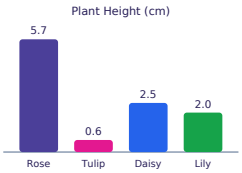

Adding Decimals with Bar Charts · 23

What is the total of all the bars? ___ kg

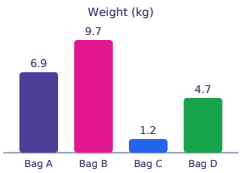

Adding Decimals with Bar Charts · 24

What is the total of all the bars? ___ kg

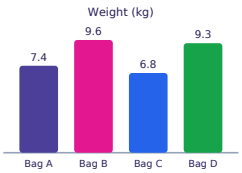

Adding Decimals with Bar Charts · 18

ANSWER

0.75

Adding Decimals with Bar Charts · 17

ANSWER

2.41

Adding Decimals with Bar Charts · 20

ANSWER

19.5

Adding Decimals with Bar Charts · 19

ANSWER

25.0

Adding Decimals with Bar Charts · 22

ANSWER

8.8

Adding Decimals with Bar Charts · 21

ANSWER

21.4

Adding Decimals with Bar Charts · 24

ANSWER

33.1

Adding Decimals with Bar Charts · 23

ANSWER

22.5