Adding Decimals with Bar Charts · 1

What is the total of all the bars? ___ hours



Adding Decimals with Bar Charts · 2

What is Bag C + Bag A? ___ kg

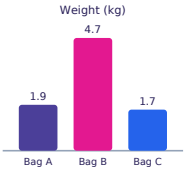

Adding Decimals with Bar Charts · 3

What is Daisy + Rose + Tulip? ___ cm

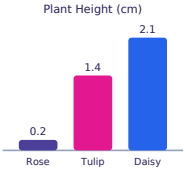

Adding Decimals with Bar Charts · 4

What is the total of all the bars? ___ km

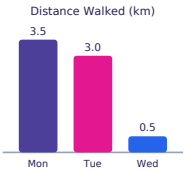

Adding Decimals with Bar Charts · 5

What is the total of all the bars? ___ hours



Adding Decimals with Bar Charts · 6

What is Wed + Tue? ___ km

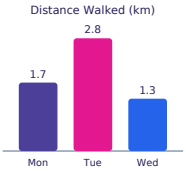

Adding Decimals with Bar Charts · 7

What is the total of all the bars? ___ cm

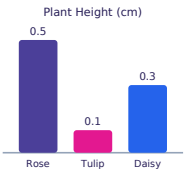

Adding Decimals with Bar Charts · 8

What is Grape + Apple + Orange? ___ liters

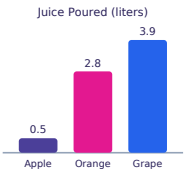

Adding Decimals with Bar Charts · 2

ANSWER

3.6

Adding Decimals with Bar Charts · 1

ANSWER

10.0

Adding Decimals with Bar Charts · 4

ANSWER

7.0

Adding Decimals with Bar Charts · 3

ANSWER

3.7

Adding Decimals with Bar Charts · 6

ANSWER

4.1

Adding Decimals with Bar Charts · 5

ANSWER

9.8

Adding Decimals with Bar Charts · 8

ANSWER

7.2

Adding Decimals with Bar Charts · 7

ANSWER

0.9

Adding Decimals with Bar Charts · 9

What is Bag C + Bag B + Bag A? ___ kg

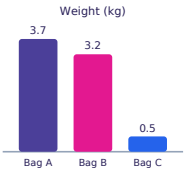

Adding Decimals with Bar Charts · 10

What is Mon + Wed? ___ km

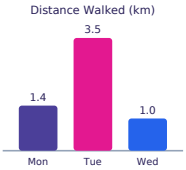

Adding Decimals with Bar Charts · 11

What is June + May + April? ___ inches

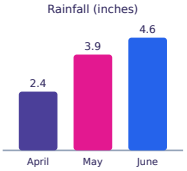

Adding Decimals with Bar Charts · 12

What is the total of all the bars? ___ inches

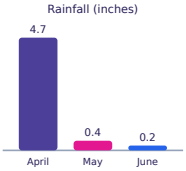

Adding Decimals with Bar Charts · 13

What is the total of all the bars? ___ liters

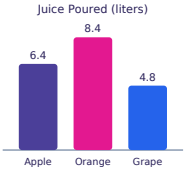

Adding Decimals with Bar Charts · 14

What is Rose + Daisy + Tulip? ___ cm

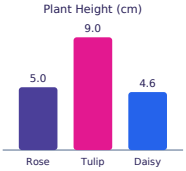

Adding Decimals with Bar Charts · 15

What is the total of all the bars? ___ cm

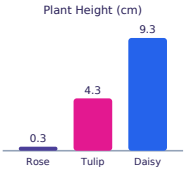

Adding Decimals with Bar Charts · 16

What is Wed + Mon? ___ km

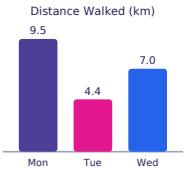

Adding Decimals with Bar Charts · 10

ANSWER

2.4

Adding Decimals with Bar Charts · 9

ANSWER

7.4

Adding Decimals with Bar Charts · 12

ANSWER

5.3

Adding Decimals with Bar Charts · 11

ANSWER

10.9

Adding Decimals with Bar Charts · 14

ANSWER

18.6

Adding Decimals with Bar Charts · 13

ANSWER

19.6

Adding Decimals with Bar Charts · 16

ANSWER

16.5

Adding Decimals with Bar Charts · 15

ANSWER

13.9

Adding Decimals with Bar Charts · 17

What is Tulip + Rose? ___ cm

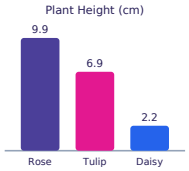

Adding Decimals with Bar Charts · 18

What is Apple + Grape + Orange? ___ liters

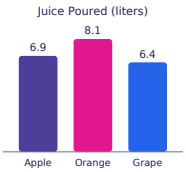

Adding Decimals with Bar Charts · 19

What is Bag C + Bag A? ___ kg

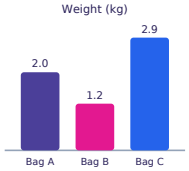

Adding Decimals with Bar Charts · 20

What is Emma + Lily + Noah? ___ hours



Adding Decimals with Bar Charts · 21

What is the total of all the bars? ___ inches

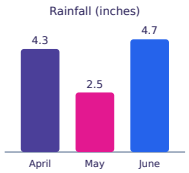

Adding Decimals with Bar Charts · 22

What is the total of all the bars? ___ cm

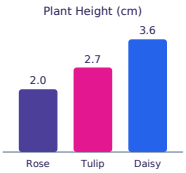

Adding Decimals with Bar Charts · 23

What is Bag A + Bag B? ___ kg

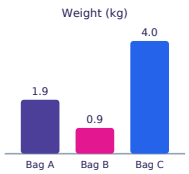

Adding Decimals with Bar Charts · 24

What is the total of all the bars? ___ km

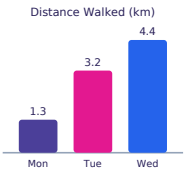

Adding Decimals with Bar Charts · 18

ANSWER

21.4

Adding Decimals with Bar Charts · 17

ANSWER

16.8

Adding Decimals with Bar Charts · 20

ANSWER

3.4

Adding Decimals with Bar Charts · 19

ANSWER

4.9

Adding Decimals with Bar Charts · 22

ANSWER

8.3

Adding Decimals with Bar Charts · 21

ANSWER

11.5

Adding Decimals with Bar Charts · 24

ANSWER

8.9

Adding Decimals with Bar Charts · 23

ANSWER

2.8