Task card 1 Add & Subtract Fractions with Like...

$\frac{1}{3} + \frac{1}{3} = ___$

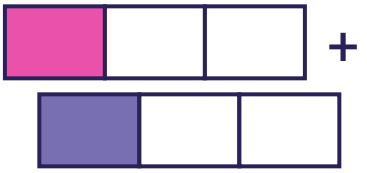

Task card 2 Add & Subtract Fractions with Like...

$\frac{2}{3} - \frac{1}{3} = ___$



Task card 3 Add & Subtract Fractions with Like...

$\frac{1}{5} + \frac{1}{5} = ___$

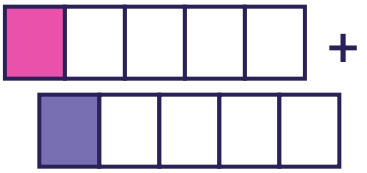

Task card 4 Add & Subtract Fractions with Like...

$\frac{2}{8} - \frac{1}{8} = ___$



Task card 5 Add & Subtract Fractions with Like...

$\frac{2}{6} + \frac{3}{6} = ___$

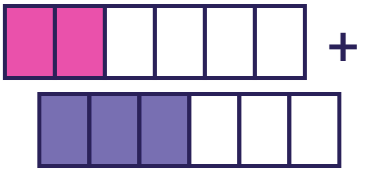

Task card 6 Add & Subtract Fractions with Like...

$\frac{7}{8} - \frac{6}{8} = ___$



Task card 7 Add & Subtract Fractions with Like...

$\frac{3}{5} + \frac{1}{5} = ___$

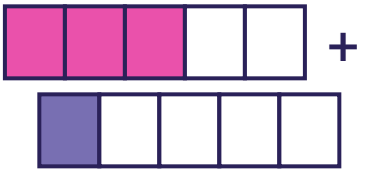

Task card 8 Add & Subtract Fractions with Like...

$\frac{4}{8} - \frac{3}{8} = ___$



Task card 9 Add & Subtract Fractions with Like...

$\frac{2}{4} - \frac{1}{4} = ___$



Task card 10 Add & Subtract Fractions with Like...

$\frac{4}{5} - \frac{1}{5} = ___$



Task card 11 Add & Subtract Fractions with Like...

$\frac{2}{5} + \frac{1}{5} = ___$

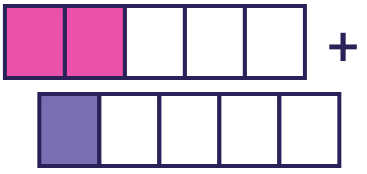

Task card 12 Add & Subtract Fractions with Like...

$\frac{2}{6} - \frac{1}{6} = ___$



Task card 13 Add & Subtract Fractions with Like...

$$\frac{6}{10} + \frac{1}{10} = ___$$

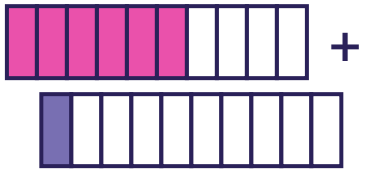

Task card 14 Add & Subtract Fractions with Like...

$$1 - \frac{2}{3} = ___$$

Task card 15 Add & Subtract Fractions with Like...

$$\frac{5}{12} + \frac{2}{12} = ___$$

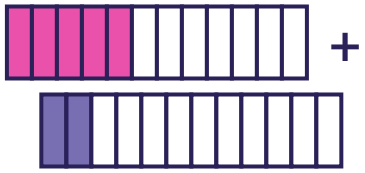

Task card 16 Add & Subtract Fractions with Like...

$$1 - \frac{1}{4} = ___$$

Task card 17 Add & Subtract Fractions with Like...

$$\frac{2}{8} + \frac{3}{8} = ___$$

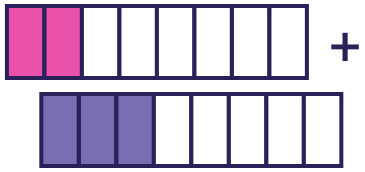

Task card 18 Add & Subtract Fractions with Like...

$$\frac{4}{6} + \frac{1}{6} = ___$$

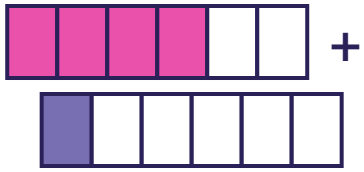

Task card 19 Add & Subtract Fractions with Like...

$$\frac{4}{5} - \frac{3}{5} = ___$$



Task card 20 Add & Subtract Fractions with Like...

$$\frac{1}{5} + \frac{2}{5} = ___$$

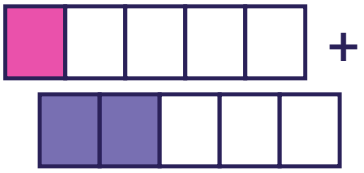

Task card 21 Add & Subtract Fractions with Like...

$$\frac{2}{5} - \frac{1}{5} = ___$$



Task card 22 Add & Subtract Fractions with Like...

$$\frac{3}{8} + \frac{2}{8} = ___$$

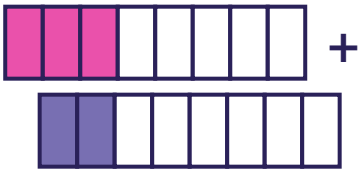

Task card 23 Add & Subtract Fractions with Like...

$$\frac{3}{6} - \frac{2}{6} = ___$$



Task card 24 Add & Subtract Fractions with Like...

$$\frac{3}{6} + \frac{2}{6} = ___$$

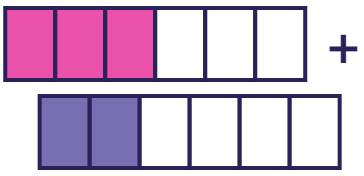

Add & Subtract Fractions with Like Denominators (Mixed Review) Task Cards

Recording sheet · Grade 4 · Add or subtract. Write each answer in simplest form; use a mixed number when the answer is greater than 1.

Scan to check your answers

Name: _____ Date: _____

1	2	3	4
5	6	7	8
9	10	11	12
13	14	15	16
17	18	19	20
21	22	23	24

Add & Subtract Fractions with Like Denominators (Mixed Review) Task Cards: Answer Key

Grade 4 · Easy

The answers online

1. $\frac{2}{3}$	**2.** $\frac{1}{3}$	**3.** $\frac{2}{5}$
4. $\frac{1}{8}$	**5.** $\frac{5}{6}$	**6.** $\frac{1}{8}$
7. $\frac{4}{5}$	**8.** $\frac{1}{8}$	**9.** $\frac{1}{4}$
10. $\frac{3}{5}$	**11.** $\frac{3}{5}$	**12.** $\frac{1}{6}$
13. $\frac{7}{10}$	**14.** $\frac{1}{3}$	**15.** $\frac{7}{12}$
16. $\frac{3}{4}$	**17.** $\frac{5}{8}$	**18.** $\frac{5}{6}$
19. $\frac{1}{5}$	**20.** $\frac{3}{5}$	**21.** $\frac{1}{5}$
22. $\frac{5}{8}$	**23.** $\frac{1}{6}$	**24.** $\frac{5}{6}$