Task card 1 100th Day of School Math

Noah tapes a paper chain all the way around a rectangular class banner that is 9 feet long and 6 feet wide. How many feet of paper chain does Noah need?

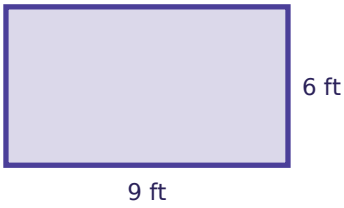

Task card 2 100th Day of School Math

Ben eats $\frac{3}{10}$ of a party pizza. Zoe eats $\frac{4}{10}$ of it. What fraction of the party pizza did they eat together?

Task card 3 100th Day of School Math

Each snack bag holds 8 cupcakes. The bakery fills 21 snack bags. How many cupcakes is that?

Task card 4 100th Day of School Math

Each snack bag holds 6 pretzels. The bakery fills 25 snack bags. How many pretzels is that?

Task card 5 100th Day of School Math

There are 37 pretzels. Each snack bag holds 6. After filling as many snack bags as possible, how many pretzels are left over?

Task card 6 100th Day of School Math

There are 35 pretzels. Each snack bag holds 3. After filling as many snack bags as possible, how many pretzels are left over?

Task card 7 100th Day of School Math

Omar eats $\frac{7}{10}$ of a party pizza. Zoe eats $\frac{2}{10}$ of it. What fraction of the party pizza did they eat together?

Task card 8 100th Day of School Math

Ava tapes a paper chain all the way around a rectangular class banner that is 6 feet long and 2 feet wide. How many feet of paper chain does Ava need?

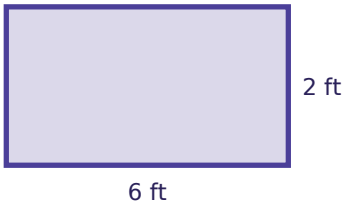

Task card 9 100th Day of School Math

Noah eats $\frac{5}{10}$ of a party pizza. Leo eats $\frac{2}{10}$ of it. What fraction of the party pizza did they eat together?

Task card 10 100th Day of School Math

There are 47 cookies. Each snack bag holds 5. How many snack bags can be filled all the way?

Task card 11 100th Day of School Math

Ava eats $\frac{2}{9}$ of a party pizza. Mia eats $\frac{6}{9}$ of it. What fraction of the party pizza did they eat together?

Task card 12 100th Day of School Math

There are 90 cupcakes. Each snack bag holds 8. How many snack bags can be filled all the way?

Task card 13 100th Day of School Math

Each snack bag holds 5 pretzels. The bakery fills 17 snack bags. How many pretzels is that?

Task card 14 100th Day of School Math

Noah tapes a paper chain all the way around a rectangular class banner that is 10 feet long and 8 feet wide. How many feet of paper chain does Noah need?

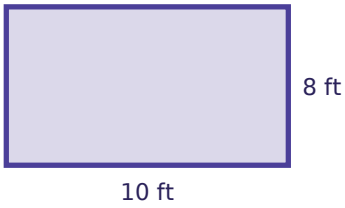

Task card 15 100th Day of School Math

Noah tapes a paper chain all the way around a rectangular class banner that is 7 feet long and 5 feet wide. How many feet of paper chain does Noah need?

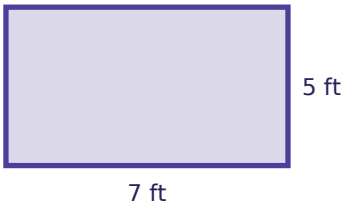

Task card 16 100th Day of School Math

Each snack bag holds 4 pretzels. The bakery fills 22 snack bags. How many pretzels is that?

Task card 17 100th Day of School Math

Each snack bag holds 22 pretzels. The bakery fills 56 snack bags. How many pretzels is that?

Task card 18 100th Day of School Math

There are 111 cupcakes. Each snack bag holds 6. How many snack bags can be filled all the way?

Task card 19 100th Day of School Math

Each snack bag holds 25 pretzels. The bakery fills 12 snack bags. How many pretzels is that?

Task card 20 100th Day of School Math

Noah eats $\frac{2}{12}$ of a party pizza. Leo eats $\frac{9}{12}$ of it. What fraction of the party pizza did they eat together?

Task card 21 100th Day of School Math

Noah tapes a paper chain all the way around a rectangular class banner that is 6 feet long and 4 feet wide. How many feet of paper chain does Noah need?

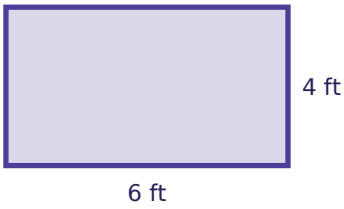

Task card 22 100th Day of School Math

Mia eats $\frac{4}{10}$ of a party pizza. Lily eats $\frac{5}{10}$ of it. What fraction of the party pizza did they eat together?

Task card 23 100th Day of School Math

Omar tapes a paper chain all the way around a rectangular class banner that is 4 feet long and 2 feet wide. How many feet of paper chain does Omar need?

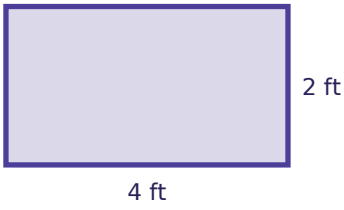

Task card 24 100th Day of School Math

There are 128 pretzels. Each snack bag holds 9. After filling as many snack bags as possible, how many pretzels are left over?

100th Day of School Math Task Cards

Recording sheet · Grade 4 · Read each story and solve.

Name: _____ Date: _____

Scan to check your answers

1	2	3	4
5	6	7	8
9	10	11	12
13	14	15	16
17	18	19	20
21	22	23	24

100th Day of School Math Task Cards: Answer Key

Grade 4 · Medium

The answers online

1. 30	**2.** $\frac{7}{10}$	**3.** 168
4. 150	**5.** 1	**6.** 2
7. $\frac{9}{10}$	**8.** 16	**9.** $\frac{7}{10}$
10. 9	**11.** $\frac{8}{9}$	**12.** 11
13. 85	**14.** 36	**15.** 24
16. 88	**17.** 1232	**18.** 18
19. 300	**20.** $\frac{11}{12}$	**21.** 20
22. $\frac{9}{10}$	**23.** 12	**24.** 2