100th Day of School Math · 1

Sam tapes a paper chain all the way around a rectangular class banner that is 11 feet long and 10 feet wide. How many feet of paper chain does Sam need?

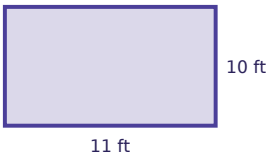

100th Day of School Math · 2

Each snack bag holds 21 pretzels. The bakery fills 13 snack bags. How many pretzels is that?

100th Day of School Math · 3

Mia tapes a paper chain all the way around a rectangular class banner that is 11 feet long and 4 feet wide. How many feet of paper chain does Mia need?

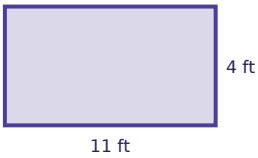

100th Day of School Math · 4

Each snack bag holds 17 cookies. The bakery fills 49 snack bags. How many cookies is that?

100th Day of School Math · 5

There are 74 pretzels. Each snack bag holds 7. After filling as many snack bags as possible, how many pretzels are left over?

100th Day of School Math · 6

Ella eats $\frac{1}{9}$ of a party pizza. Ava eats $\frac{1}{9}$ of it. What fraction of the party pizza did they eat together?

100th Day of School Math · 7

Leo eats $\frac{4}{12}$ of a party pizza. Lily eats $\frac{1}{12}$ of it. What fraction of the party pizza did they eat together?

100th Day of School Math · 8

There are 59 cookies. Each snack bag holds 3. After filling as many snack bags as possible, how many cookies are left over?

100th Day of School Math · 2

ANSWER

273

100th Day of School Math · 1

ANSWER

42

100th Day of School Math · 4

ANSWER

833

100th Day of School Math · 3

ANSWER

30

100th Day of School Math · 6

ANSWER

$$\frac{2}{9}$$

100th Day of School Math · 5

ANSWER

4

100th Day of School Math · 8

ANSWER

2

100th Day of School Math · 7

ANSWER

$$\frac{5}{12}$$

100th Day of School Math · 9

There are 29 cookies. Each snack bag holds 3. After filling as many snack bags as possible, how many cookies are left over?

100th Day of School Math · 10

Each snack bag holds 16 cookies. The bakery fills 57 snack bags. How many cookies is that?

100th Day of School Math · 11

Mia eats $\frac{1}{12}$ of a party pizza. Omar eats $\frac{10}{12}$ of it. What fraction of the party pizza did they eat together?

100th Day of School Math · 12

Each snack bag holds 11 cookies. The bakery fills 64 snack bags. How many cookies is that?

100th Day of School Math · 13

Omar tapes a paper chain all the way around a rectangular class banner that is 5 feet long and 3 feet wide. How many feet of paper chain does Omar need?



100th Day of School Math · 14

Zoe eats $\frac{1}{8}$ of a party pizza. Mia eats $\frac{2}{8}$ of it. What fraction of the party pizza did they eat together?

100th Day of School Math · 15

Ben tapes a paper chain all the way around a rectangular class banner that is 11 feet long and 5 feet wide. How many feet of paper chain does Ben need?



100th Day of School Math · 16

There are 37 cookies. Each snack bag holds 9. How many snack bags can be filled all the way?

100th Day of School Math · 10

ANSWER

912

100th Day of School Math · 9

ANSWER

2

100th Day of School Math · 12

ANSWER

704

100th Day of School Math · 11

ANSWER

$$\frac{11}{12}$$

100th Day of School Math · 14

ANSWER

$$\frac{3}{8}$$

100th Day of School Math · 13

ANSWER

16

100th Day of School Math · 16

ANSWER

4

100th Day of School Math · 15

ANSWER

32

100th Day of School Math · 17

Each snack bag holds 24 cookies. The bakery fills 14 snack bags. How many cookies is that?

100th Day of School Math · 18

Ben eats $\frac{2}{8}$ of a party pizza. Omar eats $\frac{1}{8}$ of it. What fraction of the party pizza did they eat together?

100th Day of School Math · 19

Leo tapes a paper chain all the way around a rectangular class banner that is 5 feet long and 4 feet wide. How many feet of paper chain does Leo need?

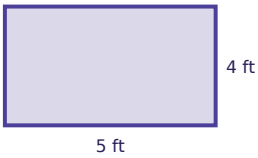

100th Day of School Math · 20

Ben eats $\frac{2}{9}$ of a party pizza. Noah eats $\frac{2}{9}$ of it. What fraction of the party pizza did they eat together?

100th Day of School Math · 21

Each snack bag holds 20 cupcakes. The bakery fills 27 snack bags. How many cupcakes is that?

100th Day of School Math · 22

There are 55 cookies. Each snack bag holds 9. How many snack bags can be filled all the way?

100th Day of School Math · 23

Mia tapes a paper chain all the way around a rectangular class banner that is 5 feet long and 4 feet wide. How many feet of paper chain does Mia need?

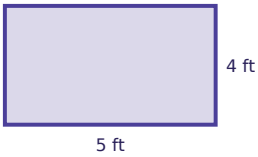

100th Day of School Math · 24

There are 114 pretzels. Each snack bag holds 8. How many snack bags can be filled all the way?

100th Day of School Math · 18

ANSWER

$\frac{3}{8}$

100th Day of School Math · 17

ANSWER

336

100th Day of School Math · 20

ANSWER

$\frac{4}{9}$

100th Day of School Math · 19

ANSWER

18

100th Day of School Math · 22

ANSWER

6

100th Day of School Math · 21

ANSWER

540

100th Day of School Math · 24

ANSWER

14

100th Day of School Math · 23

ANSWER

18