100th Day of School Math · 1

Noah tapes a paper chain all the way around a rectangular class banner that is 9 feet long and 6 feet wide. How many feet of paper chain does Noah need?

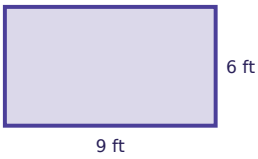

100th Day of School Math · 2

Ben eats $\frac{3}{10}$ of a party pizza. Zoe eats $\frac{4}{10}$ of it. What fraction of the party pizza did they eat together?

100th Day of School Math · 3

Each snack bag holds 8 cupcakes. The bakery fills 21 snack bags. How many cupcakes is that?

100th Day of School Math · 4

Each snack bag holds 6 pretzels. The bakery fills 25 snack bags. How many pretzels is that?

100th Day of School Math · 5

There are 37 pretzels. Each snack bag holds 6. After filling as many snack bags as possible, how many pretzels are left over?

100th Day of School Math · 6

There are 35 pretzels. Each snack bag holds 3. After filling as many snack bags as possible, how many pretzels are left over?

100th Day of School Math · 7

Omar eats $\frac{7}{10}$ of a party pizza. Zoe eats $\frac{2}{10}$ of it. What fraction of the party pizza did they eat together?

100th Day of School Math · 8

Ava tapes a paper chain all the way around a rectangular class banner that is 6 feet long and 2 feet wide. How many feet of paper chain does Ava need?

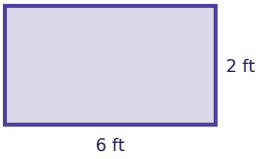

100th Day of School Math · 2

ANSWER

$\frac{7}{10}$

100th Day of School Math · 1

ANSWER

30

100th Day of School Math · 4

ANSWER

150

100th Day of School Math · 3

ANSWER

168

100th Day of School Math · 6

ANSWER

2

100th Day of School Math · 5

ANSWER

1

100th Day of School Math · 8

ANSWER

16

100th Day of School Math · 7

ANSWER

$\frac{9}{10}$

100th Day of School Math · 9

Noah eats $\frac{5}{10}$ of a party pizza. Leo eats $\frac{2}{10}$ of it. What fraction of the party pizza did they eat together?

100th Day of School Math · 10

There are 47 cookies. Each snack bag holds 5. How many snack bags can be filled all the way?

100th Day of School Math · 11

Ava eats $\frac{2}{9}$ of a party pizza. Mia eats $\frac{6}{9}$ of it. What fraction of the party pizza did they eat together?

100th Day of School Math · 12

There are 90 cupcakes. Each snack bag holds 8. How many snack bags can be filled all the way?

100th Day of School Math · 13

Each snack bag holds 5 pretzels. The bakery fills 17 snack bags. How many pretzels is that?

100th Day of School Math · 14

Noah tapes a paper chain all the way around a rectangular class banner that is 10 feet long and 8 feet wide. How many feet of paper chain does Noah need?

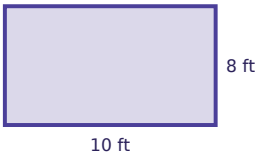

100th Day of School Math · 15

Noah tapes a paper chain all the way around a rectangular class banner that is 7 feet long and 5 feet wide. How many feet of paper chain does Noah need?

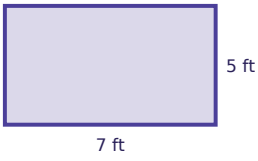

100th Day of School Math · 16

Each snack bag holds 4 pretzels. The bakery fills 22 snack bags. How many pretzels is that?

100th Day of School Math · 10

ANSWER

9

100th Day of School Math · 9

ANSWER

$$\frac{7}{10}$$

100th Day of School Math · 12

ANSWER

11

100th Day of School Math · 11

ANSWER

$$\frac{8}{9}$$

100th Day of School Math · 14

ANSWER

36

100th Day of School Math · 13

ANSWER

85

100th Day of School Math · 16

ANSWER

88

100th Day of School Math · 15

ANSWER

24

100th Day of School Math · 17

Each snack bag holds 22 pretzels. The bakery fills 56 snack bags. How many pretzels is that?

100th Day of School Math · 18

There are 111 cupcakes. Each snack bag holds 6. How many snack bags can be filled all the way?

100th Day of School Math · 19

Each snack bag holds 25 pretzels. The bakery fills 12 snack bags. How many pretzels is that?

100th Day of School Math · 20

Noah eats $\frac{2}{12}$ of a party pizza. Leo eats $\frac{9}{12}$ of it. What fraction of the party pizza did they eat together?

100th Day of School Math · 21

Noah tapes a paper chain all the way around a rectangular class banner that is 6 feet long and 4 feet wide. How many feet of paper chain does Noah need?

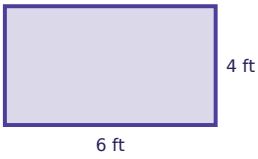

100th Day of School Math · 22

Mia eats $\frac{4}{10}$ of a party pizza. Lily eats $\frac{5}{10}$ of it. What fraction of the party pizza did they eat together?

100th Day of School Math · 23

Omar tapes a paper chain all the way around a rectangular class banner that is 4 feet long and 2 feet wide. How many feet of paper chain does Omar need?



100th Day of School Math · 24

There are 128 pretzels. Each snack bag holds 9. After filling as many snack bags as possible, how many pretzels are left over?

100th Day of School Math · 18

ANSWER

18

100th Day of School Math · 17

ANSWER

1232

100th Day of School Math · 20

ANSWER

$$\frac{11}{12}$$

100th Day of School Math · 19

ANSWER

300

100th Day of School Math · 22

ANSWER

$$\frac{9}{10}$$

100th Day of School Math · 21

ANSWER

20

100th Day of School Math · 24

ANSWER

2

100th Day of School Math · 23

ANSWER

12