100th Day of School Math · 1

Each snack bag holds 5 pretzels. The bakery fills 18 snack bags. How many pretzels is that?

100th Day of School Math · 2

Leo eats $\frac{2}{7}$ of a party pizza. Omar eats $\frac{2}{7}$ of it. What fraction of the party pizza did they eat together?

100th Day of School Math · 3

Each snack bag holds 5 pretzels. The bakery fills 30 snack bags. How many pretzels is that?

100th Day of School Math · 4

There are 52 cupcakes. Each snack bag holds 6. How many snack bags can be filled all the way?

100th Day of School Math · 5

Noah tapes a paper chain all the way around a rectangular class banner that is 4 feet long and 2 feet wide. How many feet of paper chain does Noah need?

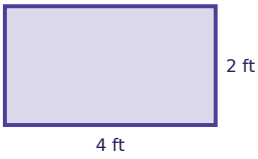

100th Day of School Math · 6

There are 45 cookies. Each snack bag holds 8. After filling as many snack bags as possible, how many cookies are left over?

100th Day of School Math · 7

Ella tapes a paper chain all the way around a rectangular class banner that is 7 feet long and 2 feet wide. How many feet of paper chain does Ella need?

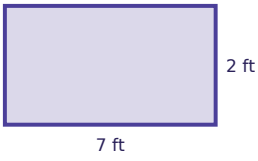

100th Day of School Math · 8

Leo eats $\frac{3}{5}$ of a party pizza. Omar eats $\frac{1}{5}$ of it. What fraction of the party pizza did they eat together?

100th Day of School Math · 2

ANSWER

$\frac{4}{7}$

100th Day of School Math · 1

ANSWER

90

100th Day of School Math · 4

ANSWER

8

100th Day of School Math · 3

ANSWER

150

100th Day of School Math · 6

ANSWER

5

100th Day of School Math · 5

ANSWER

12

100th Day of School Math · 8

ANSWER

$\frac{4}{5}$

100th Day of School Math · 7

ANSWER

18

100th Day of School Math · 9

Zoe eats $\frac{2}{5}$ of a party pizza. Omar eats $\frac{2}{5}$ of it. What fraction of the party pizza did they eat together?

100th Day of School Math · 10

Sam eats $\frac{1}{8}$ of a party pizza. Mia eats $\frac{2}{8}$ of it. What fraction of the party pizza did they eat together?

100th Day of School Math · 11

Each snack bag holds 9 cookies. The bakery fills 33 snack bags. How many cookies is that?

100th Day of School Math · 12

Ben tapes a paper chain all the way around a rectangular class banner that is 6 feet long and 5 feet wide. How many feet of paper chain does Ben need?

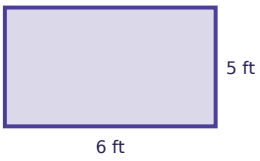

100th Day of School Math · 13

There are 26 cookies. Each snack bag holds 5. How many snack bags can be filled all the way?

100th Day of School Math · 14

Each snack bag holds 5 cookies. The bakery fills 36 snack bags. How many cookies is that?

100th Day of School Math · 15

There are 57 pretzels. Each snack bag holds 6. How many snack bags can be filled all the way?

100th Day of School Math · 16

Omar tapes a paper chain all the way around a rectangular class banner that is 5 feet long and 3 feet wide. How many feet of paper chain does Omar need?

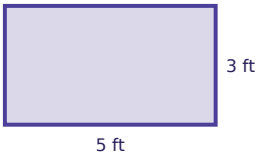

100th Day of School Math · 10

ANSWER

$\frac{3}{8}$

100th Day of School Math · 9

ANSWER

$\frac{4}{5}$

100th Day of School Math · 12

ANSWER

22

100th Day of School Math · 11

ANSWER

297

100th Day of School Math · 14

ANSWER

180

100th Day of School Math · 13

ANSWER

5

100th Day of School Math · 16

ANSWER

16

100th Day of School Math · 15

ANSWER

9

100th Day of School Math · 17

Mia eats $\frac{2}{5}$ of a party pizza. Lily eats $\frac{1}{5}$ of it. What fraction of the party pizza did they eat together?

100th Day of School Math · 18

There are 110 cupcakes. Each snack bag holds 9. After filling as many snack bags as possible, how many cupcakes are left over?

100th Day of School Math · 19

Sam tapes a paper chain all the way around a rectangular class banner that is 6 feet long and 3 feet wide. How many feet of paper chain does Sam need?

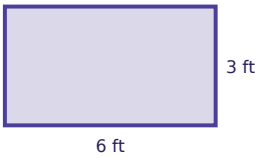

100th Day of School Math · 20

Each snack bag holds 3 cookies. The bakery fills 21 snack bags. How many cookies is that?

100th Day of School Math · 21

Zoe eats $\frac{1}{5}$ of a party pizza. Lily eats $\frac{3}{5}$ of it. What fraction of the party pizza did they eat together?

100th Day of School Math · 22

Each snack bag holds 5 pretzels. The bakery fills 13 snack bags. How many pretzels is that?

100th Day of School Math · 23

There are 70 pretzels. Each snack bag holds 9. After filling as many snack bags as possible, how many pretzels are left over?

100th Day of School Math · 24

Ben eats $\frac{1}{5}$ of a party pizza. Ava eats $\frac{1}{5}$ of it. What fraction of the party pizza did they eat together?

100th Day of School Math · 18

ANSWER

2

100th Day of School Math · 17

ANSWER

$\frac{3}{5}$

100th Day of School Math · 20

ANSWER

63

100th Day of School Math · 19

ANSWER

18

100th Day of School Math · 22

ANSWER

65

100th Day of School Math · 21

ANSWER

$\frac{4}{5}$

100th Day of School Math · 24

ANSWER

$\frac{2}{5}$

100th Day of School Math · 23

ANSWER

7