Task card 1 Winter Math

A chocolate cake is cut into 12 equal slices. The family eats 5 slices. What fraction of the chocolate cake did they eat?

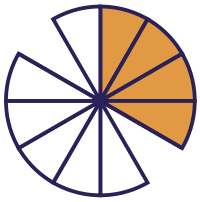

Task card 2 Winter Math

Lily shares 28 cinnamon rolls equally among 4 friends. How many cinnamon rolls does each friend get?

Task card 3 Winter Math

The family goes sledding at 10:30. They sled for 3 hours. What time do they stop?



Task card 4 Winter Math

A chocolate cake is cut into 8 equal slices. The family eats 1 slice. What fraction of the chocolate cake did they eat?

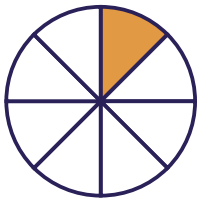

Task card 5 Winter Math

At the winter carnival there are 4 tables. 9 people sit at each table. How many people are there?

Task card 6 Winter Math

The family goes sledding at 1:00. They sled for 4 hours. What time do they stop?



Task card 7 Winter Math

At the winter carnival there are 3 tables. 4 people sit at each table. How many people are there?

Task card 8 Winter Math

Ben shares 50 cinnamon rolls equally among 5 friends. How many cinnamon rolls does each friend get?

Task card 9 Winter Math

Ava shares 30 cinnamon rolls equally among 3 friends. How many cinnamon rolls does each friend get?

Task card 10 Winter Math

Omar shares 64 cocoa muffins equally among 8 friends. How many cocoa muffins does each friend get?

Task card 11 Winter Math

At the winter carnival there are 7 tables. 4 people sit at each table. How many people are there?

Task card 12 Winter Math

A chocolate cake is cut into 10 equal slices. The family eats 3 slices. What fraction of the chocolate cake did they eat?

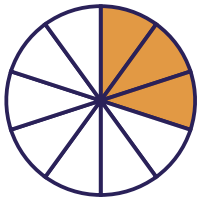

Task card 13 Winter Math

The family goes sledding at 11:30. They sled for 5 hours. What time do they stop?



Task card 14 Winter Math

A chocolate cake is cut into 12 equal slices. The family eats 1 slice. What fraction of the chocolate cake did they eat?



Task card 15 Winter Math

At the winter carnival there are 4 tables. 8 people sit at each table. How many people are there?

Task card 16 Winter Math

The family goes sledding at 12:30. They sled for 4 hours. What time do they stop?



Task card 17 Winter Math

Ella shares 6 cocoa muffins equally among 3 friends. How many cocoa muffins does each friend get?

Task card 18 Winter Math

The family goes sledding at 9:30. They sled for 2 hours. What time do they stop?



Task card 19 Winter Math

At the winter carnival there are 6 tables. 10 people sit at each table. How many people are there?

Task card 20 Winter Math

Ava shares 12 snowball cookies equally among 6 friends. How many snowball cookies does each friend get?

Task card 21 Winter Math

At the winter carnival there are 6 tables. 7 people sit at each table. How many people are there?

Task card 22 Winter Math

A chocolate cake is cut into 12 equal slices. The family eats 7 slices. What fraction of the chocolate cake did they eat?

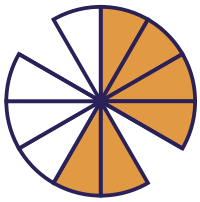

Task card 23 Winter Math

The family goes sledding at 11:00. They sled for 3 hours. What time do they stop?



Task card 24 Winter Math

At the winter carnival there are 5 tables. 8 people sit at each table. How many people are there?

Winter Math Task Cards

Recording sheet · Grade 3 · Read each story and solve. Write times like 3:00 and fractions like 3/8.

Name: _____ Date: _____

Scan to check your answers

1	2	3	4
5	6	7	8
9	10	11	12
13	14	15	16
17	18	19	20
21	22	23	24

Winter Math Task Cards: Answer Key

Grade 3 · Hard

The answers online

1. $\frac{5}{12}$	**2.** 7	**3.** 1:30
4. $\frac{1}{8}$	**5.** 36	**6.** 5:00
7. 12	**8.** 10	**9.** 10
10. 8	**11.** 28	**12.** $\frac{3}{10}$
13. 4:30	**14.** $\frac{1}{12}$	**15.** 32
16. 4:30	**17.** 2	**18.** 11:30
19. 60	**20.** 2	**21.** 42
22. $\frac{7}{12}$	**23.** 2:00	**24.** 40