Task card 1 Winter Math

Ava shares 35 cocoa muffins equally among 7 friends. How many cocoa muffins does each friend get?

Task card 2 Winter Math

Ben shares 10 cinnamon rolls equally among 5 friends. How many cinnamon rolls does each friend get?

Task card 3 Winter Math

At the winter carnival there are 7 tables. 3 people sit at each table. How many people are there?

Task card 4 Winter Math

A chocolate cake is cut into 8 equal slices. The family eats 5 slices. What fraction of the chocolate cake did they eat?

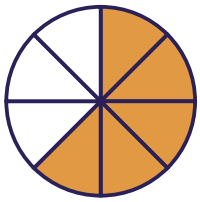

Task card 5 Winter Math

The family goes sledding at 11:00. They sled for 3 hours. What time do they stop?



Task card 6 Winter Math

The family goes sledding at 11:00. They sled for 5 hours. What time do they stop?



Task card 7 Winter Math

A chocolate cake is cut into 6 equal slices. The family eats 1 slice. What fraction of the chocolate cake did they eat?

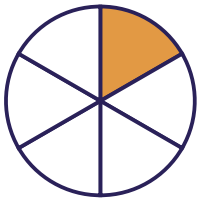

Task card 8 Winter Math

At the winter carnival there are 2 tables. 2 people sit at each table. How many people are there?

Task card 9 Winter Math

At the winter carnival there are 3 tables. 6 people sit at each table. How many people are there?

Task card 10 Winter Math

Mia shares 45 cocoa muffins equally among 9 friends. How many cocoa muffins does each friend get?

Task card 11 Winter Math

The family goes sledding at 12:00. They sled for 4 hours. What time do they stop?



Task card 12 Winter Math

A chocolate cake is cut into 6 equal slices. The family eats 5 slices. What fraction of the chocolate cake did they eat?

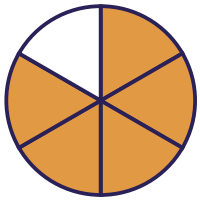

Task card 13 Winter Math

The family goes sledding at 10:00. They sled for 2 hours. What time do they stop?



Task card 14 Winter Math

At the winter carnival there are 3 tables. 2 people sit at each table. How many people are there?

Task card 15 Winter Math

Leo shares 45 cocoa muffins equally among 9 friends. How many cocoa muffins does each friend get?

Task card 16 Winter Math

A chocolate cake is cut into 4 equal slices. The family eats 1 slice. What fraction of the chocolate cake did they eat?



Task card 17 Winter Math

At the winter carnival there are 8 tables. 4 people sit at each table. How many people are there?

Task card 18 Winter Math

At the winter carnival there are 6 tables. 6 people sit at each table. How many people are there?

Task card 19 Winter Math

The family goes sledding at 12:00. They sled for 3 hours. What time do they stop?



Task card 20 Winter Math

The family goes sledding at 12:00. They sled for 5 hours. What time do they stop?



Task card 21 Winter Math

Lily shares 32 cinnamon rolls equally among 8 friends. How many cinnamon rolls does each friend get?

Task card 22 Winter Math

Zoe shares 6 cocoa muffins equally among 2 friends. How many cocoa muffins does each friend get?

Task card 23 Winter Math

A chocolate cake is cut into 4 equal slices. The family eats 3 slices. What fraction of the chocolate cake did they eat?



Task card 24 Winter Math

At the winter carnival there are 6 tables. 3 people sit at each table. How many people are there?

Winter Math Task Cards

Recording sheet · Grade 3 · Read each story and solve. Write times like 3:00 and fractions like 3/8.

Name: _____ Date: _____

Scan to check your answers

1	2	3	4
5	6	7	8
9	10	11	12
13	14	15	16
17	18	19	20
21	22	23	24

Winter Math Task Cards: Answer Key

Grade 3 · Easy

The answers online

1. 5	**2.** 2	**3.** 21
4. $\frac{5}{8}$	**5.** 2:00	**6.** 4:00
7. $\frac{1}{6}$	**8.** 4	**9.** 18
10. 5	**11.** 4:00	**12.** $\frac{5}{6}$
13. 12:00	**14.** 6	**15.** 5
16. $\frac{1}{4}$	**17.** 32	**18.** 36
19. 3:00	**20.** 5:00	**21.** 4
22. 3	**23.** $\frac{3}{4}$	**24.** 18