Winter Math · 1

The family goes sledding at 9:00. They sled for 2 hours. What time do they stop?



Winter Math · 2

Sam shares 12 snowball cookies equally among 6 friends. How many snowball cookies does each friend get?

Winter Math · 3

A chocolate cake is cut into 6 equal slices. The family eats 1 slice. What fraction of the chocolate cake did they eat?

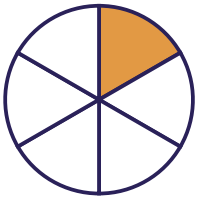

Winter Math · 4

At the winter carnival there are 5 tables. 8 people sit at each table. How many people are there?

Winter Math · 5

The family goes sledding at 12:00. They sled for 4 hours. What time do they stop?



Winter Math · 6

Noah shares 14 cinnamon rolls equally among 7 friends. How many cinnamon rolls does each friend get?

Winter Math · 7

A chocolate cake is cut into 12 equal slices. The family eats 11 slices. What fraction of the chocolate cake did they eat?

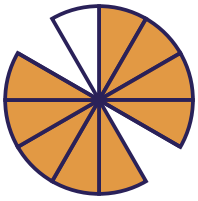

Winter Math · 8

At the winter carnival there are 2 tables. 3 people sit at each table. How many people are there?

Winter Math · 2

ANSWER

2

Winter Math · 1

ANSWER

11:00

Winter Math · 4

ANSWER

40

Winter Math · 3

ANSWER

$$\frac{1}{6}$$

Winter Math · 6

ANSWER

2

Winter Math · 5

ANSWER

4:00

Winter Math · 8

ANSWER

6

Winter Math · 7

ANSWER

$$\frac{11}{12}$$

Winter Math · 9

Ben shares 24 cocoa muffins equally among 8 friends. How many cocoa muffins does each friend get?

Winter Math · 10

At the winter carnival there are 5 tables. 6 people sit at each table. How many people are there?

Winter Math · 11

The family goes sledding at 10:00. They sled for 5 hours. What time do they stop?



Winter Math · 12

A chocolate cake is cut into 8 equal slices. The family eats 3 slices. What fraction of the chocolate cake did they eat?

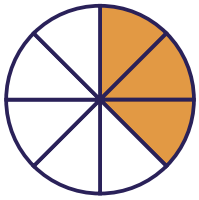

Winter Math · 13

Zoe shares 10 cocoa muffins equally among 2 friends. How many cocoa muffins does each friend get?

Winter Math · 14

At the winter carnival there are 7 tables. 6 people sit at each table. How many people are there?

Winter Math · 15

The family goes sledding at 11:00. They sled for 2 hours. What time do they stop?



Winter Math · 16

At the winter carnival there are 7 tables. 2 people sit at each table. How many people are there?

Winter Math · 10

ANSWER

30

Winter Math · 9

ANSWER

3

Winter Math · 12

ANSWER

$$\frac{3}{8}$$

Winter Math · 11

ANSWER

3:00

Winter Math · 14

ANSWER

42

Winter Math · 13

ANSWER

5

Winter Math · 16

ANSWER

14

Winter Math · 15

ANSWER

1:00

Winter Math · 17

At the winter carnival there are 6 tables. 7 people sit at each table. How many people are there?

Winter Math · 18

The family goes sledding at 11:00. They sled for 3 hours. What time do they stop?



Winter Math · 19

Omar shares 36 cinnamon rolls equally among 9 friends. How many cinnamon rolls does each friend get?

Winter Math · 20

The family goes sledding at 11:30. They sled for 4 hours. What time do they stop?



Winter Math · 21

A chocolate cake is cut into 8 equal slices. The family eats 5 slices. What fraction of the chocolate cake did they eat?

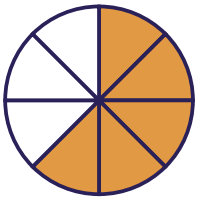

Winter Math · 22

Mia shares 18 cocoa muffins equally among 3 friends. How many cocoa muffins does each friend get?

Winter Math · 23

Omar shares 12 cinnamon rolls equally among 4 friends. How many cinnamon rolls does each friend get?

Winter Math · 24

A chocolate cake is cut into 10 equal slices. The family eats 1 slice. What fraction of the chocolate cake did they eat?

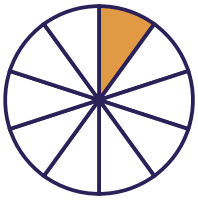

Winter Math · 18

ANSWER

2:00

Winter Math · 17

ANSWER

42

Winter Math · 20

ANSWER

3:30

Winter Math · 19

ANSWER

4

Winter Math · 22

ANSWER

6

Winter Math · 21

ANSWER

$$\frac{5}{8}$$

Winter Math · 24

ANSWER

$$\frac{1}{10}$$

Winter Math · 23

ANSWER

3