Winter Math · 1

A chocolate cake is cut into 12 equal slices. The family eats 5 slices. What fraction of the chocolate cake did they eat?

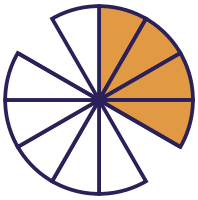

Winter Math · 2

Lily shares 28 cinnamon rolls equally among 4 friends. How many cinnamon rolls does each friend get?

Winter Math · 3

The family goes sledding at 10:30. They sled for 3 hours. What time do they stop?



Winter Math · 4

A chocolate cake is cut into 8 equal slices. The family eats 1 slice. What fraction of the chocolate cake did they eat?

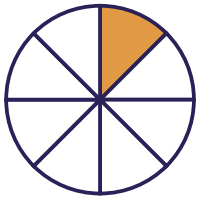

Winter Math · 5

At the winter carnival there are 4 tables. 9 people sit at each table. How many people are there?

Winter Math · 6

The family goes sledding at 1:00. They sled for 4 hours. What time do they stop?



Winter Math · 7

At the winter carnival there are 3 tables. 4 people sit at each table. How many people are there?

Winter Math · 8

Ben shares 50 cinnamon rolls equally among 5 friends. How many cinnamon rolls does each friend get?

Winter Math · 2

ANSWER

7

Winter Math · 1

ANSWER

$$\frac{5}{12}$$

Winter Math · 4

ANSWER

$$\frac{1}{8}$$

Winter Math · 3

ANSWER

1:30

Winter Math · 6

ANSWER

5:00

Winter Math · 5

ANSWER

36

Winter Math · 8

ANSWER

10

Winter Math · 7

ANSWER

12

Winter Math · 9

Ava shares 30 cinnamon rolls equally among 3 friends. How many cinnamon rolls does each friend get?

Winter Math · 10

Omar shares 64 cocoa muffins equally among 8 friends. How many cocoa muffins does each friend get?

Winter Math · 11

At the winter carnival there are 7 tables. 4 people sit at each table. How many people are there?

Winter Math · 12

A chocolate cake is cut into 10 equal slices. The family eats 3 slices. What fraction of the chocolate cake did they eat?

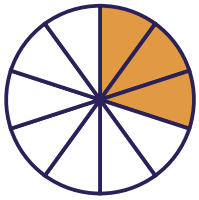

Winter Math · 13

The family goes sledding at 11:30. They sled for 5 hours. What time do they stop?



Winter Math · 14

A chocolate cake is cut into 12 equal slices. The family eats 1 slice. What fraction of the chocolate cake did they eat?



Winter Math · 15

At the winter carnival there are 4 tables. 8 people sit at each table. How many people are there?

Winter Math · 16

The family goes sledding at 12:30. They sled for 4 hours. What time do they stop?



Winter Math · 10

ANSWER

8

Winter Math · 9

ANSWER

10

Winter Math · 12

ANSWER

$$\frac{3}{10}$$

Winter Math · 11

ANSWER

28

Winter Math · 14

ANSWER

$$\frac{1}{12}$$

Winter Math · 13

ANSWER

4:30

Winter Math · 16

ANSWER

4:30

Winter Math · 15

ANSWER

32

Winter Math · 17

Ella shares 6 cocoa muffins equally among 3 friends. How many cocoa muffins does each friend get?

Winter Math · 18

The family goes sledding at 9:30. They sled for 2 hours. What time do they stop?



Winter Math · 19

At the winter carnival there are 6 tables. 10 people sit at each table. How many people are there?

Winter Math · 20

Ava shares 12 snowball cookies equally among 6 friends. How many snowball cookies does each friend get?

Winter Math · 21

At the winter carnival there are 6 tables. 7 people sit at each table. How many people are there?

Winter Math · 22

A chocolate cake is cut into 12 equal slices. The family eats 7 slices. What fraction of the chocolate cake did they eat?

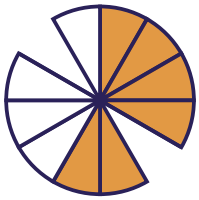

Winter Math · 23

The family goes sledding at 11:00. They sled for 3 hours. What time do they stop?



Winter Math · 24

At the winter carnival there are 5 tables. 8 people sit at each table. How many people are there?

Winter Math · 18

ANSWER

11:30

Winter Math · 17

ANSWER

2

Winter Math · 20

ANSWER

2

Winter Math · 19

ANSWER

60

Winter Math · 22

ANSWER

$$\frac{7}{12}$$

Winter Math · 21

ANSWER

42

Winter Math · 24

ANSWER

40

Winter Math · 23

ANSWER

2:00