Winter Math · 1

Ava shares 35 cocoa muffins equally among 7 friends. How many cocoa muffins does each friend get?

Winter Math · 2

Ben shares 10 cinnamon rolls equally among 5 friends. How many cinnamon rolls does each friend get?

Winter Math · 3

At the winter carnival there are 7 tables. 3 people sit at each table. How many people are there?

Winter Math · 4

A chocolate cake is cut into 8 equal slices. The family eats 5 slices. What fraction of the chocolate cake did they eat?

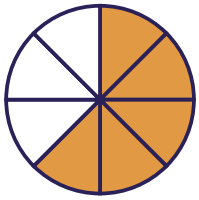

Winter Math · 5

The family goes sledding at 11:00. They sled for 3 hours. What time do they stop?



Winter Math · 6

The family goes sledding at 11:00. They sled for 5 hours. What time do they stop?



Winter Math · 7

A chocolate cake is cut into 6 equal slices. The family eats 1 slice. What fraction of the chocolate cake did they eat?

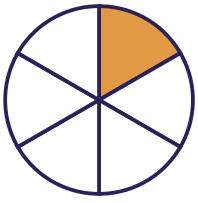

Winter Math · 8

At the winter carnival there are 2 tables. 2 people sit at each table. How many people are there?

Winter Math · 2

ANSWER

2

Winter Math · 1

ANSWER

5

Winter Math · 4

ANSWER

$$\frac{5}{8}$$

Winter Math · 3

ANSWER

21

Winter Math · 6

ANSWER

4:00

Winter Math · 5

ANSWER

2:00

Winter Math · 8

ANSWER

4

Winter Math · 7

ANSWER

$$\frac{1}{6}$$

Winter Math · 9

At the winter carnival there are 3 tables. 6 people sit at each table. How many people are there?

Winter Math · 10

Mia shares 45 cocoa muffins equally among 9 friends. How many cocoa muffins does each friend get?

Winter Math · 11

The family goes sledding at 12:00. They sled for 4 hours. What time do they stop?



Winter Math · 12

A chocolate cake is cut into 6 equal slices. The family eats 5 slices. What fraction of the chocolate cake did they eat?

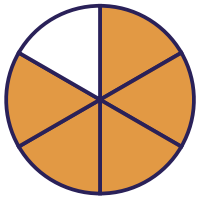

Winter Math · 13

The family goes sledding at 10:00. They sled for 2 hours. What time do they stop?



Winter Math · 14

At the winter carnival there are 3 tables. 2 people sit at each table. How many people are there?

Winter Math · 15

Leo shares 45 cocoa muffins equally among 9 friends. How many cocoa muffins does each friend get?

Winter Math · 16

A chocolate cake is cut into 4 equal slices. The family eats 1 slice. What fraction of the chocolate cake did they eat?



Winter Math · 10

ANSWER

5

Winter Math · 9

ANSWER

18

Winter Math · 12

ANSWER

$\frac{5}{6}$

Winter Math · 11

ANSWER

4:00

Winter Math · 14

ANSWER

6

Winter Math · 13

ANSWER

12:00

Winter Math · 16

ANSWER

$\frac{1}{4}$

Winter Math · 15

ANSWER

5

Winter Math · 17

At the winter carnival there are 8 tables. 4 people sit at each table. How many people are there?

Winter Math · 18

At the winter carnival there are 6 tables. 6 people sit at each table. How many people are there?

Winter Math · 19

The family goes sledding at 12:00. They sled for 3 hours. What time do they stop?



Winter Math · 20

The family goes sledding at 12:00. They sled for 5 hours. What time do they stop?



Winter Math · 21

Lily shares 32 cinnamon rolls equally among 8 friends. How many cinnamon rolls does each friend get?

Winter Math · 22

Zoe shares 6 cocoa muffins equally among 2 friends. How many cocoa muffins does each friend get?

Winter Math · 23

A chocolate cake is cut into 4 equal slices. The family eats 3 slices. What fraction of the chocolate cake did they eat?



Winter Math · 24

At the winter carnival there are 6 tables. 3 people sit at each table. How many people are there?

Winter Math · 18

ANSWER

36

Winter Math · 17

ANSWER

32

Winter Math · 20

ANSWER

5:00

Winter Math · 19

ANSWER

3:00

Winter Math · 22

ANSWER

3

Winter Math · 21

ANSWER

4

Winter Math · 24

ANSWER

18

Winter Math · 23

ANSWER

$$\frac{3}{4}$$