Task card 1 Whole Numbers as Fractions

$$\frac{8}{2} = ___$$

Task card 2 Whole Numbers as Fractions

$$3 = \frac{\quad}{3}$$

Task card 3 Whole Numbers as Fractions

$$5 = \frac{15}{___}$$

Task card 4 Whole Numbers as Fractions

Each circle is one whole cut into 3 equal parts. All the parts are shaded. Write the shaded amount as a fraction: $\frac{\quad}{3}$

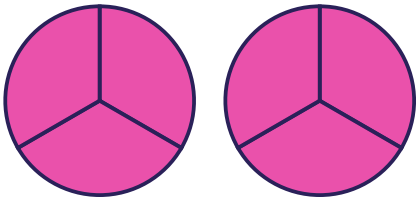

Task card 5 Whole Numbers as Fractions

Compare: $\frac{6}{2}$ ___ 3. Write >, <, or =.

Task card 6 Whole Numbers as Fractions

$$2 = \frac{\quad}{1}$$

Task card 7 Whole Numbers as Fractions

$$1 = \frac{\quad}{3}$$

Task card 8 Whole Numbers as Fractions

Compare: $\frac{8}{4}$ ___ 1. Write >, <, or =.

Task card 9 Whole Numbers as Fractions

$$\frac{12}{4} = ___$$

Task card 10 Whole Numbers as Fractions

$$5 = \frac{\quad}{4}$$

Task card 11 Whole Numbers as Fractions

$$5 = \frac{40}{___}$$

Task card 12 Whole Numbers as Fractions

Each circle is one whole cut into 8 equal parts. All the parts are shaded. Write the shaded amount as a fraction: $\frac{\quad}{8}$

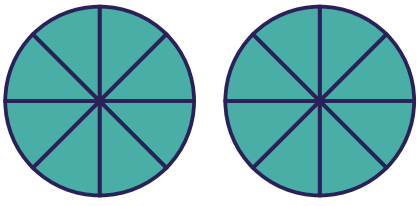

Task card 13 Whole Numbers as Fractions

Compare: $\frac{6}{6}$ ___ 2. Write >, <, or =.

Task card 14 Whole Numbers as Fractions

$18 = \frac{\quad}{1}$

Task card 15 Whole Numbers as Fractions

$2 = \frac{\quad}{4}$

Task card 16 Whole Numbers as Fractions

Compare: $\frac{2}{2}$ ___ 1. Write >, <, or =.

Task card 17 Whole Numbers as Fractions

$\frac{8}{8} = ___$

Task card 18 Whole Numbers as Fractions

$1 = \frac{\quad}{2}$

Task card 19 Whole Numbers as Fractions

$$4 = \frac{32}{\quad}$$

Task card 20 Whole Numbers as Fractions

Each circle is one whole cut into 8 equal parts. All the parts are shaded. Write the shaded amount as a fraction: $\frac{\quad}{8}$



Task card 21 Whole Numbers as Fractions

Compare: $\frac{8}{8}$ ___ 2. Write >, <, or =.

Task card 22 Whole Numbers as Fractions

$$\frac{17}{1} = \frac{\quad}{\quad}$$

Task card 23 Whole Numbers as Fractions

$$2 = \frac{\quad}{8}$$

Task card 24 Whole Numbers as Fractions

$$3 = \frac{12}{\quad}$$

Whole Numbers as Fractions Task Cards

Recording sheet · Grade 3 · Find the missing number.

Name: _____ Date: _____

Scan to check your answers

1	2	3	4
5	6	7	8
9	10	11	12
13	14	15	16
17	18	19	20
21	22	23	24

Whole Numbers as Fractions Task Cards: Answer Key

Grade 3 · Hard

The answers online

1. 4	**2.** 9	**3.** 3
4. 6	**5.** =	**6.** 2
7. 3	**8.** >	**9.** 3
10. 20	**11.** 8	**12.** 16
13. <	**14.** 18	**15.** 8
16. =	**17.** 1	**18.** 2
19. 8	**20.** 24	**21.** <
22. 17	**23.** 16	**24.** 4