Task card 1 Whole Numbers as Fractions

$\frac{8}{4} = ___$

Task card 2 Whole Numbers as Fractions

$1 = \frac{__}{4}$

Task card 3 Whole Numbers as Fractions

$2 = \frac{12}{__}$

Task card 4 Whole Numbers as Fractions

Each circle is one whole cut into 3 equal parts. All the parts are shaded. Write the shaded amount as a fraction: $\frac{__}{3}$



Task card 5 Whole Numbers as Fractions

Compare: $\frac{2}{2}$ ___ 1. Write >, <, or =.

Task card 6 Whole Numbers as Fractions

$8 = \frac{__}{1}$

Task card 7 Whole Numbers as Fractions

$1 = \frac{\quad}{2}$

Task card 8 Whole Numbers as Fractions

Compare: $\frac{4}{2}$ ___ 1. Write >, <, or =.

Task card 9 Whole Numbers as Fractions

$3 = \frac{\quad}{8}$

Task card 10 Whole Numbers as Fractions

$3 = \frac{9}{\quad}$

Task card 11 Whole Numbers as Fractions

Each circle is one whole cut into 8 equal parts. All the parts are shaded. Write the shaded amount as a fraction: $\frac{\quad}{8}$

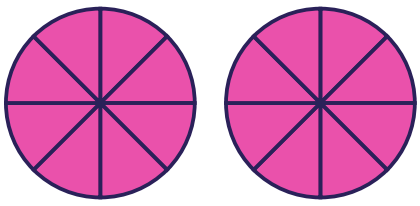

Task card 12 Whole Numbers as Fractions

Compare: $\frac{12}{6}$ ___ 3. Write >, <, or =.

Task card 13 Whole Numbers as Fractions

$$\frac{10}{1} = ___$$

Task card 14 Whole Numbers as Fractions

$$3 = \frac{__}{6}$$

Task card 15 Whole Numbers as Fractions

Compare: $\frac{6}{3}$ ___ 1. Write >, <, or =.

Task card 16 Whole Numbers as Fractions

$$\frac{6}{3} = ___$$

Task card 17 Whole Numbers as Fractions

$$5 = \frac{__}{6}$$

Task card 18 Whole Numbers as Fractions

$$1 = \frac{2}{__}$$

Task card 19 Whole Numbers as Fractions

Each circle is one whole cut into 4 equal parts. All the parts are shaded. Write the shaded amount as a fraction: $\frac{\quad}{4}$



Task card 20 Whole Numbers as Fractions

Compare: $\frac{30}{6}$ ___ 4. Write >, <, or =.

Task card 21 Whole Numbers as Fractions

$11 = \frac{\quad}{1}$

Task card 22 Whole Numbers as Fractions

$5 = \frac{\quad}{8}$

Task card 23 Whole Numbers as Fractions

Compare: $\frac{10}{2}$ ___ 4. Write >, <, or =.

Task card 24 Whole Numbers as Fractions

$\frac{24}{8} = \frac{\quad}{\quad}$

Whole Numbers as Fractions Task Cards

Recording sheet · Grade 3 · Find the missing number.

Name: _____ Date: _____

Scan to check your answers

1	2	3	4
5	6	7	8
9	10	11	12
13	14	15	16
17	18	19	20
21	22	23	24

Whole Numbers as Fractions Task Cards: Answer Key

Grade 3 · Medium

The answers online

1. 2	**2.** 4	**3.** 6
4. 3	**5.** =	**6.** 8
7. 2	**8.** >	**9.** 24
10. 3	**11.** 16	**12.** <
13. 10	**14.** 18	**15.** >
16. 2	**17.** 30	**18.** 2
19. 12	**20.** >	**21.** 11
22. 40	**23.** >	**24.** 3