Whole Numbers as Fractions · 1

$\frac{8}{2} = ___$

Whole Numbers as Fractions · 2

$3 = \frac{__}{3}$

Whole Numbers as Fractions · 3

$5 = \frac{15}{__}$

Whole Numbers as Fractions · 4

Each circle is one whole cut into 3 equal parts. All the parts are shaded. Write the shaded amount as a fraction:

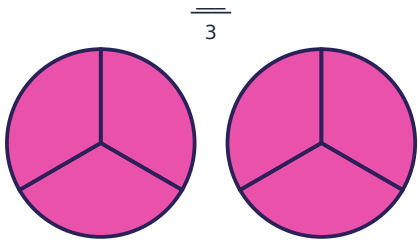

Whole Numbers as Fractions · 5

Compare: $\frac{6}{2}$ ___ 3. Write >, <, or =.

Whole Numbers as Fractions · 6

$2 = \frac{__}{1}$

Whole Numbers as Fractions · 7

$1 = \frac{__}{3}$

Whole Numbers as Fractions · 8

Compare: $\frac{8}{4}$ ___ 1. Write >, <, or =.

Whole Numbers as Fractions · 2

ANSWER

9

Whole Numbers as Fractions · 1

ANSWER

4

Whole Numbers as Fractions · 4

ANSWER

6

Whole Numbers as Fractions · 3

ANSWER

3

Whole Numbers as Fractions · 6

ANSWER

2

Whole Numbers as Fractions · 5

ANSWER

=

Whole Numbers as Fractions · 8

ANSWER

>

Whole Numbers as Fractions · 7

ANSWER

3

Whole Numbers as Fractions · 9

$$\frac{12}{4} = ___$$

Whole Numbers as Fractions · 10

$$5 = \frac{\quad}{4}$$

Whole Numbers as Fractions · 11

$$5 = \frac{40}{___}$$

Whole Numbers as Fractions · 12

Each circle is one whole cut into 8 equal parts. All the parts are shaded. Write the shaded amount as a fraction:

$\frac{\quad}{8}$

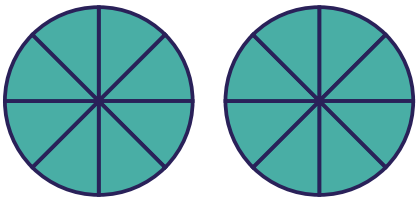

Whole Numbers as Fractions · 13

Compare: $\frac{6}{6}$ ___ 2. Write >, <, or =.

Whole Numbers as Fractions · 14

$$18 = \frac{\quad}{1}$$

Whole Numbers as Fractions · 15

$$2 = \frac{\quad}{4}$$

Whole Numbers as Fractions · 16

Compare: $\frac{2}{2}$ ___ 1. Write >, <, or =.

Whole Numbers as Fractions · 10

ANSWER

20

Whole Numbers as Fractions · 9

ANSWER

3

Whole Numbers as Fractions · 12

ANSWER

16

Whole Numbers as Fractions · 11

ANSWER

8

Whole Numbers as Fractions · 14

ANSWER

18

Whole Numbers as Fractions · 13

ANSWER

<

Whole Numbers as Fractions · 16

ANSWER

=

Whole Numbers as Fractions · 15

ANSWER

8

Whole Numbers as Fractions · 17

$$\frac{8}{8} = ___$$

Whole Numbers as Fractions · 18

$$1 = \frac{__}{2}$$

Whole Numbers as Fractions · 19

$$4 = \frac{32}{__}$$

Whole Numbers as Fractions · 20

Each circle is one whole cut into 8 equal parts. All the parts are shaded. Write the shaded amount as a fraction:

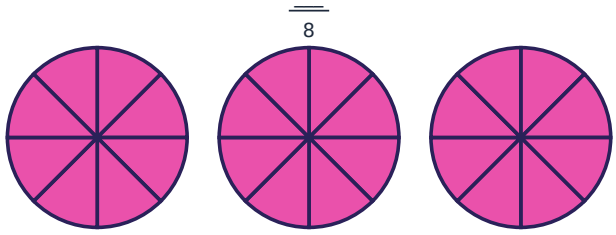

Whole Numbers as Fractions · 21

Compare: $\frac{8}{8}$ ___ 2. Write >, <, or =.

Whole Numbers as Fractions · 22

$$\frac{17}{1} = ___$$

Whole Numbers as Fractions · 23

$$2 = \frac{__}{8}$$

Whole Numbers as Fractions · 24

$$3 = \frac{12}{__}$$

Whole Numbers as Fractions · 18

ANSWER

2

Whole Numbers as Fractions · 17

ANSWER

1

Whole Numbers as Fractions · 20

ANSWER

24

Whole Numbers as Fractions · 19

ANSWER

8

Whole Numbers as Fractions · 22

ANSWER

17

Whole Numbers as Fractions · 21

ANSWER

<

Whole Numbers as Fractions · 24

ANSWER

4

Whole Numbers as Fractions · 23

ANSWER

16