Whole Numbers as Fractions · 1

$\frac{8}{4} = ___$

Whole Numbers as Fractions · 2

$1 = \frac{__}{4}$

Whole Numbers as Fractions · 3

$2 = \frac{12}{__}$

Whole Numbers as Fractions · 4

Each circle is one whole cut into 3 equal parts. All the parts are shaded. Write the shaded amount as a fraction:

$\frac{__}{3}$



Whole Numbers as Fractions · 5

Compare: $\frac{2}{2}$ ___ 1. Write >, <, or =.

Whole Numbers as Fractions · 6

$8 = \frac{__}{1}$

Whole Numbers as Fractions · 7

$1 = \frac{__}{2}$

Whole Numbers as Fractions · 8

Compare: $\frac{4}{2}$ ___ 1. Write >, <, or =.

Whole Numbers as Fractions · 2

ANSWER

4

Whole Numbers as Fractions · 1

ANSWER

2

Whole Numbers as Fractions · 4

ANSWER

3

Whole Numbers as Fractions · 3

ANSWER

6

Whole Numbers as Fractions · 6

ANSWER

8

Whole Numbers as Fractions · 5

ANSWER

=

Whole Numbers as Fractions · 8

ANSWER

>

Whole Numbers as Fractions · 7

ANSWER

2

Whole Numbers as Fractions · 9

$3 = \frac{\quad}{8}$

Whole Numbers as Fractions · 10

$3 = \frac{9}{\quad}$

Whole Numbers as Fractions · 11

Each circle is one whole cut into 8 equal parts. All the parts are shaded. Write the shaded amount as a fraction:

$\frac{\quad}{8}$

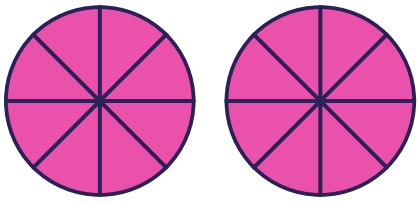

Whole Numbers as Fractions · 12

Compare: $\frac{12}{6}$ ___ 3. Write >, <, or =.

Whole Numbers as Fractions · 13

$\frac{10}{1} = ___$

Whole Numbers as Fractions · 14

$3 = \frac{\quad}{6}$

Whole Numbers as Fractions · 15

Compare: $\frac{6}{3}$ ___ 1. Write >, <, or =.

Whole Numbers as Fractions · 16

$\frac{6}{3} = ___$

Whole Numbers as Fractions · 10

ANSWER

3

Whole Numbers as Fractions · 9

ANSWER

24

Whole Numbers as Fractions · 12

ANSWER

<

Whole Numbers as Fractions · 11

ANSWER

16

Whole Numbers as Fractions · 14

ANSWER

18

Whole Numbers as Fractions · 13

ANSWER

10

Whole Numbers as Fractions · 16

ANSWER

2

Whole Numbers as Fractions · 15

ANSWER

>

Whole Numbers as Fractions · 17

$$5 = \frac{\quad}{6}$$

Whole Numbers as Fractions · 18

$$1 = \frac{2}{\quad}$$

Whole Numbers as Fractions · 19

Each circle is one whole cut into 4 equal parts. All the parts are shaded. Write the shaded amount as a fraction:

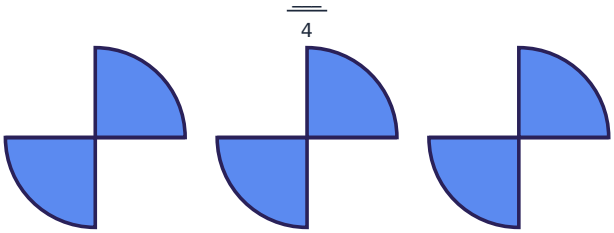

Whole Numbers as Fractions · 20

Compare: $\frac{30}{6}$ ___ 4. Write >, <, or =.

Whole Numbers as Fractions · 21

$$11 = \frac{\quad}{1}$$

Whole Numbers as Fractions · 22

$$5 = \frac{\quad}{8}$$

Whole Numbers as Fractions · 23

Compare: $\frac{10}{2}$ ___ 4. Write >, <, or =.

Whole Numbers as Fractions · 24

$$\frac{24}{8} = ___$$

Whole Numbers as Fractions · 18

ANSWER

2

Whole Numbers as Fractions · 17

ANSWER

30

Whole Numbers as Fractions · 20

ANSWER

>

Whole Numbers as Fractions · 19

ANSWER

12

Whole Numbers as Fractions · 22

ANSWER

40

Whole Numbers as Fractions · 21

ANSWER

11

Whole Numbers as Fractions · 24

ANSWER

3

Whole Numbers as Fractions · 23

ANSWER

>