Whole Numbers as Fractions · 1

Each circle is one whole cut into 3 equal parts. All the parts are shaded. Write the shaded amount as a fraction:

$\frac{\quad}{3}$



Whole Numbers as Fractions · 2

$\frac{4}{4} = ___$

Whole Numbers as Fractions · 3

$\frac{2}{2} = ___$

Whole Numbers as Fractions · 4

$1 = \frac{\quad}{4}$

Whole Numbers as Fractions · 5

Each circle is one whole cut into 4 equal parts. All the parts are shaded. Write the shaded amount as a fraction:

$\frac{\quad}{4}$

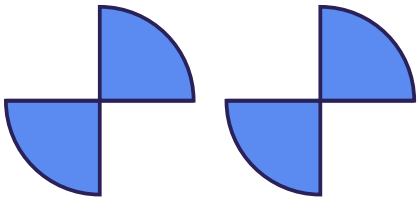

Whole Numbers as Fractions · 6

$\frac{8}{1} = ___$

Whole Numbers as Fractions · 7

$\frac{6}{3} = ___$

Whole Numbers as Fractions · 8

$\frac{3}{3} = ___$

Whole Numbers as Fractions · 2

ANSWER

1

Whole Numbers as Fractions · 1

ANSWER

3

Whole Numbers as Fractions · 4

ANSWER

4

Whole Numbers as Fractions · 3

ANSWER

1

Whole Numbers as Fractions · 6

ANSWER

8

Whole Numbers as Fractions · 5

ANSWER

8

Whole Numbers as Fractions · 8

ANSWER

1

Whole Numbers as Fractions · 7

ANSWER

2

Whole Numbers as Fractions · 9

Each circle is one whole cut into 4 equal parts. All the parts are shaded. Write the shaded amount as a fraction:

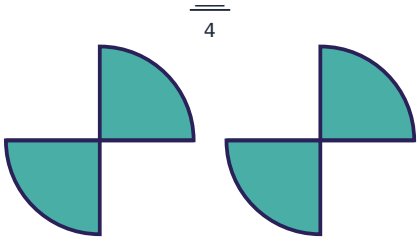

Whole Numbers as Fractions · 10

$$2 = \frac{\quad}{2}$$

Whole Numbers as Fractions · 11

$$2 = \frac{\quad}{1}$$

Whole Numbers as Fractions · 12

$$\frac{8}{4} = \frac{\quad}{\quad}$$

Whole Numbers as Fractions · 13

Each circle is one whole cut into 2 equal parts. All the parts are shaded. Write the shaded amount as a fraction:

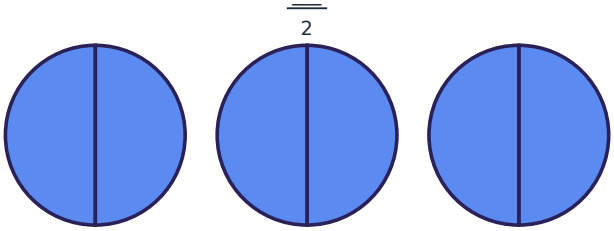

Whole Numbers as Fractions · 14

$$\frac{4}{2} = \frac{\quad}{\quad}$$

Whole Numbers as Fractions · 15

$$1 = \frac{\quad}{8}$$

Whole Numbers as Fractions · 16

Each circle is one whole cut into 6 equal parts. All the parts are shaded. Write the shaded amount as a fraction:

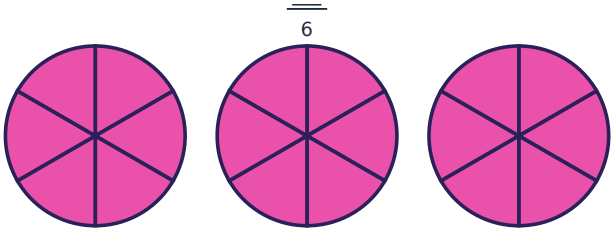

Whole Numbers as Fractions · 10

ANSWER

4

Whole Numbers as Fractions · 9

ANSWER

8

Whole Numbers as Fractions · 12

ANSWER

2

Whole Numbers as Fractions · 11

ANSWER

2

Whole Numbers as Fractions · 14

ANSWER

2

Whole Numbers as Fractions · 13

ANSWER

6

Whole Numbers as Fractions · 16

ANSWER

18

Whole Numbers as Fractions · 15

ANSWER

8

Whole Numbers as Fractions · 17

$$\frac{6}{1} = ___$$

Whole Numbers as Fractions · 18

$$\frac{6}{6} = ___$$

Whole Numbers as Fractions · 19

$$1 = \frac{\quad}{2}$$

Whole Numbers as Fractions · 20

Each circle is one whole cut into 2 equal parts. All the parts are shaded. Write the shaded amount as a fraction:

$\frac{\quad}{2}$

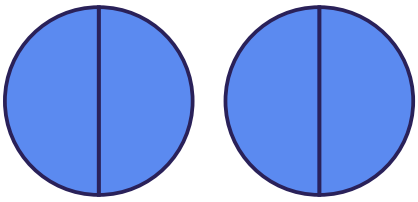

Whole Numbers as Fractions · 21

$$8 = \frac{\quad}{1}$$

Whole Numbers as Fractions · 22

Each circle is one whole cut into 3 equal parts. All the parts are shaded. Write the shaded amount as a fraction:

$\frac{\quad}{3}$

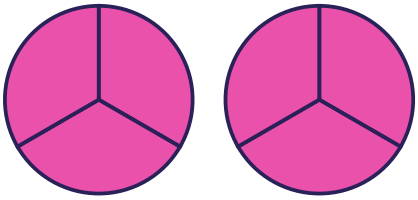

Whole Numbers as Fractions · 23

Each circle is one whole cut into 2 equal parts. All the parts are shaded. Write the shaded amount as a fraction:

$\frac{\quad}{2}$



Whole Numbers as Fractions · 24

$$\frac{2}{1} = ___$$

Whole Numbers as Fractions · 18

ANSWER

1

Whole Numbers as Fractions · 17

ANSWER

6

Whole Numbers as Fractions · 20

ANSWER

4

Whole Numbers as Fractions · 19

ANSWER

2

Whole Numbers as Fractions · 22

ANSWER

6

Whole Numbers as Fractions · 21

ANSWER

8

Whole Numbers as Fractions · 24

ANSWER

2

Whole Numbers as Fractions · 23

ANSWER

2