Task card 1 Valentine's Day Math

A heart-shaped cake is cut into 12 equal slices. The family eats 11 slices. What fraction of the heart-shaped cake did they eat?

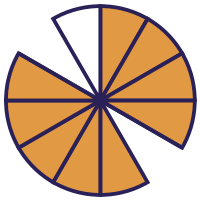

Task card 2 Valentine's Day Math

At the Valentine's party there are 3 tables. 4 people sit at each table. How many people are there?

Task card 3 Valentine's Day Math

Ben shares 24 brownies equally among 8 friends. How many brownies does each friend get?

Task card 4 Valentine's Day Math

At the Valentine's party there are 3 tables. 7 people sit at each table. How many people are there?

Task card 5 Valentine's Day Math

The class Valentine's party starts at 12:00. It lasts 3 hours. What time does the party end?



Task card 6 Valentine's Day Math

The class Valentine's party starts at 12:30. It lasts 3 hours. What time does the party end?



Task card 7 Valentine's Day Math

A heart-shaped cake is cut into 10 equal slices. The family eats 3 slices. What fraction of the heart-shaped cake did they eat?

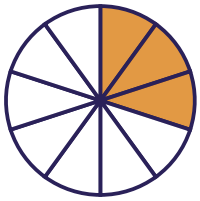

Task card 8 Valentine's Day Math

Ben shares 90 cupcakes equally among 9 friends. How many cupcakes does each friend get?

Task card 9 Valentine's Day Math

The class Valentine's party starts at 1:30. It lasts 4 hours. What time does the party end?



Task card 10 Valentine's Day Math

At the Valentine's party there are 9 tables. 3 people sit at each table. How many people are there?

Task card 11 Valentine's Day Math

A heart-shaped cake is cut into 6 equal slices. The family eats 5 slices. What fraction of the heart-shaped cake did they eat?

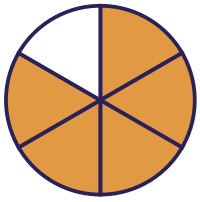

Task card 12 Valentine's Day Math

Ava shares 16 cupcakes equally among 8 friends. How many cupcakes does each friend get?

Task card 13 Valentine's Day Math

A heart-shaped cake is cut into 8 equal slices. The family eats 3 slices. What fraction of the heart-shaped cake did they eat?

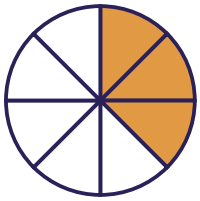

Task card 14 Valentine's Day Math

At the Valentine's party there are 9 tables. 8 people sit at each table. How many people are there?

Task card 15 Valentine's Day Math

Mia shares 54 cupcakes equally among 9 friends. How many cupcakes does each friend get?

Task card 16 Valentine's Day Math

The class Valentine's party starts at 10:30. It lasts 4 hours. What time does the party end?



Task card 17 Valentine's Day Math

At the Valentine's party there are 2 tables. 7 people sit at each table. How many people are there?

Task card 18 Valentine's Day Math

The class Valentine's party starts at 10:30. It lasts 5 hours. What time does the party end?



Task card 19 Valentine's Day Math

At the Valentine's party there are 2 tables. 9 people sit at each table. How many people are there?

Task card 20 Valentine's Day Math

The class Valentine's party starts at 11:30. It lasts 2 hours. What time does the party end?



Task card 21 Valentine's Day Math

Omar shares 30 brownies equally among 6 friends. How many brownies does each friend get?

Task card 22 Valentine's Day Math

Omar shares 12 brownies equally among 4 friends. How many brownies does each friend get?

Task card 23 Valentine's Day Math

At the Valentine's party there are 2 tables. 3 people sit at each table. How many people are there?

Task card 24 Valentine's Day Math

A heart-shaped cake is cut into 8 equal slices. The family eats 1 slice. What fraction of the heart-shaped cake did they eat?

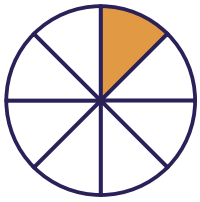

Valentine's Day Math Task Cards

Recording sheet · Grade 3 · Read each story and solve. Write times like 3:00 and fractions like 3/8.

Name: _____ Date: _____

Scan to check your answers

1	2	3	4
5	6	7	8
9	10	11	12
13	14	15	16
17	18	19	20
21	22	23	24

Valentine's Day Math Task Cards: Answer Key

Grade 3 · Hard

The answers online

1. $\frac{11}{12}$	**2.** 12	**3.** 3
4. 21	**5.** 3:00	**6.** 3:30
7. $\frac{3}{10}$	**8.** 10	**9.** 5:30
10. 27	**11.** $\frac{5}{6}$	**12.** 2
13. $\frac{3}{8}$	**14.** 72	**15.** 6
16. 2:30	**17.** 14	**18.** 3:30
19. 18	**20.** 1:30	**21.** 5
22. 3	**23.** 6	**24.** $\frac{1}{8}$