Task card 1 Valentine's Day Math

At the Valentine's party there are 9 tables. 2 people sit at each table. How many people are there?

Task card 2 Valentine's Day Math

The class Valentine's party starts at 1:00. It lasts 5 hours. What time does the party end?



Task card 3 Valentine's Day Math

The class Valentine's party starts at 11:00. It lasts 2 hours. What time does the party end?



Task card 4 Valentine's Day Math

Lily shares 20 brownies equally among 5 friends. How many brownies does each friend get?

Task card 5 Valentine's Day Math

Lily shares 24 brownies equally among 8 friends. How many brownies does each friend get?

Task card 6 Valentine's Day Math

At the Valentine's party there are 4 tables. 5 people sit at each table. How many people are there?

Task card 7 Valentine's Day Math

A heart-shaped cake is cut into 8 equal slices. The family eats 5 slices. What fraction of the heart-shaped cake did they eat?

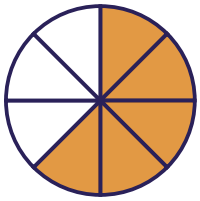

Task card 8 Valentine's Day Math

A heart-shaped cake is cut into 6 equal slices. The family eats 1 slice. What fraction of the heart-shaped cake did they eat?

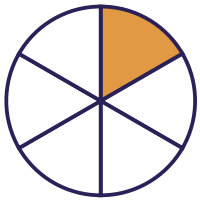

Task card 9 Valentine's Day Math

The class Valentine's party starts at 9:00. It lasts 3 hours. What time does the party end?



Task card 10 Valentine's Day Math

Lily shares 16 heart cookies equally among 4 friends. How many heart cookies does each friend get?

Task card 11 Valentine's Day Math

Ella shares 24 brownies equally among 8 friends. How many brownies does each friend get?

Task card 12 Valentine's Day Math

At the Valentine's party there are 5 tables. 2 people sit at each table. How many people are there?

Task card 13 Valentine's Day Math

At the Valentine's party there are 7 tables. 6 people sit at each table. How many people are there?

Task card 14 Valentine's Day Math

The class Valentine's party starts at 12:00. It lasts 5 hours. What time does the party end?



Task card 15 Valentine's Day Math

A heart-shaped cake is cut into 6 equal slices. The family eats 5 slices. What fraction of the heart-shaped cake did they eat?

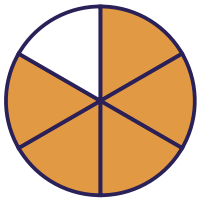

Task card 16 Valentine's Day Math

Mia shares 12 heart cookies equally among 3 friends. How many heart cookies does each friend get?

Task card 17 Valentine's Day Math

A heart-shaped cake is cut into 8 equal slices. The family eats 3 slices. What fraction of the heart-shaped cake did they eat?



Task card 18 Valentine's Day Math

Ben shares 16 heart cookies equally among 8 friends. How many heart cookies does each friend get?

Task card 19 Valentine's Day Math

The class Valentine's party starts at 9:00. It lasts 5 hours. What time does the party end?



Task card 20 Valentine's Day Math

At the Valentine's party there are 6 tables. 4 people sit at each table. How many people are there?

Task card 21 Valentine's Day Math

At the Valentine's party there are 9 tables. 4 people sit at each table. How many people are there?

Task card 22 Valentine's Day Math

Lily shares 10 brownies equally among 5 friends. How many brownies does each friend get?

Task card 23 Valentine's Day Math

A heart-shaped cake is cut into 8 equal slices. The family eats 7 slices. What fraction of the heart-shaped cake did they eat?



Task card 24 Valentine's Day Math

A heart-shaped cake is cut into 4 equal slices. The family eats 1 slice. What fraction of the heart-shaped cake did they eat?



Valentine's Day Math Task Cards

Recording sheet · Grade 3 · Read each story and solve. Write times like 3:00 and fractions like 3/8.

Name: _____ Date: _____

Scan to check your answers

1	2	3	4
5	6	7	8
9	10	11	12
13	14	15	16
17	18	19	20
21	22	23	24

Valentine's Day Math Task Cards: Answer Key

Grade 3 · Easy

The answers online

1. 18	**2.** 6:00	**3.** 1:00
4. 4	**5.** 3	**6.** 20
7. $\frac{5}{8}$	**8.** $\frac{1}{6}$	**9.** 12:00
10. 4	**11.** 3	**12.** 10
13. 42	**14.** 5:00	**15.** $\frac{5}{6}$
16. 4	**17.** $\frac{3}{8}$	**18.** 2
19. 2:00	**20.** 24	**21.** 36
22. 2	**23.** $\frac{7}{8}$	**24.** $\frac{1}{4}$