Valentine's Day Math · 1

The class Valentine's party starts at 1:00. It lasts 3 hours. What time does the party end?



Valentine's Day Math · 2

At the Valentine's party there are 7 tables. 8 people sit at each table. How many people are there?

Valentine's Day Math · 3

The class Valentine's party starts at 12:00. It lasts 5 hours. What time does the party end?



Valentine's Day Math · 4

At the Valentine's party there are 5 tables. 5 people sit at each table. How many people are there?

Valentine's Day Math · 5

A heart-shaped cake is cut into 12 equal slices. The family eats 7 slices. What fraction of the heart-shaped cake did they eat?

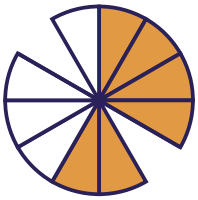

Valentine's Day Math · 6

Omar shares 9 brownies equally among 3 friends. How many brownies does each friend get?

Valentine's Day Math · 7

A heart-shaped cake is cut into 6 equal slices. The family eats 5 slices. What fraction of the heart-shaped cake did they eat?

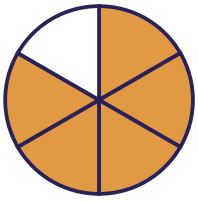

Valentine's Day Math · 8

Lily shares 64 cupcakes equally among 8 friends. How many cupcakes does each friend get?

Valentine's Day Math · 2

ANSWER

56

Valentine's Day Math · 1

ANSWER

4:00

Valentine's Day Math · 4

ANSWER

25

Valentine's Day Math · 3

ANSWER

5:00

Valentine's Day Math · 6

ANSWER

3

Valentine's Day Math · 5

ANSWER

$$\frac{7}{12}$$

Valentine's Day Math · 8

ANSWER

8

Valentine's Day Math · 7

ANSWER

$$\frac{5}{6}$$

Valentine's Day Math · 9

At the Valentine's party there are 3 tables. 9 people sit at each table. How many people are there?

Valentine's Day Math · 10

The class Valentine's party starts at 9:00. It lasts 2 hours. What time does the party end?



Valentine's Day Math · 11

A heart-shaped cake is cut into 6 equal slices. The family eats 1 slice. What fraction of the heart-shaped cake did they eat?

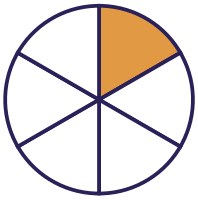

Valentine's Day Math · 12

Ben shares 32 brownies equally among 4 friends. How many brownies does each friend get?

Valentine's Day Math · 13

Ava shares 32 heart cookies equally among 8 friends. How many heart cookies does each friend get?

Valentine's Day Math · 14

At the Valentine's party there are 4 tables. 4 people sit at each table. How many people are there?

Valentine's Day Math · 15

A heart-shaped cake is cut into 8 equal slices. The family eats 3 slices. What fraction of the heart-shaped cake did they eat?

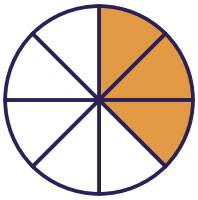

Valentine's Day Math · 16

The class Valentine's party starts at 10:30. It lasts 5 hours. What time does the party end?



Valentine's Day Math · 10

ANSWER

11:00

Valentine's Day Math · 9

ANSWER

27

Valentine's Day Math · 12

ANSWER

8

Valentine's Day Math · 11

ANSWER

$\frac{1}{6}$

Valentine's Day Math · 14

ANSWER

16

Valentine's Day Math · 13

ANSWER

4

Valentine's Day Math · 16

ANSWER

3:30

Valentine's Day Math · 15

ANSWER

$\frac{3}{8}$

Valentine's Day Math · 17

At the Valentine's party there are 6 tables. 7 people sit at each table. How many people are there?

Valentine's Day Math · 18

A heart-shaped cake is cut into 12 equal slices. The family eats 1 slice. What fraction of the heart-shaped cake did they eat?



Valentine's Day Math · 19

A heart-shaped cake is cut into 10 equal slices. The family eats 7 slices. What fraction of the heart-shaped cake did they eat?

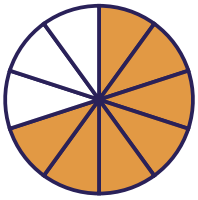

Valentine's Day Math · 20

Sam shares 14 brownies equally among 7 friends. How many brownies does each friend get?

Valentine's Day Math · 21

The class Valentine's party starts at 11:30. It lasts 4 hours. What time does the party end?



Valentine's Day Math · 22

The class Valentine's party starts at 12:30. It lasts 2 hours. What time does the party end?



Valentine's Day Math · 23

At the Valentine's party there are 4 tables. 5 people sit at each table. How many people are there?

Valentine's Day Math · 24

Noah shares 54 cupcakes equally among 9 friends. How many cupcakes does each friend get?

Valentine's Day Math · 18

ANSWER

$\frac{1}{12}$

Valentine's Day Math · 17

ANSWER

42

Valentine's Day Math · 20

ANSWER

2

Valentine's Day Math · 19

ANSWER

$\frac{7}{10}$

Valentine's Day Math · 22

ANSWER

2:30

Valentine's Day Math · 21

ANSWER

3:30

Valentine's Day Math · 24

ANSWER

6

Valentine's Day Math · 23

ANSWER

20