Valentine's Day Math · 1

A heart-shaped cake is cut into 12 equal slices. The family eats 11 slices. What fraction of the heart-shaped cake did they eat?

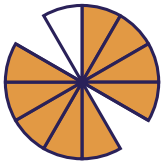

Valentine's Day Math · 2

At the Valentine's party there are 3 tables. 4 people sit at each table. How many people are there?

Valentine's Day Math · 3

Ben shares 24 brownies equally among 8 friends. How many brownies does each friend get?

Valentine's Day Math · 4

At the Valentine's party there are 3 tables. 7 people sit at each table. How many people are there?

Valentine's Day Math · 5

The class Valentine's party starts at 12:00. It lasts 3 hours. What time does the party end?



Valentine's Day Math · 6

The class Valentine's party starts at 12:30. It lasts 3 hours. What time does the party end?



Valentine's Day Math · 7

A heart-shaped cake is cut into 10 equal slices. The family eats 3 slices. What fraction of the heart-shaped cake did they eat?

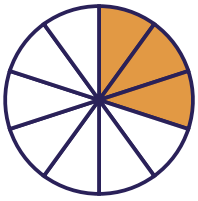

Valentine's Day Math · 8

Ben shares 90 cupcakes equally among 9 friends. How many cupcakes does each friend get?

Valentine's Day Math · 2

**ANSWER**

**12**

Valentine's Day Math · 1

**ANSWER**

$$\frac{11}{12}$$

Valentine's Day Math · 4

**ANSWER**

**21**

Valentine's Day Math · 3

**ANSWER**

**3**

Valentine's Day Math · 6

**ANSWER**

**3:30**

Valentine's Day Math · 5

**ANSWER**

**3:00**

Valentine's Day Math · 8

**ANSWER**

**10**

Valentine's Day Math · 7

**ANSWER**

$$\frac{3}{10}$$

Valentine's Day Math · 9

The class Valentine's party starts at 1:30. It lasts 4 hours. What time does the party end?



Valentine's Day Math · 10

At the Valentine's party there are 9 tables. 3 people sit at each table. How many people are there?

Valentine's Day Math · 11

A heart-shaped cake is cut into 6 equal slices. The family eats 5 slices. What fraction of the heart-shaped cake did they eat?

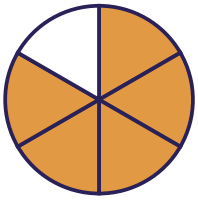

Valentine's Day Math · 12

Ava shares 16 cupcakes equally among 8 friends. How many cupcakes does each friend get?

Valentine's Day Math · 13

A heart-shaped cake is cut into 8 equal slices. The family eats 3 slices. What fraction of the heart-shaped cake did they eat?

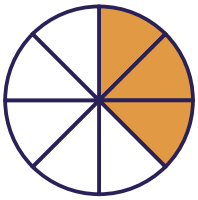

Valentine's Day Math · 14

At the Valentine's party there are 9 tables. 8 people sit at each table. How many people are there?

Valentine's Day Math · 15

Mia shares 54 cupcakes equally among 9 friends. How many cupcakes does each friend get?

Valentine's Day Math · 16

The class Valentine's party starts at 10:30. It lasts 4 hours. What time does the party end?



Valentine's Day Math · 10

**ANSWER**

**27**

Valentine's Day Math · 9

**ANSWER**

**5:30**

Valentine's Day Math · 12

**ANSWER**

**2**

Valentine's Day Math · 11

**ANSWER**

$$\frac{5}{6}$$

Valentine's Day Math · 14

**ANSWER**

**72**

Valentine's Day Math · 13

**ANSWER**

$$\frac{3}{8}$$

Valentine's Day Math · 16

**ANSWER**

**2:30**

Valentine's Day Math · 15

**ANSWER**

**6**

Valentine's Day Math · 17

At the Valentine's party there are 2 tables. 7 people sit at each table. How many people are there?

Valentine's Day Math · 18

The class Valentine's party starts at 10:30. It lasts 5 hours. What time does the party end?



Valentine's Day Math · 19

At the Valentine's party there are 2 tables. 9 people sit at each table. How many people are there?

Valentine's Day Math · 20

The class Valentine's party starts at 11:30. It lasts 2 hours. What time does the party end?



Valentine's Day Math · 21

Omar shares 30 brownies equally among 6 friends. How many brownies does each friend get?

Valentine's Day Math · 22

Omar shares 12 brownies equally among 4 friends. How many brownies does each friend get?

Valentine's Day Math · 23

At the Valentine's party there are 2 tables. 3 people sit at each table. How many people are there?

Valentine's Day Math · 24

A heart-shaped cake is cut into 8 equal slices. The family eats 1 slice. What fraction of the heart-shaped cake did they eat?

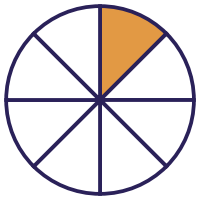

Valentine's Day Math · 18

**ANSWER**

**3:30**

Valentine's Day Math · 17

**ANSWER**

**14**

Valentine's Day Math · 20

**ANSWER**

**1:30**

Valentine's Day Math · 19

**ANSWER**

**18**

Valentine's Day Math · 22

**ANSWER**

**3**

Valentine's Day Math · 21

**ANSWER**

**5**

Valentine's Day Math · 24

**ANSWER**

$$\frac{1}{8}$$

Valentine's Day Math · 23

**ANSWER**

**6**