Valentine's Day Math · 1

At the Valentine's party there are 9 tables. 2 people sit at each table. How many people are there?

Valentine's Day Math · 2

The class Valentine's party starts at 1:00. It lasts 5 hours. What time does the party end?



Valentine's Day Math · 3

The class Valentine's party starts at 11:00. It lasts 2 hours. What time does the party end?



Valentine's Day Math · 4

Lily shares 20 brownies equally among 5 friends. How many brownies does each friend get?

Valentine's Day Math · 5

Lily shares 24 brownies equally among 8 friends. How many brownies does each friend get?

Valentine's Day Math · 6

At the Valentine's party there are 4 tables. 5 people sit at each table. How many people are there?

Valentine's Day Math · 7

A heart-shaped cake is cut into 8 equal slices. The family eats 5 slices. What fraction of the heart-shaped cake did they eat?

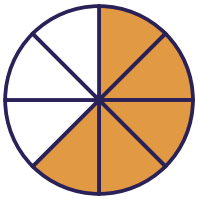

Valentine's Day Math · 8

A heart-shaped cake is cut into 6 equal slices. The family eats 1 slice. What fraction of the heart-shaped cake did they eat?

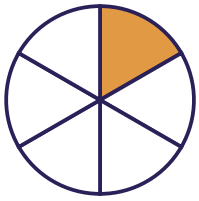

Valentine's Day Math · 2

ANSWER

6:00

Valentine's Day Math · 1

ANSWER

18

Valentine's Day Math · 4

ANSWER

4

Valentine's Day Math · 3

ANSWER

1:00

Valentine's Day Math · 6

ANSWER

20

Valentine's Day Math · 5

ANSWER

3

Valentine's Day Math · 8

ANSWER

$$\frac{1}{6}$$

Valentine's Day Math · 7

ANSWER

$$\frac{5}{8}$$

Valentine's Day Math · 9

The class Valentine's party starts at 9:00. It lasts 3 hours. What time does the party end?



Valentine's Day Math · 10

Lily shares 16 heart cookies equally among 4 friends. How many heart cookies does each friend get?

Valentine's Day Math · 11

Ella shares 24 brownies equally among 8 friends. How many brownies does each friend get?

Valentine's Day Math · 12

At the Valentine's party there are 5 tables. 2 people sit at each table. How many people are there?

Valentine's Day Math · 13

At the Valentine's party there are 7 tables. 6 people sit at each table. How many people are there?

Valentine's Day Math · 14

The class Valentine's party starts at 12:00. It lasts 5 hours. What time does the party end?



Valentine's Day Math · 15

A heart-shaped cake is cut into 6 equal slices. The family eats 5 slices. What fraction of the heart-shaped cake did they eat?

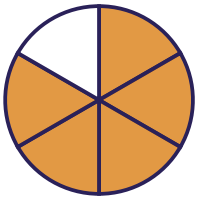

Valentine's Day Math · 16

Mia shares 12 heart cookies equally among 3 friends. How many heart cookies does each friend get?

Valentine's Day Math · 10

ANSWER

4

Valentine's Day Math · 9

ANSWER

12:00

Valentine's Day Math · 12

ANSWER

10

Valentine's Day Math · 11

ANSWER

3

Valentine's Day Math · 14

ANSWER

5:00

Valentine's Day Math · 13

ANSWER

42

Valentine's Day Math · 16

ANSWER

4

Valentine's Day Math · 15

ANSWER

$$\frac{5}{6}$$

Valentine's Day Math · 17

A heart-shaped cake is cut into 8 equal slices. The family eats 3 slices. What fraction of the heart-shaped cake did they eat?

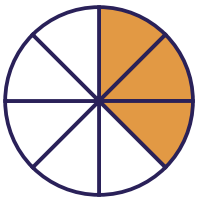

Valentine's Day Math · 18

Ben shares 16 heart cookies equally among 8 friends. How many heart cookies does each friend get?

Valentine's Day Math · 19

The class Valentine's party starts at 9:00. It lasts 5 hours. What time does the party end?



Valentine's Day Math · 20

At the Valentine's party there are 6 tables. 4 people sit at each table. How many people are there?

Valentine's Day Math · 21

At the Valentine's party there are 9 tables. 4 people sit at each table. How many people are there?

Valentine's Day Math · 22

Lily shares 10 brownies equally among 5 friends. How many brownies does each friend get?

Valentine's Day Math · 23

A heart-shaped cake is cut into 8 equal slices. The family eats 7 slices. What fraction of the heart-shaped cake did they eat?



Valentine's Day Math · 24

A heart-shaped cake is cut into 4 equal slices. The family eats 1 slice. What fraction of the heart-shaped cake did they eat?



Valentine's Day Math · 18

ANSWER

2

Valentine's Day Math · 17

ANSWER

$$\frac{3}{8}$$

Valentine's Day Math · 20

ANSWER

24

Valentine's Day Math · 19

ANSWER

2:00

Valentine's Day Math · 22

ANSWER

2

Valentine's Day Math · 21

ANSWER

36

Valentine's Day Math · 24

ANSWER

$$\frac{1}{4}$$

Valentine's Day Math · 23

ANSWER

$$\frac{7}{8}$$