Task card 1 Unit Fractions

The shape is cut into equal parts. What unit fraction names the shaded part?

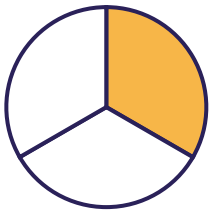

Task card 2 Unit Fractions

The shaded part shows $\frac{2}{2}$. How many copies of $\frac{1}{2}$ is that?



Task card 3 Unit Fractions

Compare: $\frac{1}{4}$ ___ $\frac{1}{8}$. Write >, <, or =.

Task card 4 Unit Fractions

This piece is $\frac{1}{8}$ of a whole bar. How many of these pieces make the whole bar?



whole bar

Task card 5 Unit Fractions

Put together 3 pieces that are each $\frac{1}{4}$ of the same whole. What fraction of the whole is that?

Task card 6 Unit Fractions

Two same-size pizzas are cut into equal slices. One pizza has 4 slices and the other has 3 slices. Which slice is smaller: $\frac{1}{4}$ or $\frac{1}{3}$? Write the fraction.

Task card 7 Unit Fractions

The shape is cut into equal parts. What unit fraction names the shaded part?

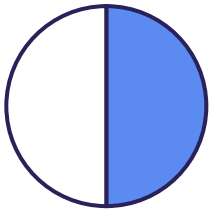

Task card 8 Unit Fractions

The shaded part shows $\frac{2}{2}$. How many $\frac{1}{2}$ copies of $\frac{1}{2}$ is that?



Task card 9 Unit Fractions

The shape is cut into equal parts. What unit fraction names the shaded part?



Task card 10 Unit Fractions

The shaded part shows $\frac{4}{4}$. How many $\frac{1}{4}$ copies of $\frac{1}{4}$ is that?

Task card 11 Unit Fractions

Compare: $\frac{1}{6}$ ___ $\frac{1}{4}$. Write >, <, or =.

Task card 12 Unit Fractions

This piece is $\frac{1}{8}$ of a whole bar. How many of these pieces make the whole bar?



whole bar

Task card 13 Unit Fractions

Put together 2 pieces that are each $\frac{1}{3}$ of the same whole. What fraction of the whole is that?

Task card 14 Unit Fractions

Two same-size pizzas are cut into equal slices. One pizza has 2 slices and the other has 8 slices. Which slice is smaller: $\frac{1}{2}$ or $\frac{1}{8}$? Write the fraction.

Task card 15 Unit Fractions

The shape is cut into equal parts. What unit fraction names the shaded part?



Task card 16 Unit Fractions

The shaded part shows $\frac{2}{2}$. How many copies of $\frac{1}{2}$ is that?

Task card 17 Unit Fractions

The shape is cut into equal parts. What unit fraction names the shaded part?



Task card 18 Unit Fractions

Compare: $\frac{1}{4}$ ___ $\frac{1}{6}$. Write >, <, or =.

Task card 19 Unit Fractions

This piece is $\frac{1}{3}$ of a whole bar. How many of these pieces make the whole bar?



whole bar

Task card 20 Unit Fractions

Put together 5 pieces that are each $\frac{1}{6}$ of the same whole. What fraction of the whole is that?

Task card 21 Unit Fractions

Two same-size pizzas are cut into equal slices. One pizza has 8 slices and the other has 4 slices. Which slice is bigger: $\frac{1}{8}$ or $\frac{1}{4}$? Write the fraction.

Task card 22 Unit Fractions

The shape is cut into equal parts. What unit fraction names the shaded part?

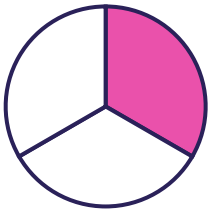

Task card 23 Unit Fractions

The shaded part shows $\frac{6}{6}$. How many copies of $\frac{1}{6}$ is that?

Task card 24 Unit Fractions

The shape is cut into equal parts. What unit fraction names the shaded part?

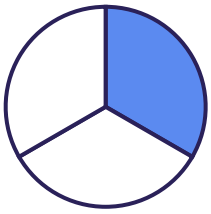

Unit Fractions Task Cards

Recording sheet · Grade 3 · Answer each question about unit fractions.

Name: _____ Date: _____

Scan to check your answers

1	2	3	4
5	6	7	8
9	10	11	12
13	14	15	16
17	18	19	20
21	22	23	24

Unit Fractions Task Cards: Answer Key

Grade 3 · Medium

The answers online

1. $\frac{1}{3}$	**2.** 2	**3.** >
4. 8	**5.** $\frac{3}{4}$	**6.** $\frac{1}{4}$
7. $\frac{1}{2}$	**8.** 2	**9.** $\frac{1}{4}$
10. 4	**11.** <	**12.** 8
13. $\frac{2}{3}$	**14.** $\frac{1}{8}$	**15.** $\frac{1}{8}$
16. 2	**17.** $\frac{1}{6}$	**18.** >
19. 3	**20.** $\frac{5}{6}$	**21.** $\frac{1}{4}$
22. $\frac{1}{3}$	**23.** 6	**24.** $\frac{1}{3}$