Task card 1 Unit Fractions

The shape is cut into equal parts. What unit fraction names the shaded part?



Task card 2 Unit Fractions

The shaded part shows $\frac{2}{2}$. How many copies of $\frac{1}{2}$ is that?

Task card 3 Unit Fractions

Compare: $\frac{1}{8}$ ___ $\frac{1}{4}$. Write >, <, or =.

Task card 4 Unit Fractions

This piece is $\frac{1}{6}$ of a whole bar. How many of these pieces make the whole bar?



whole bar

Task card 5 Unit Fractions

Put together 3 pieces that are each $\frac{1}{4}$ of the same whole. What fraction of the whole is that?

Task card 6 Unit Fractions

Two same-size pizzas are cut into equal slices. One pizza has 4 slices and the other has 8 slices. Which slice is smaller: $\frac{1}{4}$ or $\frac{1}{8}$? Write the fraction.

Task card 7 Unit Fractions

The shape is cut into equal parts. What unit fraction names the shaded part?

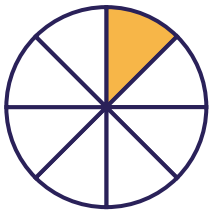

Task card 8 Unit Fractions

The shaded part shows $\frac{8}{8}$. How many copies of $\frac{1}{8}$ is that?

Task card 9 Unit Fractions

The shape is cut into equal parts. What unit fraction names the shaded part?

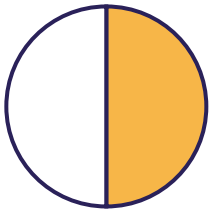

Task card 10 Unit Fractions

The shaded part shows $\frac{3}{3}$. How many copies of $\frac{1}{3}$ is that?

Task card 11 Unit Fractions

Compare: $\frac{1}{3}$ ___ $\frac{1}{6}$. Write >, <, or =.

Task card 12 Unit Fractions

This piece is $\frac{1}{2}$ of a whole bar. How many of these pieces make the whole bar?



whole bar

Task card 13 Unit Fractions

Put together 2 pieces that are each $\frac{1}{3}$ of the same whole. What fraction of the whole is that?

Task card 14 Unit Fractions

Two same-size pizzas are cut into equal slices. One pizza has 6 slices and the other has 2 slices. Which slice is smaller: $\frac{1}{6}$ or $\frac{1}{2}$? Write the fraction.

Task card 15 Unit Fractions

The shaded part shows $\frac{6}{8}$. How many copies of $\frac{1}{8}$ is that?

Task card 16 Unit Fractions

The shape is cut into equal parts. What unit fraction names the shaded part?



Task card 17 Unit Fractions

This piece is $\frac{1}{3}$ of a whole bar. How many of these pieces make the whole bar?



whole bar

Task card 18 Unit Fractions

Two same-size pizzas are cut into equal slices. One pizza has 8 slices and the other has 2 slices. Which slice is smaller: $\frac{1}{8}$ or $\frac{1}{2}$? Write the fraction.

Task card 19 Unit Fractions

The shaded part shows $\frac{3}{4}$. How many copies of $\frac{1}{4}$ is that?

Task card 20 Unit Fractions

The shape is cut into equal parts. What unit fraction names the shaded part?

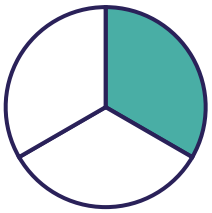

Task card 21 Unit Fractions

Compare: $\frac{1}{6}$ ___ $\frac{1}{8}$. Write >, <, or =.

Task card 22 Unit Fractions

This piece is $\frac{1}{8}$ of a whole bar. How many of these pieces make the whole bar?

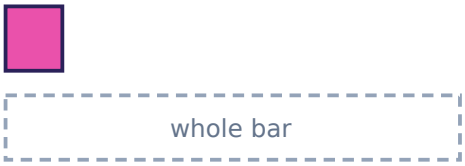

Task card 23 Unit Fractions

Put together 5 pieces that are each $\frac{1}{6}$ of the same whole. What fraction of the whole is that?

Task card 24 Unit Fractions

Two same-size pizzas are cut into equal slices. One pizza has 2 slices and the other has 8 slices. Which slice is smaller: $\frac{1}{2}$ or $\frac{1}{8}$? Write the fraction.

Unit Fractions Task Cards

Recording sheet · Grade 3 · Answer each question about unit fractions.

Name: _____ Date: _____

Scan to check your answers

1	2	3	4
5	6	7	8
9	10	11	12
13	14	15	16
17	18	19	20
21	22	23	24

Unit Fractions Task Cards: Answer Key

Grade 3 · Hard

The answers online

1. $\frac{1}{8}$	**2.** 2	**3.** <
4. 6	**5.** $\frac{3}{4}$	**6.** $\frac{1}{8}$
7. $\frac{1}{8}$	**8.** 8	**9.** $\frac{1}{2}$
10. 3	**11.** >	**12.** 2
13. $\frac{2}{3}$	**14.** $\frac{1}{6}$	**15.** 6
16. $\frac{1}{8}$	**17.** 3	**18.** $\frac{1}{8}$
19. 3	**20.** $\frac{1}{3}$	**21.** >
22. 8	**23.** $\frac{5}{6}$	**24.** $\frac{1}{8}$