Unit Fractions · 1

The shape is cut into equal parts. What unit fraction names the shaded part?



Unit Fractions · 2

The shaded part shows $\frac{2}{2}$. How many copies of $\frac{1}{2}$ is that?



Unit Fractions · 3

Compare: $\frac{1}{4}$ ___ $\frac{1}{8}$. Write >, <, or =.

Unit Fractions · 4

This piece is $\frac{1}{8}$ of a whole bar. How many of these pieces make the whole bar?



whole bar

Unit Fractions · 5

Put together 3 pieces that are each $\frac{1}{4}$ of the same whole. What fraction of the whole is that?

Unit Fractions · 6

Two same-size pizzas are cut into equal slices. One pizza has 4 slices and the other has 3 slices. Which slice is smaller: $\frac{1}{4}$ or $\frac{1}{3}$? Write the fraction.

Unit Fractions · 7

The shape is cut into equal parts. What unit fraction names the shaded part?

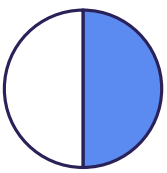

Unit Fractions · 8

The shaded part shows $\frac{2}{2}$. How many copies of $\frac{1}{2}$ is that?



Unit Fractions · 2

ANSWER

2

Unit Fractions · 1

ANSWER

$\frac{1}{3}$

Unit Fractions · 4

ANSWER

8

Unit Fractions · 3

ANSWER

$>$

Unit Fractions · 6

ANSWER

$\frac{1}{4}$

Unit Fractions · 5

ANSWER

$\frac{3}{4}$

Unit Fractions · 8

ANSWER

2

Unit Fractions · 7

ANSWER

$\frac{1}{2}$

Unit Fractions · 9

The shape is cut into equal parts. What unit fraction names the shaded part?



Unit Fractions · 10

The shaded part shows $\frac{4}{4}$. How many copies of $\frac{1}{4}$ is that?

Unit Fractions · 11

Compare: $\frac{1}{6}$ ___ $\frac{1}{4}$. Write >, <, or =.

Unit Fractions · 12

This piece is $\frac{1}{8}$ of a whole bar. How many of these pieces make the whole bar?



whole bar

Unit Fractions · 13

Put together 2 pieces that are each $\frac{1}{3}$ of the same whole. What fraction of the whole is that?

Unit Fractions · 14

Two same-size pizzas are cut into equal slices. One pizza has 2 slices and the other has 8 slices. Which slice is smaller: $\frac{1}{2}$ or $\frac{1}{8}$? Write the fraction.

Unit Fractions · 15

The shape is cut into equal parts. What unit fraction names the shaded part?



Unit Fractions · 16

The shaded part shows $\frac{2}{2}$. How many copies of $\frac{1}{2}$ is that?

Unit Fractions · 10

ANSWER

4

Unit Fractions · 9

ANSWER

$\frac{1}{4}$

Unit Fractions · 12

ANSWER

8

Unit Fractions · 11

ANSWER

$<$

Unit Fractions · 14

ANSWER

$\frac{1}{8}$

Unit Fractions · 13

ANSWER

$\frac{2}{3}$

Unit Fractions · 16

ANSWER

2

Unit Fractions · 15

ANSWER

$\frac{1}{8}$

Unit Fractions · 17

The shape is cut into equal parts. What unit fraction names the shaded part?



Unit Fractions · 18

Compare: $\frac{1}{4}$ ___ $\frac{1}{6}$. Write >, <, or =.

Unit Fractions · 19

This piece is $\frac{1}{3}$ of a whole bar. How many of these pieces make the whole bar?



whole bar

Unit Fractions · 20

Put together 5 pieces that are each $\frac{1}{6}$ of the same whole. What fraction of the whole is that?

Unit Fractions · 21

Two same-size pizzas are cut into equal slices. One pizza has 8 slices and the other has 4 slices. Which slice is bigger: $\frac{1}{8}$ or $\frac{1}{4}$? Write the fraction.

Unit Fractions · 22

The shape is cut into equal parts. What unit fraction names the shaded part?

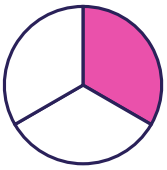

Unit Fractions · 23

The shaded part shows $\frac{6}{6}$. How many copies of $\frac{1}{6}$ is that?

Unit Fractions · 24

The shape is cut into equal parts. What unit fraction names the shaded part?

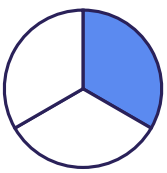

Unit Fractions · 18

ANSWER

$>$

Unit Fractions · 17

ANSWER

$\frac{1}{6}$

Unit Fractions · 20

ANSWER

$\frac{5}{6}$

Unit Fractions · 19

ANSWER

3

Unit Fractions · 22

ANSWER

$\frac{1}{3}$

Unit Fractions · 21

ANSWER

$\frac{1}{4}$

Unit Fractions · 24

ANSWER

$\frac{1}{3}$

Unit Fractions · 23

ANSWER

6