Task card 1 Thanksgiving Math

At Thanksgiving dinner there are 4 tables. 3 people sit at each table. How many people are there?

Task card 2 Thanksgiving Math

A pumpkin pie is cut into 12 equal slices. The family eats 5 slices. What fraction of the pumpkin pie did they eat?

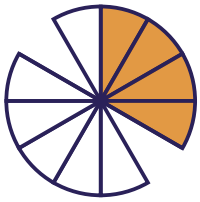

Task card 3 Thanksgiving Math

Ella shares 16 cranberry tarts equally among 4 friends. How many cranberry tarts does each friend get?

Task card 4 Thanksgiving Math

At Thanksgiving dinner there are 8 tables. 3 people sit at each table. How many people are there?

Task card 5 Thanksgiving Math

Ava puts the turkey in the oven at 11:00. It roasts for 3 hours. What time is the turkey done?



Task card 6 Thanksgiving Math

A pumpkin pie is cut into 10 equal slices. The family eats 3 slices. What fraction of the pumpkin pie did they eat?

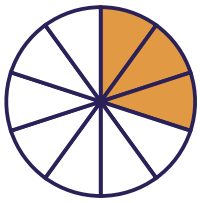

Task card 7 Thanksgiving Math

Zoe puts the turkey in the oven at 9:00. It roasts for 4 hours. What time is the turkey done?



Task card 8 Thanksgiving Math

Ben shares 15 corn muffins equally among 5 friends. How many corn muffins does each friend get?

Task card 9 Thanksgiving Math

A pumpkin pie is cut into 8 equal slices. The family eats 1 slice. What fraction of the pumpkin pie did they eat?

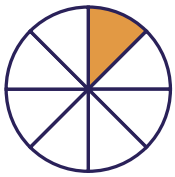

Task card 10 Thanksgiving Math

A pumpkin pie is cut into 6 equal slices. The family eats 1 slice. What fraction of the pumpkin pie did they eat?

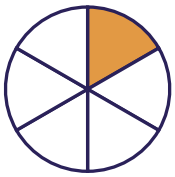

Task card 11 Thanksgiving Math

Leo shares 18 corn muffins equally among 3 friends. How many corn muffins does each friend get?

Task card 12 Thanksgiving Math

Omar puts the turkey in the oven at 9:00. It roasts for 2 hours. What time is the turkey done?



Task card 13 Thanksgiving Math

Lily shares 21 rolls equally among 3 friends. How many rolls does each friend get?

Task card 14 Thanksgiving Math

At Thanksgiving dinner there are 2 tables. 9 people sit at each table. How many people are there?

Task card 15 Thanksgiving Math

At Thanksgiving dinner there are 6 tables. 9 people sit at each table. How many people are there?

Task card 16 Thanksgiving Math

Noah puts the turkey in the oven at 11:00. It roasts for 5 hours. What time is the turkey done?



Task card 17 Thanksgiving Math

Noah shares 36 rolls equally among 4 friends. How many rolls does each friend get?

Task card 18 Thanksgiving Math

At Thanksgiving dinner there are 8 tables. 7 people sit at each table. How many people are there?

Task card 19 Thanksgiving Math

Ben puts the turkey in the oven at 11:30. It roasts for 5 hours. What time is the turkey done?



Task card 20 Thanksgiving Math

At Thanksgiving dinner there are 6 tables. 8 people sit at each table. How many people are there?

Task card 21 Thanksgiving Math

Sam shares 15 corn muffins equally among 3 friends. How many corn muffins does each friend get?

Task card 22 Thanksgiving Math

Noah puts the turkey in the oven at 9:30. It roasts for 2 hours. What time is the turkey done?



Task card 23 Thanksgiving Math

Ben puts the turkey in the oven at 10:00. It roasts for 4 hours. What time is the turkey done?



Task card 24 Thanksgiving Math

A pumpkin pie is cut into 10 equal slices. The family eats 9 slices. What fraction of the pumpkin pie did they eat?

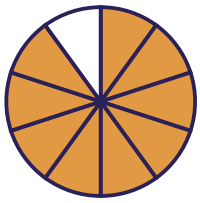

Thanksgiving Math Task Cards

Recording sheet · Grade 3 · Read each story and solve. Write times like 3:00 and fractions like 3/8.

Name: _____ Date: _____

Scan to check your answers

1	2	3	4
5	6	7	8
9	10	11	12
13	14	15	16
17	18	19	20
21	22	23	24

Thanksgiving Math Task Cards: Answer Key

Grade 3 · Medium

The answers online

1. 12	**2.** $\frac{5}{12}$	**3.** 4
4. 24	**5.** 2:00	**6.** $\frac{3}{10}$
7. 1:00	**8.** 3	**9.** $\frac{1}{8}$
10. $\frac{1}{6}$	**11.** 6	**12.** 11:00
13. 7	**14.** 18	**15.** 54
16. 4:00	**17.** 9	**18.** 56
19. 4:30	**20.** 48	**21.** 5
22. 11:30	**23.** 2:00	**24.** $\frac{9}{10}$