Thanksgiving Math · 1

At Thanksgiving dinner there are 4 tables. 3 people sit at each table. How many people are there?

Thanksgiving Math · 2

A pumpkin pie is cut into 12 equal slices. The family eats 5 slices. What fraction of the pumpkin pie did they eat?

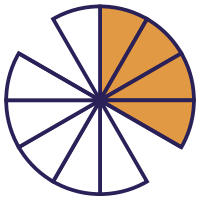

Thanksgiving Math · 3

Ella shares 16 cranberry tarts equally among 4 friends. How many cranberry tarts does each friend get?

Thanksgiving Math · 4

At Thanksgiving dinner there are 8 tables. 3 people sit at each table. How many people are there?

Thanksgiving Math · 5

Ava puts the turkey in the oven at 11:00. It roasts for 3 hours. What time is the turkey done?



Thanksgiving Math · 6

A pumpkin pie is cut into 10 equal slices. The family eats 3 slices. What fraction of the pumpkin pie did they eat?

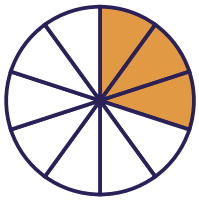

Thanksgiving Math · 7

Zoe puts the turkey in the oven at 9:00. It roasts for 4 hours. What time is the turkey done?



Thanksgiving Math · 8

Ben shares 15 corn muffins equally among 5 friends. How many corn muffins does each friend get?

Thanksgiving Math · 2

ANSWER

$\frac{5}{12}$

Thanksgiving Math · 1

ANSWER

12

Thanksgiving Math · 4

ANSWER

24

Thanksgiving Math · 3

ANSWER

4

Thanksgiving Math · 6

ANSWER

$\frac{3}{10}$

Thanksgiving Math · 5

ANSWER

2:00

Thanksgiving Math · 8

ANSWER

3

Thanksgiving Math · 7

ANSWER

1:00

Thanksgiving Math · 9

A pumpkin pie is cut into 8 equal slices. The family eats 1 slice. What fraction of the pumpkin pie did they eat?

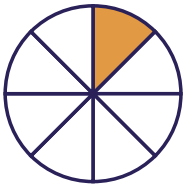

Thanksgiving Math · 10

A pumpkin pie is cut into 6 equal slices. The family eats 1 slice. What fraction of the pumpkin pie did they eat?

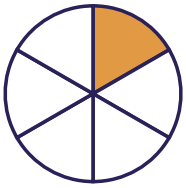

Thanksgiving Math · 11

Leo shares 18 corn muffins equally among 3 friends. How many corn muffins does each friend get?

Thanksgiving Math · 12

Omar puts the turkey in the oven at 9:00. It roasts for 2 hours. What time is the turkey done?



Thanksgiving Math · 13

Lily shares 21 rolls equally among 3 friends. How many rolls does each friend get?

Thanksgiving Math · 14

At Thanksgiving dinner there are 2 tables. 9 people sit at each table. How many people are there?

Thanksgiving Math · 15

At Thanksgiving dinner there are 6 tables. 9 people sit at each table. How many people are there?

Thanksgiving Math · 16

Noah puts the turkey in the oven at 11:00. It roasts for 5 hours. What time is the turkey done?



Thanksgiving Math · 10

ANSWER

$\frac{1}{6}$

Thanksgiving Math · 9

ANSWER

$\frac{1}{8}$

Thanksgiving Math · 12

ANSWER

11:00

Thanksgiving Math · 11

ANSWER

6

Thanksgiving Math · 14

ANSWER

18

Thanksgiving Math · 13

ANSWER

7

Thanksgiving Math · 16

ANSWER

4:00

Thanksgiving Math · 15

ANSWER

54

Thanksgiving Math · 17

Noah shares 36 rolls equally among 4 friends. How many rolls does each friend get?

Thanksgiving Math · 18

At Thanksgiving dinner there are 8 tables. 7 people sit at each table. How many people are there?

Thanksgiving Math · 19

Ben puts the turkey in the oven at 11:30. It roasts for 5 hours. What time is the turkey done?



Thanksgiving Math · 20

At Thanksgiving dinner there are 6 tables. 8 people sit at each table. How many people are there?

Thanksgiving Math · 21

Sam shares 15 corn muffins equally among 3 friends. How many corn muffins does each friend get?

Thanksgiving Math · 22

Noah puts the turkey in the oven at 9:30. It roasts for 2 hours. What time is the turkey done?



Thanksgiving Math · 23

Ben puts the turkey in the oven at 10:00. It roasts for 4 hours. What time is the turkey done?



Thanksgiving Math · 24

A pumpkin pie is cut into 10 equal slices. The family eats 9 slices. What fraction of the pumpkin pie did they eat?

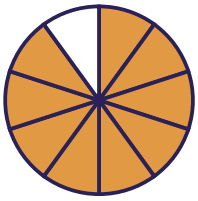

Thanksgiving Math · 18

ANSWER

56

Thanksgiving Math · 17

ANSWER

9

Thanksgiving Math · 20

ANSWER

48

Thanksgiving Math · 19

ANSWER

4:30

Thanksgiving Math · 22

ANSWER

11:30

Thanksgiving Math · 21

ANSWER

5

Thanksgiving Math · 24

ANSWER

$$\frac{9}{10}$$

Thanksgiving Math · 23

ANSWER

2:00