Thanksgiving Math · 1

At Thanksgiving dinner there are 6 tables. 4 people sit at each table. How many people are there?

Thanksgiving Math · 2

Lily shares 30 corn muffins equally among 6 friends. How many corn muffins does each friend get?

Thanksgiving Math · 3

Noah puts the turkey in the oven at 9:00. It roasts for 3 hours. What time is the turkey done?



Thanksgiving Math · 4

Zoe puts the turkey in the oven at 11:00. It roasts for 2 hours. What time is the turkey done?



Thanksgiving Math · 5

Ben shares 18 corn muffins equally among 9 friends. How many corn muffins does each friend get?

Thanksgiving Math · 6

A pumpkin pie is cut into 6 equal slices. The family eats 5 slices. What fraction of the pumpkin pie did they eat?

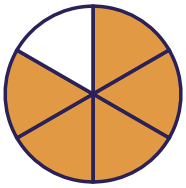

Thanksgiving Math · 7

At Thanksgiving dinner there are 9 tables. 5 people sit at each table. How many people are there?

Thanksgiving Math · 8

A pumpkin pie is cut into 8 equal slices. The family eats 7 slices. What fraction of the pumpkin pie did they eat?

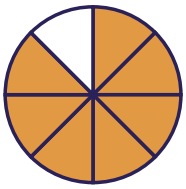

Thanksgiving Math · 2

**ANSWER**

**5**

Thanksgiving Math · 1

**ANSWER**

**24**

Thanksgiving Math · 4

**ANSWER**

**1:00**

Thanksgiving Math · 3

**ANSWER**

**12:00**

Thanksgiving Math · 6

**ANSWER**

$$\frac{5}{6}$$

Thanksgiving Math · 5

**ANSWER**

**2**

Thanksgiving Math · 8

**ANSWER**

$$\frac{7}{8}$$

Thanksgiving Math · 7

**ANSWER**

**45**

Thanksgiving Math · 9

Ava puts the turkey in the oven at 11:00. It roasts for 4 hours. What time is the turkey done?



Thanksgiving Math · 10

Noah puts the turkey in the oven at 10:00. It roasts for 4 hours. What time is the turkey done?



Thanksgiving Math · 11

Zoe shares 10 rolls equally among 5 friends. How many rolls does each friend get?

Thanksgiving Math · 12

At Thanksgiving dinner there are 3 tables. 3 people sit at each table. How many people are there?

Thanksgiving Math · 13

A pumpkin pie is cut into 8 equal slices. The family eats 5 slices. What fraction of the pumpkin pie did they eat?

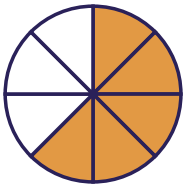

Thanksgiving Math · 14

Ava shares 10 rolls equally among 5 friends. How many rolls does each friend get?

Thanksgiving Math · 15

A pumpkin pie is cut into 8 equal slices. The family eats 1 slice. What fraction of the pumpkin pie did they eat?

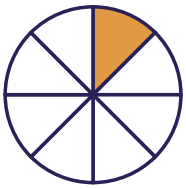

Thanksgiving Math · 16

Omar shares 21 rolls equally among 7 friends. How many rolls does each friend get?

Thanksgiving Math · 10

**ANSWER**

**2:00**

Thanksgiving Math · 9

**ANSWER**

**3:00**

Thanksgiving Math · 12

**ANSWER**

**9**

Thanksgiving Math · 11

**ANSWER**

**2**

Thanksgiving Math · 14

**ANSWER**

**2**

Thanksgiving Math · 13

**ANSWER**

$$\frac{5}{8}$$

Thanksgiving Math · 16

**ANSWER**

**3**

Thanksgiving Math · 15

**ANSWER**

$$\frac{1}{8}$$

Thanksgiving Math · 17

A pumpkin pie is cut into 4 equal slices. The family eats 3 slices. What fraction of the pumpkin pie did they eat?



Thanksgiving Math · 18

At Thanksgiving dinner there are 3 tables. 2 people sit at each table. How many people are there?

Thanksgiving Math · 19

Sam shares 10 rolls equally among 5 friends. How many rolls does each friend get?

Thanksgiving Math · 20

Ava puts the turkey in the oven at 11:00. It roasts for 2 hours. What time is the turkey done?



Thanksgiving Math · 21

At Thanksgiving dinner there are 6 tables. 5 people sit at each table. How many people are there?

Thanksgiving Math · 22

A pumpkin pie is cut into 6 equal slices. The family eats 1 slice. What fraction of the pumpkin pie did they eat?

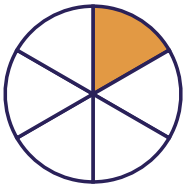

Thanksgiving Math · 23

Sam puts the turkey in the oven at 10:00. It roasts for 3 hours. What time is the turkey done?



Thanksgiving Math · 24

A pumpkin pie is cut into 4 equal slices. The family eats 1 slice. What fraction of the pumpkin pie did they eat?



Thanksgiving Math · 18

**ANSWER**

**6**

Thanksgiving Math · 17

**ANSWER**

$\frac{3}{4}$

Thanksgiving Math · 20

**ANSWER**

**1:00**

Thanksgiving Math · 19

**ANSWER**

**2**

Thanksgiving Math · 22

**ANSWER**

$\frac{1}{6}$

Thanksgiving Math · 21

**ANSWER**

**30**

Thanksgiving Math · 24

**ANSWER**

$\frac{1}{4}$

Thanksgiving Math · 23

**ANSWER**

**1:00**