Thanksgiving Math · 1

At Thanksgiving dinner there are 6 tables. 4 people sit at each table. How many people are there?

Thanksgiving Math · 2

Lily shares 30 corn muffins equally among 6 friends. How many corn muffins does each friend get?

Thanksgiving Math · 3

Noah puts the turkey in the oven at 9:00. It roasts for 3 hours. What time is the turkey done?



Thanksgiving Math · 4

Zoe puts the turkey in the oven at 11:00. It roasts for 2 hours. What time is the turkey done?



Thanksgiving Math · 5

Ben shares 18 corn muffins equally among 9 friends. How many corn muffins does each friend get?

Thanksgiving Math · 6

A pumpkin pie is cut into 6 equal slices. The family eats 5 slices. What fraction of the pumpkin pie did they eat?

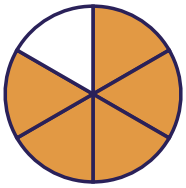

Thanksgiving Math · 7

At Thanksgiving dinner there are 9 tables. 5 people sit at each table. How many people are there?

Thanksgiving Math · 8

A pumpkin pie is cut into 8 equal slices. The family eats 7 slices. What fraction of the pumpkin pie did they eat?

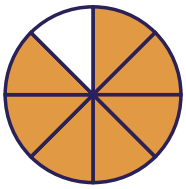

Thanksgiving Math · 2

ANSWER

5

Thanksgiving Math · 1

ANSWER

24

Thanksgiving Math · 4

ANSWER

1:00

Thanksgiving Math · 3

ANSWER

12:00

Thanksgiving Math · 6

ANSWER

$$\frac{5}{6}$$

Thanksgiving Math · 5

ANSWER

2

Thanksgiving Math · 8

ANSWER

$$\frac{7}{8}$$

Thanksgiving Math · 7

ANSWER

45

Thanksgiving Math · 9

Ava puts the turkey in the oven at 11:00. It roasts for 4 hours. What time is the turkey done?



Thanksgiving Math · 10

Noah puts the turkey in the oven at 10:00. It roasts for 4 hours. What time is the turkey done?



Thanksgiving Math · 11

Zoe shares 10 rolls equally among 5 friends. How many rolls does each friend get?

Thanksgiving Math · 12

At Thanksgiving dinner there are 3 tables. 3 people sit at each table. How many people are there?

Thanksgiving Math · 13

A pumpkin pie is cut into 8 equal slices. The family eats 5 slices. What fraction of the pumpkin pie did they eat?

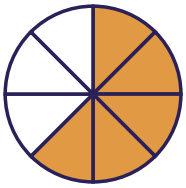

Thanksgiving Math · 14

Ava shares 10 rolls equally among 5 friends. How many rolls does each friend get?

Thanksgiving Math · 15

A pumpkin pie is cut into 8 equal slices. The family eats 1 slice. What fraction of the pumpkin pie did they eat?

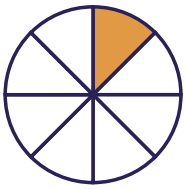

Thanksgiving Math · 16

Omar shares 21 rolls equally among 7 friends. How many rolls does each friend get?

Thanksgiving Math · 10

ANSWER

2:00

Thanksgiving Math · 9

ANSWER

3:00

Thanksgiving Math · 12

ANSWER

9

Thanksgiving Math · 11

ANSWER

2

Thanksgiving Math · 14

ANSWER

2

Thanksgiving Math · 13

ANSWER

$$\frac{5}{8}$$

Thanksgiving Math · 16

ANSWER

3

Thanksgiving Math · 15

ANSWER

$$\frac{1}{8}$$

Thanksgiving Math · 17

A pumpkin pie is cut into 4 equal slices. The family eats 3 slices. What fraction of the pumpkin pie did they eat?



Thanksgiving Math · 18

At Thanksgiving dinner there are 3 tables. 2 people sit at each table. How many people are there?

Thanksgiving Math · 19

Sam shares 10 rolls equally among 5 friends. How many rolls does each friend get?

Thanksgiving Math · 20

Ava puts the turkey in the oven at 11:00. It roasts for 2 hours. What time is the turkey done?



Thanksgiving Math · 21

At Thanksgiving dinner there are 6 tables. 5 people sit at each table. How many people are there?

Thanksgiving Math · 22

A pumpkin pie is cut into 6 equal slices. The family eats 1 slice. What fraction of the pumpkin pie did they eat?

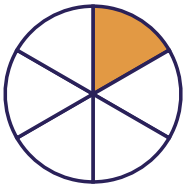

Thanksgiving Math · 23

Sam puts the turkey in the oven at 10:00. It roasts for 3 hours. What time is the turkey done?



Thanksgiving Math · 24

A pumpkin pie is cut into 4 equal slices. The family eats 1 slice. What fraction of the pumpkin pie did they eat?



Thanksgiving Math · 18

ANSWER

6

Thanksgiving Math · 17

ANSWER

$\frac{3}{4}$

Thanksgiving Math · 20

ANSWER

1:00

Thanksgiving Math · 19

ANSWER

2

Thanksgiving Math · 22

ANSWER

$\frac{1}{6}$

Thanksgiving Math · 21

ANSWER

30

Thanksgiving Math · 24

ANSWER

$\frac{1}{4}$

Thanksgiving Math · 23

ANSWER

1:00