Task card 1 Tape Diagrams: Multiplication & Di...

Mia puts 24 pencils equally into 4 boxes. How many pencils go in each box?

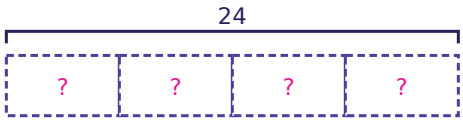

Task card 2 Tape Diagrams: Multiplication & Di...

Ben has 42 pencils and puts 7 in each box. How many boxes does Ben fill?

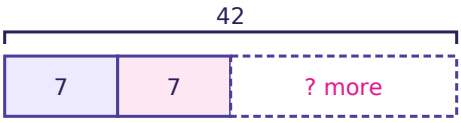

Task card 3 Tape Diagrams: Multiplication & Di...

Max has 6 stickers and puts 2 in each page. How many pages does Max fill?

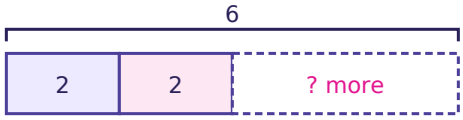

Task card 4 Tape Diagrams: Multiplication & Di...

Zoe puts 4 apples equally into 2 bags. How many apples go in each bag?

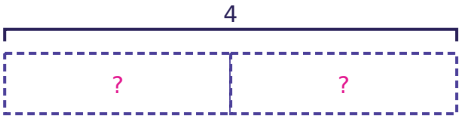

Task card 5 Tape Diagrams: Multiplication & Di...

Sam has 8 cartons with 7 eggs in each carton. How many eggs are there in all?

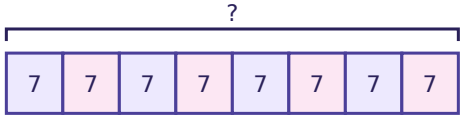

Task card 6 Tape Diagrams: Multiplication & Di...

Eli has 48 stickers and puts 6 in each page. How many pages does Eli fill?

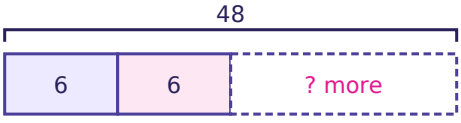

Task card 7 Tape Diagrams: Multiplication & Di...

Zoe puts 15 stickers equally into 3 pages. How many stickers go in each page?



Task card 8 Tape Diagrams: Multiplication & Di...

Eli puts 9 eggs equally into 3 cartons. How many eggs go in each carton?

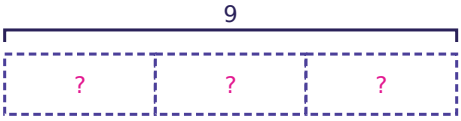

Task card 9 Tape Diagrams: Multiplication & Di...

Mia has 20 pencils and puts 4 in each box. How many boxes does Mia fill?

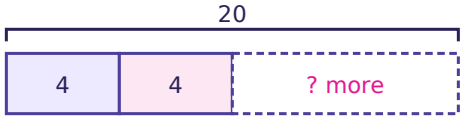

Task card 10 Tape Diagrams: Multiplication & Di...

Eli has 30 cookies and puts 6 in each plate. How many plates does Eli fill?

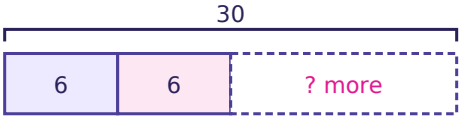

Task card 11 Tape Diagrams: Multiplication & Di...

Zoe puts 6 cookies equally into 2 plates. How many cookies go in each plate?

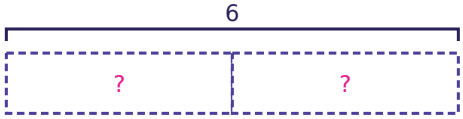

Task card 12 Tape Diagrams: Multiplication & Di...

Nora puts 16 cookies equally into 2 plates. How many cookies go in each plate?

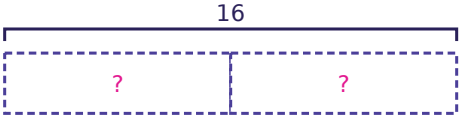

Task card 13 Tape Diagrams: Multiplication & Di...

Ben puts 56 cookies equally into 8 plates. How many cookies go in each plate?

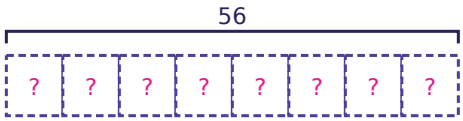

Task card 14 Tape Diagrams: Multiplication & Di...

Max puts 21 pencils equally into 3 boxes. How many pencils go in each box?

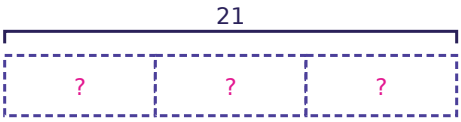

Task card 15 Tape Diagrams: Multiplication & Di...

Nora puts 12 apples equally into 3 bags. How many apples go in each bag?

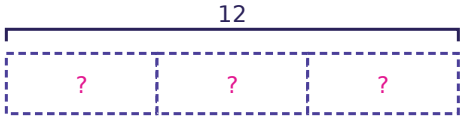

Task card 16 Tape Diagrams: Multiplication & Di...

Zoe has 24 cookies and puts 6 in each plate. How many plates does Zoe fill?

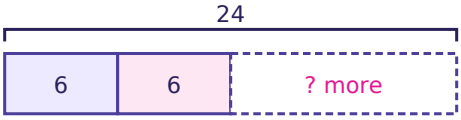

Task card 17 Tape Diagrams: Multiplication & Di...

Mia has 3 bags with 6 apples in each bag. How many apples are there in all?

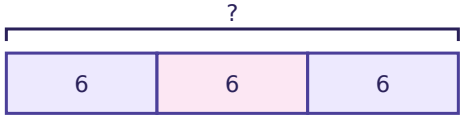

Task card 18 Tape Diagrams: Multiplication & Di...

Leo has 18 pencils and puts 6 in each box. How many boxes does Leo fill?

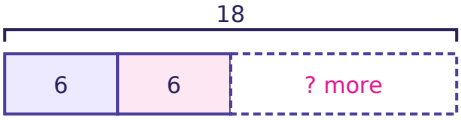

Task card 19 Tape Diagrams: Multiplication & Di...

Lily puts 9 apples equally into 3 bags. How many apples go in each bag?

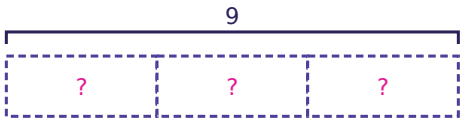

Task card 20 Tape Diagrams: Multiplication & Di...

Leo has 56 apples and puts 7 in each bag. How many bags does Leo fill?

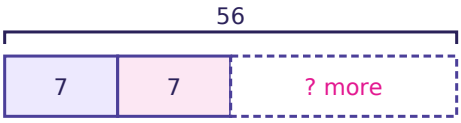

Task card 21 Tape Diagrams: Multiplication & Di...

Lily has 18 stickers and puts 3 in each page. How many pages does Lily fill?

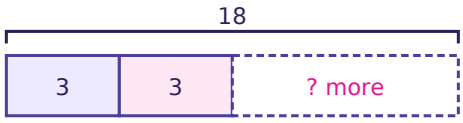

Task card 22 Tape Diagrams: Multiplication & Di...

Mia has 2 plates with 10 cookies in each plate. How many cookies are there in all?

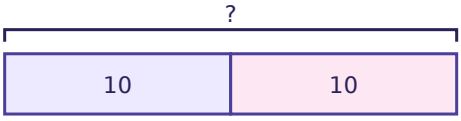

Task card 23 Tape Diagrams: Multiplication & Di...

Ava has 49 pencils and puts 7 in each box. How many boxes does Ava fill?

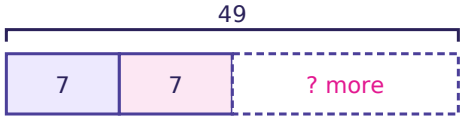

Task card 24 Tape Diagrams: Multiplication & Di...

Zoe has 15 cookies and puts 3 in each plate. How many plates does Zoe fill?

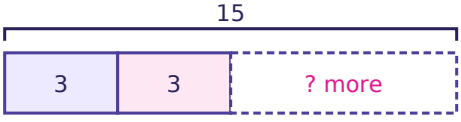

Tape Diagrams: Multiplication & Division Task Cards

Recording sheet · Grade 3 · Read the story and use the tape diagram of equal parts. Find the missing number.

Scan to check your answers

Name: _____ Date: _____

1	2	3	4
5	6	7	8
9	10	11	12
13	14	15	16
17	18	19	20
21	22	23	24

Tape Diagrams: Multiplication & Division Task Cards: Answer Key

Grade 3 · Medium

The answers online

1. 6	**2.** 6	**3.** 3
4. 2	**5.** 56	**6.** 8
7. 5	**8.** 3	**9.** 5
10. 5	**11.** 3	**12.** 8
13. 7	**14.** 7	**15.** 4
16. 4	**17.** 18	**18.** 3
19. 3	**20.** 8	**21.** 6
22. 20	**23.** 7	**24.** 5