Task card 1 Tape Diagrams: Multiplication & Di...

Nora has 2 plates with 3 cookies in each plate. How many cookies are there in all?

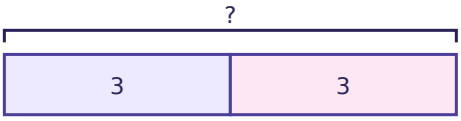

Task card 2 Tape Diagrams: Multiplication & Di...

Eli has 4 bags with 5 apples in each bag. How many apples are there in all?

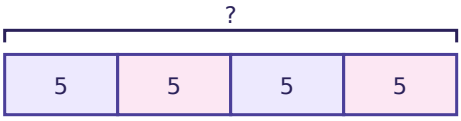

Task card 3 Tape Diagrams: Multiplication & Di...

Mia has 3 vases with 3 flowers in each vase. How many flowers are there in all?

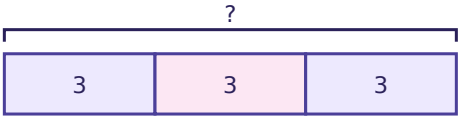

Task card 4 Tape Diagrams: Multiplication & Di...

Ben puts 20 flowers equally into 5 vases. How many flowers go in each vase?

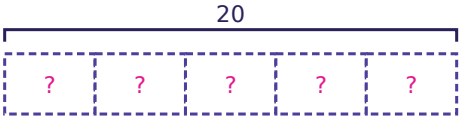

Task card 5 Tape Diagrams: Multiplication & Di...

Ava has 2 cartons with 4 eggs in each carton. How many eggs are there in all?

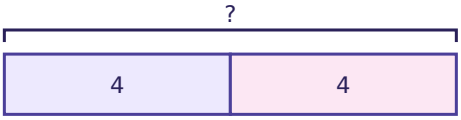

Task card 6 Tape Diagrams: Multiplication & Di...

Zoe has 4 vases with 2 flowers in each vase. How many flowers are there in all?

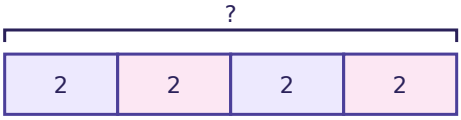

Task card 7 Tape Diagrams: Multiplication & Di...

Leo puts 12 pencils equally into 4 boxes. How many pencils go in each box?

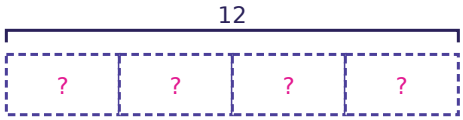

Task card 8 Tape Diagrams: Multiplication & Di...

Ava puts 6 pencils equally into 3 boxes. How many pencils go in each box?

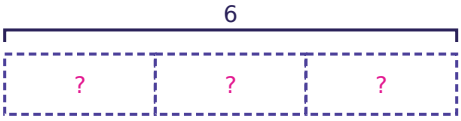

Task card 9 Tape Diagrams: Multiplication & Di...

Eli has 4 boxes with 5 pencils in each box. How many pencils are there in all?

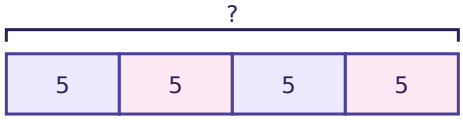

Task card 10 Tape Diagrams: Multiplication & Di...

Nora puts 9 cookies equally into 3 plates. How many cookies go in each plate?



Task card 11 Tape Diagrams: Multiplication & Di...

Ben has 2 plates with 5 cookies in each plate. How many cookies are there in all?

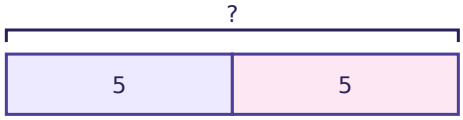

Task card 12 Tape Diagrams: Multiplication & Di...

Zoe has 4 bags with 2 apples in each bag. How many apples are there in all?

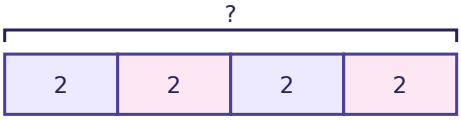

Task card 13 Tape Diagrams: Multiplication & Di...

Mia has 2 plates with 3 cookies in each plate. How many cookies are there in all?

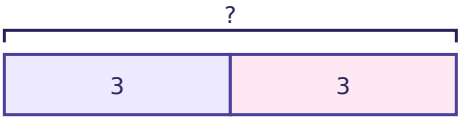

Task card 14 Tape Diagrams: Multiplication & Di...

Nora has 3 vases with 5 flowers in each vase. How many flowers are there in all?

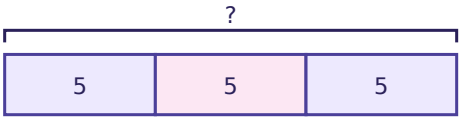

Task card 15 Tape Diagrams: Multiplication & Di...

Zoe has 3 cartons with 2 eggs in each carton. How many eggs are there in all?

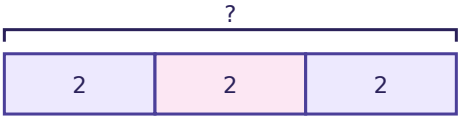

Task card 16 Tape Diagrams: Multiplication & Di...

Eli puts 20 cookies equally into 5 plates. How many cookies go in each plate?

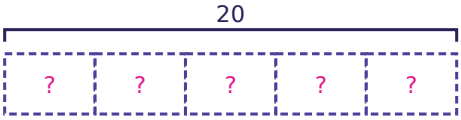

Task card 17 Tape Diagrams: Multiplication & Di...

Nora has 5 vases with 2 flowers in each vase. How many flowers are there in all?

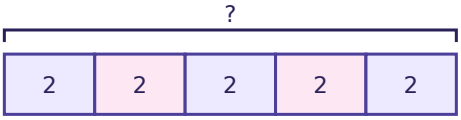

Task card 18 Tape Diagrams: Multiplication & Di...

Ben has 2 bags with 7 apples in each bag. How many apples are there in all?

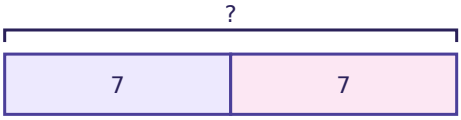

Task card 19 Tape Diagrams: Multiplication & Di...

Nora puts 16 stickers equally into 8 pages. How many stickers go in each page?

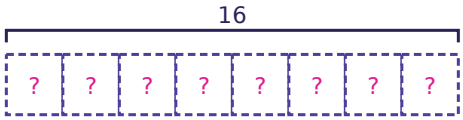

Task card 20 Tape Diagrams: Multiplication & Di...

Leo has 36 cookies and puts 6 in each plate. How many plates does Leo fill?

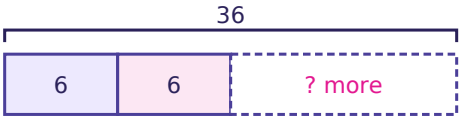

Task card 21 Tape Diagrams: Multiplication & Di...

Zoe has 3 plates with 7 cookies in each plate. How many cookies are there in all?

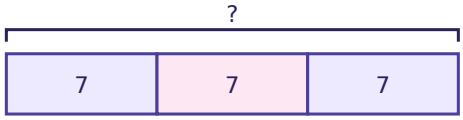

Task card 22 Tape Diagrams: Multiplication & Di...

Sam has 35 cookies and puts 7 in each plate. How many plates does Sam fill?

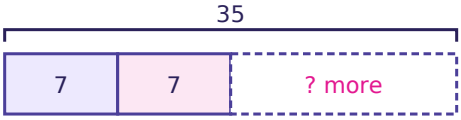

Task card 23 Tape Diagrams: Multiplication & Di...

Eli puts 24 eggs equally into 3 cartons. How many eggs go in each carton?



Task card 24 Tape Diagrams: Multiplication & Di...

Nora puts 36 stickers equally into 6 pages. How many stickers go in each page?

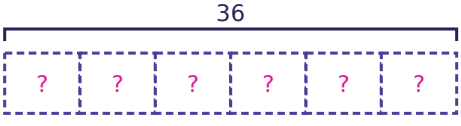

Tape Diagrams: Multiplication & Division Task Cards

Recording sheet · Grade 3 · Read the story and use the tape diagram of equal parts. Find the missing number.

Scan to check your answers

Name: _____ Date: _____

1	2	3	4
5	6	7	8
9	10	11	12
13	14	15	16
17	18	19	20
21	22	23	24

Tape Diagrams: Multiplication & Division Task Cards: Answer Key

Grade 3 · Easy

The answers online

1. 6	**2.** 20	**3.** 9
4. 4	**5.** 8	**6.** 8
7. 3	**8.** 2	**9.** 20
10. 3	**11.** 10	**12.** 8
13. 6	**14.** 15	**15.** 6
16. 4	**17.** 10	**18.** 14
19. 2	**20.** 6	**21.** 21
22. 5	**23.** 8	**24.** 6