Tape Diagrams: Multiplication & Division · 1

Mia puts 24 pencils equally into 4 boxes. How many pencils go in each box?

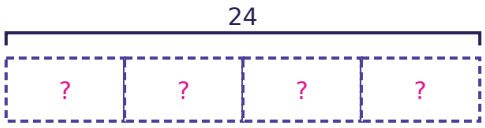

Tape Diagrams: Multiplication & Division · 2

Ben has 42 pencils and puts 7 in each box. How many boxes does Ben fill?

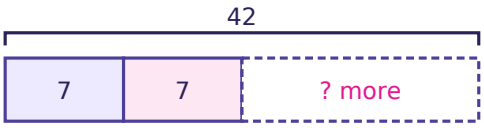

Tape Diagrams: Multiplication & Division · 3

Max has 6 stickers and puts 2 in each page. How many pages does Max fill?

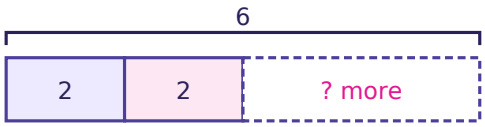

Tape Diagrams: Multiplication & Division · 4

Zoe puts 4 apples equally into 2 bags. How many apples go in each bag?

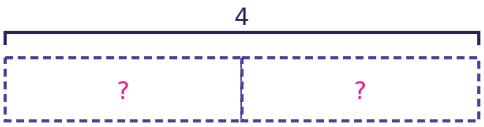

Tape Diagrams: Multiplication & Division · 5

Sam has 8 cartons with 7 eggs in each carton. How many eggs are there in all?

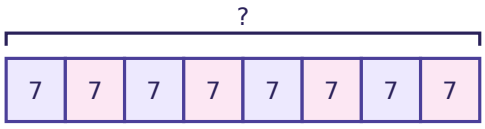

Tape Diagrams: Multiplication & Division · 6

Eli has 48 stickers and puts 6 in each page. How many pages does Eli fill?

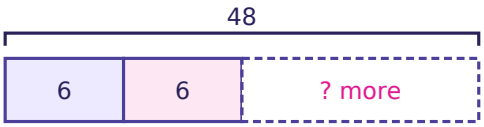

Tape Diagrams: Multiplication & Division · 7

Zoe puts 15 stickers equally into 3 pages. How many stickers go in each page?



Tape Diagrams: Multiplication & Division · 8

Eli puts 9 eggs equally into 3 cartons. How many eggs go in each carton?

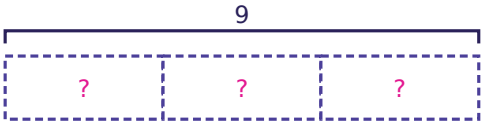

Tape Diagrams: Multiplication & Division · 2

ANSWER

6

Tape Diagrams: Multiplication & Division · 1

ANSWER

6

Tape Diagrams: Multiplication & Division · 4

ANSWER

2

Tape Diagrams: Multiplication & Division · 3

ANSWER

3

Tape Diagrams: Multiplication & Division · 6

ANSWER

8

Tape Diagrams: Multiplication & Division · 5

ANSWER

56

Tape Diagrams: Multiplication & Division · 8

ANSWER

3

Tape Diagrams: Multiplication & Division · 7

ANSWER

5

Mia has 20 pencils and puts 4 in each box.

How many boxes does Mia fill?

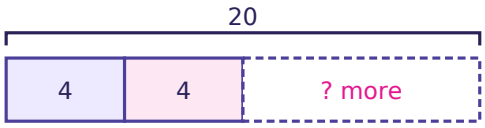

Eli has 30 cookies and puts 6 in each plate.

How many plates does Eli fill?

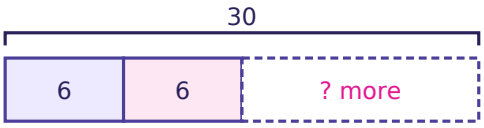

Zoe puts 6 cookies equally into 2 plates.

How many cookies go in each plate?

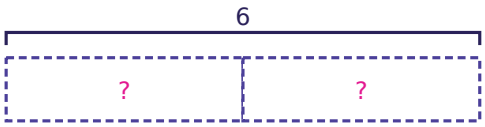

Nora puts 16 cookies equally into 2 plates.

How many cookies go in each plate?

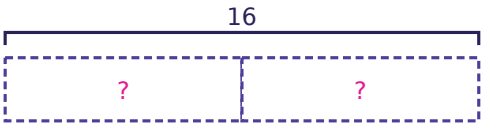

Ben puts 56 cookies equally into 8 plates.

How many cookies go in each plate?

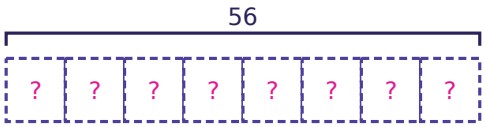

Max puts 21 pencils equally into 3 boxes.

How many pencils go in each box?

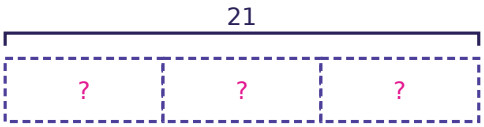

Nora puts 12 apples equally into 3 bags.

How many apples go in each bag?

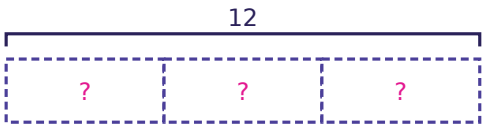

Zoe has 24 cookies and puts 6 in each plate. How many plates does Zoe fill?

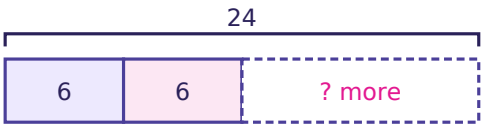

Tape Diagrams: Multiplication & Division · 10

ANSWER

5

Tape Diagrams: Multiplication & Division · 9

ANSWER

5

Tape Diagrams: Multiplication & Division · 12

ANSWER

8

Tape Diagrams: Multiplication & Division · 11

ANSWER

3

Tape Diagrams: Multiplication & Division · 14

ANSWER

7

Tape Diagrams: Multiplication & Division · 13

ANSWER

7

Tape Diagrams: Multiplication & Division · 16

ANSWER

4

Tape Diagrams: Multiplication & Division · 15

ANSWER

4

Mia has 3 bags with 6 apples in each bag. How many apples are there in all?

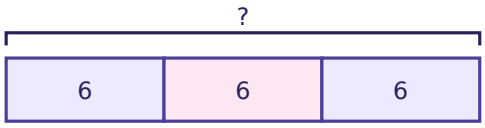

Leo has 18 pencils and puts 6 in each box. How many boxes does Leo fill?

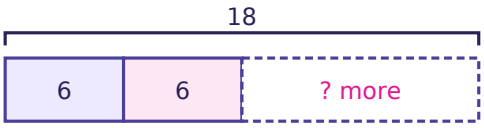

Lily puts 9 apples equally into 3 bags. How many apples go in each bag?

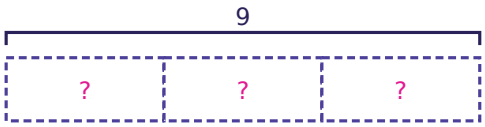

Leo has 56 apples and puts 7 in each bag. How many bags does Leo fill?

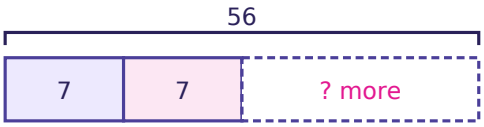

Lily has 18 stickers and puts 3 in each page. How many pages does Lily fill?

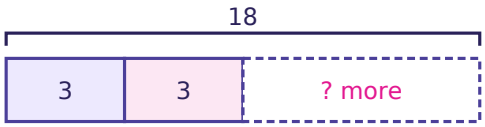

Mia has 2 plates with 10 cookies in each plate. How many cookies are there in all?

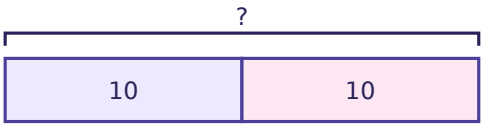

Ava has 49 pencils and puts 7 in each box. How many boxes does Ava fill?

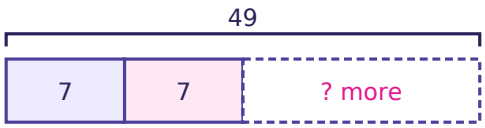

Zoe has 15 cookies and puts 3 in each plate. How many plates does Zoe fill?

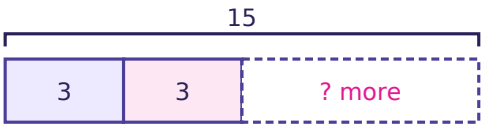

Tape Diagrams: Multiplication & Division · 18

ANSWER

3

Tape Diagrams: Multiplication & Division · 17

ANSWER

18

Tape Diagrams: Multiplication & Division · 20

ANSWER

8

Tape Diagrams: Multiplication & Division · 19

ANSWER

3

Tape Diagrams: Multiplication & Division · 22

ANSWER

20

Tape Diagrams: Multiplication & Division · 21

ANSWER

6

Tape Diagrams: Multiplication & Division · 24

ANSWER

5

Tape Diagrams: Multiplication & Division · 23

ANSWER

7