Tape Diagrams: Multiplication & Division · 1

Nora has 2 plates with 3 cookies in each plate. How many cookies are there in all?

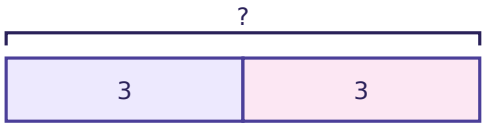

Tape Diagrams: Multiplication & Division · 2

Eli has 4 bags with 5 apples in each bag. How many apples are there in all?

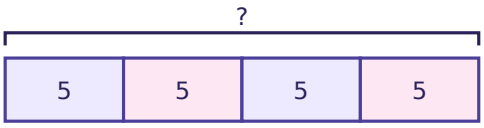

Tape Diagrams: Multiplication & Division · 3

Mia has 3 vases with 3 flowers in each vase. How many flowers are there in all?

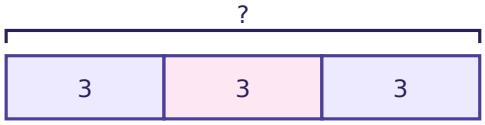

Tape Diagrams: Multiplication & Division · 4

Ben puts 20 flowers equally into 5 vases. How many flowers go in each vase?

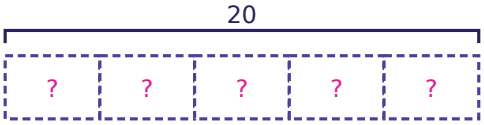

Tape Diagrams: Multiplication & Division · 5

Ava has 2 cartons with 4 eggs in each carton. How many eggs are there in all?

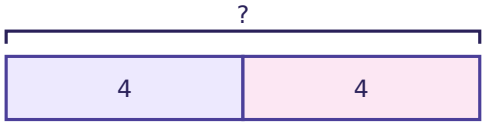

Tape Diagrams: Multiplication & Division · 6

Zoe has 4 vases with 2 flowers in each vase. How many flowers are there in all?

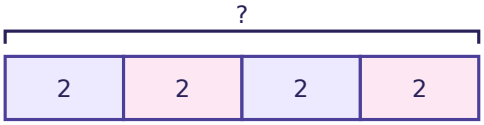

Tape Diagrams: Multiplication & Division · 7

Leo puts 12 pencils equally into 4 boxes. How many pencils go in each box?

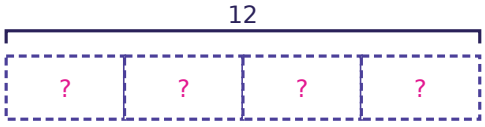

Tape Diagrams: Multiplication & Division · 8

Ava puts 6 pencils equally into 3 boxes. How many pencils go in each box?

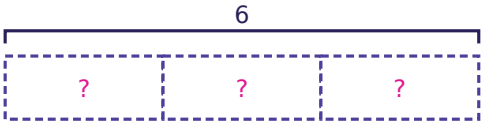

Tape Diagrams: Multiplication & Division · 2

ANSWER

20

Tape Diagrams: Multiplication & Division · 1

ANSWER

6

Tape Diagrams: Multiplication & Division · 4

ANSWER

4

Tape Diagrams: Multiplication & Division · 3

ANSWER

9

Tape Diagrams: Multiplication & Division · 6

ANSWER

8

Tape Diagrams: Multiplication & Division · 5

ANSWER

8

Tape Diagrams: Multiplication & Division · 8

ANSWER

2

Tape Diagrams: Multiplication & Division · 7

ANSWER

3

Tape Diagrams: Multiplication & Division · 9

Eli has 4 boxes with 5 pencils in each box. How many pencils are there in all?

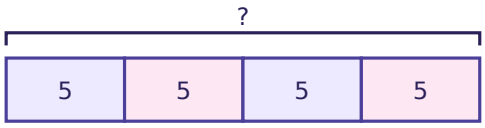

Tape Diagrams: Multiplication & Division · 10

Nora puts 9 cookies equally into 3 plates. How many cookies go in each plate?

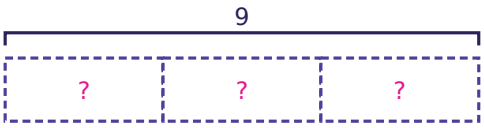

Tape Diagrams: Multiplication & Division · 11

Ben has 2 plates with 5 cookies in each plate. How many cookies are there in all?

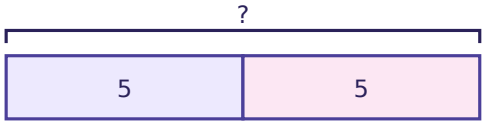

Tape Diagrams: Multiplication & Division · 12

Zoe has 4 bags with 2 apples in each bag. How many apples are there in all?

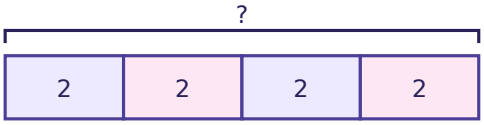

Tape Diagrams: Multiplication & Division · 13

Mia has 2 plates with 3 cookies in each plate. How many cookies are there in all?

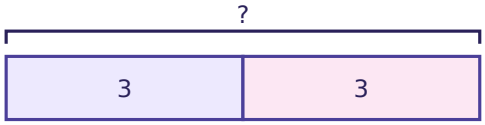

Tape Diagrams: Multiplication & Division · 14

Nora has 3 vases with 5 flowers in each vase. How many flowers are there in all?

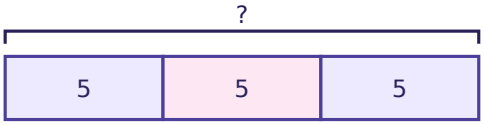

Tape Diagrams: Multiplication & Division · 15

Zoe has 3 cartons with 2 eggs in each carton. How many eggs are there in all?

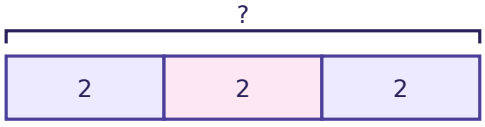

Tape Diagrams: Multiplication & Division · 16

Eli puts 20 cookies equally into 5 plates. How many cookies go in each plate?

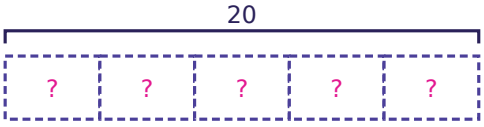

Tape Diagrams: Multiplication & Division · 10

ANSWER

3

Tape Diagrams: Multiplication & Division · 9

ANSWER

20

Tape Diagrams: Multiplication & Division · 12

ANSWER

8

Tape Diagrams: Multiplication & Division · 11

ANSWER

10

Tape Diagrams: Multiplication & Division · 14

ANSWER

15

Tape Diagrams: Multiplication & Division · 13

ANSWER

6

Tape Diagrams: Multiplication & Division · 16

ANSWER

4

Tape Diagrams: Multiplication & Division · 15

ANSWER

6

Tape Diagrams: Multiplication & Division · 17

Nora has 5 vases with 2 flowers in each vase. How many flowers are there in all?

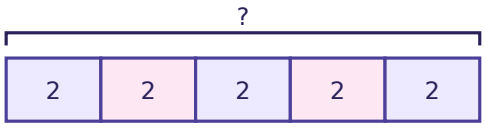

Tape Diagrams: Multiplication & Division · 18

Ben has 2 bags with 7 apples in each bag. How many apples are there in all?

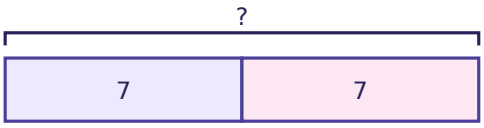

Tape Diagrams: Multiplication & Division · 19

Nora puts 16 stickers equally into 8 pages. How many stickers go in each page?

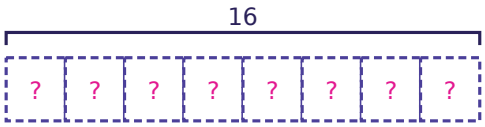

Tape Diagrams: Multiplication & Division · 20

Leo has 36 cookies and puts 6 in each plate. How many plates does Leo fill?

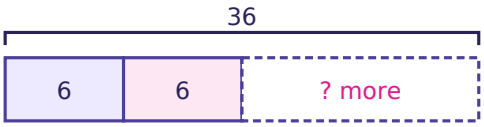

Tape Diagrams: Multiplication & Division · 21

Zoe has 3 plates with 7 cookies in each plate. How many cookies are there in all?

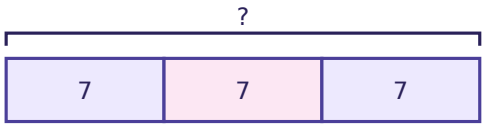

Tape Diagrams: Multiplication & Division · 22

Sam has 35 cookies and puts 7 in each plate. How many plates does Sam fill?

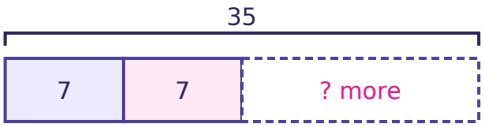

Tape Diagrams: Multiplication & Division · 23

Eli puts 24 eggs equally into 3 cartons. How many eggs go in each carton?



Tape Diagrams: Multiplication & Division · 24

Nora puts 36 stickers equally into 6 pages. How many stickers go in each page?

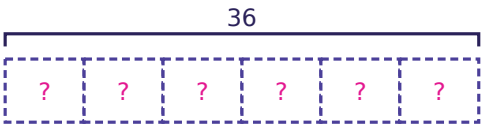

Tape Diagrams: Multiplication & Division · 18

ANSWER

14

Tape Diagrams: Multiplication & Division · 17

ANSWER

10

Tape Diagrams: Multiplication & Division · 20

ANSWER

6

Tape Diagrams: Multiplication & Division · 19

ANSWER

2

Tape Diagrams: Multiplication & Division · 22

ANSWER

5

Tape Diagrams: Multiplication & Division · 21

ANSWER

21

Tape Diagrams: Multiplication & Division · 24

ANSWER

6

Tape Diagrams: Multiplication & Division · 23

ANSWER

8