Task card 1 Summer Math

A watermelon is cut into 10 equal slices. The family eats 1 slice. What fraction of the watermelon did they eat?

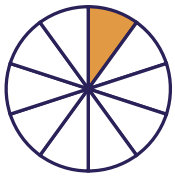

Task card 2 Summer Math

At the summer barbecue there are 2 tables. 3 people sit at each table. How many people are there?

Task card 3 Summer Math

At the summer barbecue there are 7 tables. 5 people sit at each table. How many people are there?

Task card 4 Summer Math

The family gets to the beach at 10:00. They stay for 5 hours. What time do they leave?



Task card 5 Summer Math

Omar shares 30 lemon bars equally among 3 friends. How many lemon bars does each friend get?

Task card 6 Summer Math

Leo shares 15 lemon bars equally among 3 friends. How many lemon bars does each friend get?

Task card 7 Summer Math

A watermelon is cut into 6 equal slices. The family eats 1 slice. What fraction of the watermelon did they eat?

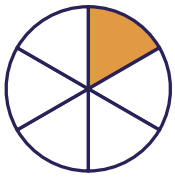

Task card 8 Summer Math

The family gets to the beach at 10:30. They stay for 4 hours. What time do they leave?



Task card 9 Summer Math

Ben shares 48 blueberry muffins equally among 6 friends. How many blueberry muffins does each friend get?

Task card 10 Summer Math

A watermelon is cut into 10 equal slices. The family eats 3 slices. What fraction of the watermelon did they eat?

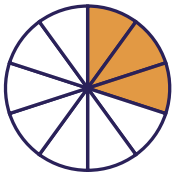

Task card 11 Summer Math

The family gets to the beach at 11:30. They stay for 2 hours. What time do they leave?



Task card 12 Summer Math

At the summer barbecue there are 8 tables. 2 people sit at each table. How many people are there?

Task card 13 Summer Math

Ava shares 72 cupcakes equally among 9 friends. How many cupcakes does each friend get?

Task card 14 Summer Math

At the summer barbecue there are 5 tables. 3 people sit at each table. How many people are there?

Task card 15 Summer Math

At the summer barbecue there are 5 tables. 9 people sit at each table. How many people are there?

Task card 16 Summer Math

The family gets to the beach at 12:00. They stay for 5 hours. What time do they leave?



Task card 17 Summer Math

At the summer barbecue there are 8 tables. 7 people sit at each table. How many people are there?

Task card 18 Summer Math

Noah shares 12 lemon bars equally among 4 friends. How many lemon bars does each friend get?

Task card 19 Summer Math

A watermelon is cut into 8 equal slices. The family eats 5 slices. What fraction of the watermelon did they eat?

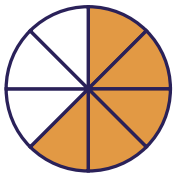

Task card 20 Summer Math

Noah shares 6 blueberry muffins equally among 2 friends. How many blueberry muffins does each friend get?

Task card 21 Summer Math

A watermelon is cut into 8 equal slices. The family eats 7 slices. What fraction of the watermelon did they eat?

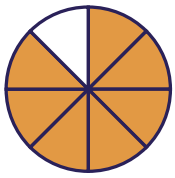

Task card 22 Summer Math

At the summer barbecue there are 6 tables. 6 people sit at each table. How many people are there?

Task card 23 Summer Math

A watermelon is cut into 6 equal slices. The family eats 5 slices. What fraction of the watermelon did they eat?

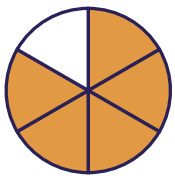

Task card 24 Summer Math

A watermelon is cut into 10 equal slices. The family eats 9 slices. What fraction of the watermelon did they eat?

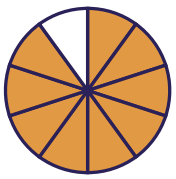

Summer Math Task Cards

Recording sheet · Grade 3 · Read each story and solve. Write times like 3:00 and fractions like 3/8.

Name: _____ Date: _____

Scan to check your answers

1	2	3	4
5	6	7	8
9	10	11	12
13	14	15	16
17	18	19	20
21	22	23	24

Summer Math Task Cards: Answer Key

Grade 3 · Hard

The answers online

1. $\frac{1}{10}$	**2.** 6	**3.** 35
4. 3:00	**5.** 10	**6.** 5
7. $\frac{1}{6}$	**8.** 2:30	**9.** 8
10. $\frac{3}{10}$	**11.** 1:30	**12.** 16
13. 8	**14.** 15	**15.** 45
16. 5:00	**17.** 56	**18.** 3
19. $\frac{5}{8}$	**20.** 3	**21.** $\frac{7}{8}$
22. 36	**23.** $\frac{5}{6}$	**24.** $\frac{9}{10}$