Task card 1 Summer Math

At the summer barbecue there are 2 tables. 4 people sit at each table. How many people are there?

Task card 2 Summer Math

Ben shares 32 cupcakes equally among 8 friends. How many cupcakes does each friend get?

Task card 3 Summer Math

The family gets to the beach at 9:00. They stay for 2 hours. What time do they leave?



Task card 4 Summer Math

The family gets to the beach at 9:00. They stay for 4 hours. What time do they leave?



Task card 5 Summer Math

A watermelon is cut into 8 equal slices. The family eats 3 slices. What fraction of the watermelon did they eat?

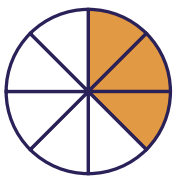

Task card 6 Summer Math

At the summer barbecue there are 9 tables. 6 people sit at each table. How many people are there?

Task card 7 Summer Math

A watermelon is cut into 10 equal slices. The family eats 1 slice. What fraction of the watermelon did they eat?

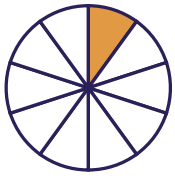

Task card 8 Summer Math

Sam shares 48 cupcakes equally among 6 friends. How many cupcakes does each friend get?

Task card 9 Summer Math

Leo shares 45 cupcakes equally among 9 friends. How many cupcakes does each friend get?

Task card 10 Summer Math

At the summer barbecue there are 6 tables. 9 people sit at each table. How many people are there?

Task card 11 Summer Math

At the summer barbecue there are 3 tables. 9 people sit at each table. How many people are there?

Task card 12 Summer Math

A watermelon is cut into 8 equal slices. The family eats 1 slice. What fraction of the watermelon did they eat?



Task card 13 Summer Math

Omar shares 30 blueberry muffins equally among 6 friends. How many blueberry muffins does each friend get?

Task card 14 Summer Math

The family gets to the beach at 9:30. They stay for 5 hours. What time do they leave?



Task card 15 Summer Math

The family gets to the beach at 10:00. They stay for 5 hours. What time do they leave?



Task card 16 Summer Math

The family gets to the beach at 9:30. They stay for 2 hours. What time do they leave?



Task card 17 Summer Math

Ella shares 18 cupcakes equally among 3 friends. How many cupcakes does each friend get?

Task card 18 Summer Math

A watermelon is cut into 12 equal slices. The family eats 5 slices. What fraction of the watermelon did they eat?



Task card 19 Summer Math

At the summer barbecue there are 2 tables. 2 people sit at each table. How many people are there?

Task card 20 Summer Math

Ben shares 20 blueberry muffins equally among 2 friends. How many blueberry muffins does each friend get?

Task card 21 Summer Math

The family gets to the beach at 11:00. They stay for 3 hours. What time do they leave?



Task card 22 Summer Math

At the summer barbecue there are 3 tables. 3 people sit at each table. How many people are there?

Task card 23 Summer Math

The family gets to the beach at 9:00. They stay for 5 hours. What time do they leave?



Task card 24 Summer Math

A watermelon is cut into 8 equal slices. The family eats 5 slices. What fraction of the watermelon did they eat?

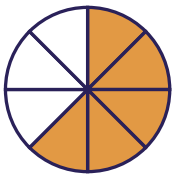

Summer Math Task Cards

Recording sheet · Grade 3 · Read each story and solve. Write times like 3:00 and fractions like 3/8.

Name: _____ Date: _____

Scan to check your answers

1	2	3	4
5	6	7	8
9	10	11	12
13	14	15	16
17	18	19	20
21	22	23	24

Summer Math Task Cards: Answer Key

Grade 3 · Medium

The answers online

1. 8	**2.** 4	**3.** 11:00
4. 1:00	**5.** $\frac{3}{8}$	**6.** 54
7. $\frac{1}{10}$	**8.** 8	**9.** 5
10. 54	**11.** 27	**12.** $\frac{1}{8}$
13. 5	**14.** 2:30	**15.** 3:00
16. 11:30	**17.** 6	**18.** $\frac{5}{12}$
19. 4	**20.** 10	**21.** 2:00
22. 9	**23.** 2:00	**24.** $\frac{5}{8}$