**Task card 1** Summer Math

At the summer barbecue there are 2 tables. 3 people sit at each table. How many people are there?

**Task card 2** Summer Math

Lily shares 35 blueberry muffins equally among 7 friends. How many blueberry muffins does each friend get?

**Task card 3** Summer Math

A watermelon is cut into 6 equal slices. The family eats 1 slice. What fraction of the watermelon did they eat?

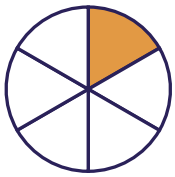

**Task card 4** Summer Math

The family gets to the beach at 12:00. They stay for 5 hours. What time do they leave?



**Task card 5** Summer Math

A watermelon is cut into 8 equal slices. The family eats 1 slice. What fraction of the watermelon did they eat?

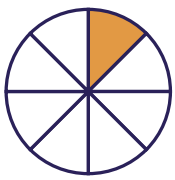

**Task card 6** Summer Math

Ava shares 24 cupcakes equally among 6 friends. How many cupcakes does each friend get?

**Task card 7** Summer Math

At the summer barbecue there are 6 tables. 3 people sit at each table. How many people are there?

**Task card 8** Summer Math

The family gets to the beach at 9:00. They stay for 4 hours. What time do they leave?



**Task card 9** Summer Math

The family gets to the beach at 11:00. They stay for 2 hours. What time do they leave?



**Task card 10** Summer Math

At the summer barbecue there are 7 tables. 6 people sit at each table. How many people are there?

**Task card 11** Summer Math

Omar shares 20 cupcakes equally among 4 friends. How many cupcakes does each friend get?

**Task card 12** Summer Math

Lily shares 10 cupcakes equally among 5 friends. How many cupcakes does each friend get?

**Task card 13** Summer Math

A watermelon is cut into 8 equal slices. The family eats 3 slices. What fraction of the watermelon did they eat?

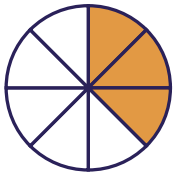

**Task card 14** Summer Math

At the summer barbecue there are 6 tables. 6 people sit at each table. How many people are there?

**Task card 15** Summer Math

Zoe shares 12 blueberry muffins equally among 4 friends. How many blueberry muffins does each friend get?

**Task card 16** Summer Math

The family gets to the beach at 12:00. They stay for 4 hours. What time do they leave?



**Task card 17** Summer Math

Ava shares 27 lemon bars equally among 9 friends. How many lemon bars does each friend get?

**Task card 18** Summer Math

Ava shares 56 lemon bars equally among 8 friends. How many lemon bars does each friend get?

**Task card 19** Summer Math

At the summer barbecue there are 8 tables. 6 people sit at each table. How many people are there?

**Task card 20** Summer Math

The family gets to the beach at 10:00. They stay for 5 hours. What time do they leave?



**Task card 21** Summer Math

At the summer barbecue there are 7 tables. 2 people sit at each table. How many people are there?

**Task card 22** Summer Math

At the summer barbecue there are 9 tables. 3 people sit at each table. How many people are there?

**Task card 23** Summer Math

A watermelon is cut into 4 equal slices. The family eats 3 slices. What fraction of the watermelon did they eat?



**Task card 24** Summer Math

Zoe shares 28 cupcakes equally among 7 friends. How many cupcakes does each friend get?

# Summer Math Task Cards

Recording sheet · Grade 3 · Read each story and solve. Write times like 3:00 and fractions like 3/8.

Name: _____ Date: _____

Scan to check your answers

| | | | |
|---|---|---|---|
| 1 | 2 | 3 | 4 |
| 5 | 6 | 7 | 8 |
| 9 | 10 | 11 | 12 |
| 13 | 14 | 15 | 16 |
| 17 | 18 | 19 | 20 |
| 21 | 22 | 23 | 24 |

# Summer Math Task Cards: Answer Key

Grade 3 · Easy

The answers online

| | | |
|---|---|---|
| **1.** 6 | **2.** 5 | **3.** $\frac{1}{6}$ |
| **4.** 5:00 | **5.** $\frac{1}{8}$ | **6.** 4 |
| **7.** 18 | **8.** 1:00 | **9.** 1:00 |
| **10.** 42 | **11.** 5 | **12.** 2 |
| **13.** $\frac{3}{8}$ | **14.** 36 | **15.** 3 |
| **16.** 4:00 | **17.** 3 | **18.** 7 |
| **19.** 48 | **20.** 3:00 | **21.** 14 |
| **22.** 27 | **23.** $\frac{3}{4}$ | **24.** 4 |