Task card 1 Summer Math

At the summer barbecue there are 2 tables. 3 people sit at each table. How many people are there?

Task card 2 Summer Math

Lily shares 35 blueberry muffins equally among 7 friends. How many blueberry muffins does each friend get?

Task card 3 Summer Math

A watermelon is cut into 6 equal slices. The family eats 1 slice. What fraction of the watermelon did they eat?

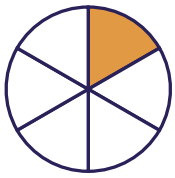

Task card 4 Summer Math

The family gets to the beach at 12:00. They stay for 5 hours. What time do they leave?



Task card 5 Summer Math

A watermelon is cut into 8 equal slices. The family eats 1 slice. What fraction of the watermelon did they eat?

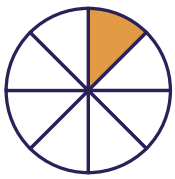

Task card 6 Summer Math

Ava shares 24 cupcakes equally among 6 friends. How many cupcakes does each friend get?

Task card 7 Summer Math

At the summer barbecue there are 6 tables. 3 people sit at each table. How many people are there?

Task card 8 Summer Math

The family gets to the beach at 9:00. They stay for 4 hours. What time do they leave?



Task card 9 Summer Math

The family gets to the beach at 11:00. They stay for 2 hours. What time do they leave?



Task card 10 Summer Math

At the summer barbecue there are 7 tables. 6 people sit at each table. How many people are there?

Task card 11 Summer Math

Omar shares 20 cupcakes equally among 4 friends. How many cupcakes does each friend get?

Task card 12 Summer Math

Lily shares 10 cupcakes equally among 5 friends. How many cupcakes does each friend get?

Task card 13 Summer Math

A watermelon is cut into 8 equal slices. The family eats 3 slices. What fraction of the watermelon did they eat?

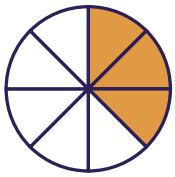

Task card 14 Summer Math

At the summer barbecue there are 6 tables. 6 people sit at each table. How many people are there?

Task card 15 Summer Math

Zoe shares 12 blueberry muffins equally among 4 friends. How many blueberry muffins does each friend get?

Task card 16 Summer Math

The family gets to the beach at 12:00. They stay for 4 hours. What time do they leave?



Task card 17 Summer Math

Ava shares 27 lemon bars equally among 9 friends. How many lemon bars does each friend get?

Task card 18 Summer Math

Ava shares 56 lemon bars equally among 8 friends. How many lemon bars does each friend get?

Task card 19 Summer Math

At the summer barbecue there are 8 tables. 6 people sit at each table. How many people are there?

Task card 20 Summer Math

The family gets to the beach at 10:00. They stay for 5 hours. What time do they leave?



Task card 21 Summer Math

At the summer barbecue there are 7 tables. 2 people sit at each table. How many people are there?

Task card 22 Summer Math

At the summer barbecue there are 9 tables. 3 people sit at each table. How many people are there?

Task card 23 Summer Math

A watermelon is cut into 4 equal slices. The family eats 3 slices. What fraction of the watermelon did they eat?



Task card 24 Summer Math

Zoe shares 28 cupcakes equally among 7 friends. How many cupcakes does each friend get?

Summer Math Task Cards

Recording sheet · Grade 3 · Read each story and solve. Write times like 3:00 and fractions like 3/8.

Name: _____ Date: _____

Scan to check your answers

1	2	3	4
5	6	7	8
9	10	11	12
13	14	15	16
17	18	19	20
21	22	23	24

Summer Math Task Cards: Answer Key

Grade 3 · Easy

The answers online

1. 6	**2.** 5	**3.** $\frac{1}{6}$
4. 5:00	**5.** $\frac{1}{8}$	**6.** 4
7. 18	**8.** 1:00	**9.** 1:00
10. 42	**11.** 5	**12.** 2
13. $\frac{3}{8}$	**14.** 36	**15.** 3
16. 4:00	**17.** 3	**18.** 7
19. 48	**20.** 3:00	**21.** 14
22. 27	**23.** $\frac{3}{4}$	**24.** 4